Winter Math · 1

The bakery makes 336 cocoa muffins. It sells 68 of them. How many cocoa muffins are left?

Winter Math · 2

Zoe buys a snowman sticker for 20¢ and a blue streamer for 55¢. How many cents does Zoe spend?

Winter Math · 3

Ava buys a paper snowflake for 10¢ and a blue streamer for 25¢. How many cents does Ava spend?

Winter Math · 4

The school bakes 222 snowball cookies and 254 cinnamon rolls for the bake sale. How many treats is that in all?

Winter Math · 5

Sam puts 2 cocoa muffins on each of 3 plates. How many cocoa muffins is that in all?



Winter Math · 6

The bakery makes 404 cocoa muffins. It sells 240 of them. How many cocoa muffins are left?

Winter Math · 7

The school bakes 126 snowball cookies and 129 cinnamon rolls for the bake sale. How many treats is that in all?

Winter Math · 8

Mia puts 2 snowball cookies on each of 4 plates. How many snowball cookies is that in all?



Winter Math · 2

ANSWER

75

Winter Math · 1

ANSWER

268

Winter Math · 4

ANSWER

476

Winter Math · 3

ANSWER

35

Winter Math · 6

ANSWER

164

Winter Math · 5

ANSWER

6

Winter Math · 8

ANSWER

8

Winter Math · 7

ANSWER

255

Winter Math · 9

The bakery makes 346 cocoa muffins. It sells 341 of them. How many cocoa muffins are left?

Winter Math · 10

Lily buys a paper snowflake for 40¢ and a snowman sticker for 10¢. How many cents does Lily spend?

Winter Math · 11

Omar puts 5 cocoa muffins on each of 2 plates. How many cocoa muffins is that in all?



Winter Math · 12

Leo buys a blue streamer for 10¢ and a snowman sticker for 60¢. How many cents does Leo spend?

Winter Math · 13

The bakery makes 426 cocoa muffins. It sells 63 of them. How many cocoa muffins are left?

Winter Math · 14

The school bakes 103 snowball cookies and 146 cocoa muffins for the bake sale. How many treats is that in all?

Winter Math · 15

The school bakes 193 snowball cookies and 67 cocoa muffins for the bake sale. How many treats is that in all?

Winter Math · 16

Zoe puts 3 cinnamon rolls on each of 3 plates. How many cinnamon rolls is that in all?



Winter Math · 10

ANSWER

50

Winter Math · 9

ANSWER

5

Winter Math · 12

ANSWER

70

Winter Math · 11

ANSWER

10

Winter Math · 14

ANSWER

249

Winter Math · 13

ANSWER

363

Winter Math · 16

ANSWER

9

Winter Math · 15

ANSWER

260

Winter Math · 17

Sam puts 4 snowball cookies on each of 5 plates. How many snowball cookies is that in all?



Winter Math · 18

Ava buys a paper snowflake for 35¢ and a snowman sticker for 40¢. How many cents does Ava spend?

Winter Math · 19

The school bakes 248 snowball cookies and 70 cocoa muffins for the bake sale. How many treats is that in all?

Winter Math · 20

The bakery makes 315 snowball cookies. It sells 24 of them. How many snowball cookies are left?

Winter Math · 21

Noah puts 2 cinnamon rolls on each of 4 plates. How many cinnamon rolls is that in all?



Winter Math · 22

The bakery makes 161 cinnamon rolls. It sells 131 of them. How many cinnamon rolls are left?

Winter Math · 23

The school bakes 124 snowball cookies and 198 cocoa muffins for the bake sale. How many treats is that in all?

Winter Math · 24

Zoe buys a paper snowflake for 10¢ and a blue streamer for 15¢. How many cents does Zoe spend?

Winter Math · 18

ANSWER

75

Winter Math · 17

ANSWER

20

Winter Math · 20

ANSWER

291

Winter Math · 19

ANSWER

318

Winter Math · 22

ANSWER

30

Winter Math · 21

ANSWER

8

Winter Math · 24

ANSWER

25

Winter Math · 23

ANSWER

322