Winter Math · 1

Ben buys a blue streamer for 40¢ and a snowman sticker for 20¢. How many cents does Ben spend?

Winter Math · 2

Zoe puts 4 cinnamon rolls on each of 2 plates. How many cinnamon rolls is that in all?



Winter Math · 3

The school bakes 18 snowball cookies and 36 cinnamon rolls for the bake sale. How many treats is that in all?

Winter Math · 4

The bakery makes 96 cinnamon rolls. It sells 42 of them. How many cinnamon rolls are left?

Winter Math · 5

The school bakes 41 cocoa muffins and 21 cinnamon rolls for the bake sale. How many treats is that in all?

Winter Math · 6

Sam buys a paper snowflake for 25¢ and a snowman sticker for 10¢. How many cents does Sam spend?

Winter Math · 7

Zoe puts 4 cocoa muffins on each of 2 plates. How many cocoa muffins is that in all?



Winter Math · 8

The bakery makes 52 snowball cookies. It sells 34 of them. How many snowball cookies are left?

Winter Math · 2

ANSWER

8

Winter Math · 1

ANSWER

60

Winter Math · 4

ANSWER

54

Winter Math · 3

ANSWER

54

Winter Math · 6

ANSWER

35

Winter Math · 5

ANSWER

62

Winter Math · 8

ANSWER

18

Winter Math · 7

ANSWER

8

Winter Math · 9

The bakery makes 94 snowball cookies. It sells 73 of them. How many snowball cookies are left?

Winter Math · 10

The school bakes 19 cocoa muffins and 34 snowball cookies for the bake sale. How many treats is that in all?

Winter Math · 11

Ella buys a paper snowflake for 10¢ and a blue streamer for 25¢. How many cents does Ella spend?

Winter Math · 12

Ben puts 4 snowball cookies on each of 2 plates. How many snowball cookies is that in all?



Winter Math · 13

Lily buys a blue streamer for 20¢ and a snowman sticker for 15¢. How many cents does Lily spend?

Winter Math · 14

The school bakes 21 cinnamon rolls and 14 snowball cookies for the bake sale. How many treats is that in all?

Winter Math · 15

Leo puts 5 cinnamon rolls on each of 2 plates. How many cinnamon rolls is that in all?



Winter Math · 16

The bakery makes 90 cocoa muffins. It sells 62 of them. How many cocoa muffins are left?

Winter Math · 10

ANSWER

53

Winter Math · 9

ANSWER

21

Winter Math · 12

ANSWER

8

Winter Math · 11

ANSWER

35

Winter Math · 14

ANSWER

35

Winter Math · 13

ANSWER

35

Winter Math · 16

ANSWER

28

Winter Math · 15

ANSWER

10

Winter Math · 17

Ava buys a paper snowflake for 35¢ and a snowman sticker for 25¢. How many cents does Ava spend?

Winter Math · 18

The school bakes 35 cinnamon rolls and 53 cocoa muffins for the bake sale. How many treats is that in all?

Winter Math · 19

The bakery makes 49 cocoa muffins. It sells 24 of them. How many cocoa muffins are left?

Winter Math · 20

Sam buys a snowman sticker for 35¢ and a paper snowflake for 20¢. How many cents does Sam spend?

Winter Math · 21

Sam puts 5 snowball cookies on each of 2 plates. How many snowball cookies is that in all?



Winter Math · 22

The school bakes 32 snowball cookies and 39 cocoa muffins for the bake sale. How many treats is that in all?

Winter Math · 23

The bakery makes 50 cocoa muffins. It sells 26 of them. How many cocoa muffins are left?

Winter Math · 24

Zoe puts 4 snowball cookies on each of 3 plates. How many snowball cookies is that in all?



Winter Math · 18

ANSWER

88

Winter Math · 17

ANSWER

60

Winter Math · 20

ANSWER

55

Winter Math · 19

ANSWER

25

Winter Math · 22

ANSWER

71

Winter Math · 21

ANSWER

10

Winter Math · 24

ANSWER

12

Winter Math · 23

ANSWER

24