Task card 1 Valentine's Day Math

The school bakes 129 cupcakes and 326 heart cookies for the bake sale. How many treats is that in all?

Task card 2 Valentine's Day Math

The school bakes 127 cupcakes and 194 brownies for the bake sale. How many treats is that in all?

Task card 3 Valentine's Day Math

The bakery makes 286 cupcakes. It sells 12 of them. How many cupcakes are left?

Task card 4 Valentine's Day Math

Zoe buys a heart sticker for 45¢ and a valentine card for 30¢. How many cents does Zoe spend?

Task card 5 Valentine's Day Math

The bakery makes 258 brownies. It sells 202 of them. How many brownies are left?

Task card 6 Valentine's Day Math

Zoe puts 3 heart cookies on each of 4 plates. How many heart cookies is that in all?



Task card 7 Valentine's Day Math

Noah puts 4 heart cookies on each of 2 plates. How many heart cookies is that in all?



Task card 8 Valentine's Day Math

Ella buys a valentine card for 35¢ and a heart sticker for 55¢. How many cents does Ella spend?

Task card 9 Valentine's Day Math

The school bakes 139 heart cookies and 183 brownies for the bake sale. How many treats is that in all?

Task card 10 Valentine's Day Math

The bakery makes 359 brownies. It sells 235 of them. How many brownies are left?

Task card 11 Valentine's Day Math

Noah puts 2 heart cookies on each of 2 plates. How many heart cookies is that in all?



Task card 12 Valentine's Day Math

The bakery makes 136 heart cookies. It sells 63 of them. How many heart cookies are left?

Task card 13 Valentine's Day Math

Zoe buys a paper heart for 20¢ and a valentine card for 20¢. How many cents does Zoe spend?

Task card 14 Valentine's Day Math

Omar buys a valentine card for 25¢ and a paper heart for 20¢. How many cents does Omar spend?

Task card 15 Valentine's Day Math

Lily puts 5 cupcakes on each of 5 plates. How many cupcakes is that in all?



Task card 16 Valentine's Day Math

The school bakes 57 cupcakes and 52 brownies for the bake sale. How many treats is that in all?

Task card 17 Valentine's Day Math

The school bakes 145 brownies and 300 cupcakes for the bake sale. How many treats is that in all?

Task card 18 Valentine's Day Math

The school bakes 162 heart cookies and 259 brownies for the bake sale. How many treats is that in all?

Task card 19 Valentine's Day Math

Ava buys a heart sticker for 45¢ and a valentine card for 15¢. How many cents does Ava spend?

Task card 20 Valentine's Day Math

The bakery makes 332 cupcakes. It sells 236 of them. How many cupcakes are left?

Task card 21 Valentine's Day Math

The bakery makes 174 heart cookies. It sells 156 of them. How many heart cookies are left?

Task card 22 Valentine's Day Math

Sam puts 2 heart cookies on each of 5 plates. How many heart cookies is that in all?



Task card 23 Valentine's Day Math

Leo buys a valentine card for 15¢ and a paper heart for 20¢. How many cents does Leo spend?

Task card 24 Valentine's Day Math

Zoe puts 3 brownies on each of 2 plates. How many brownies is that in all?



Valentine's Day Math Task Cards

Recording sheet · Grade 2 · Read each story and solve.

Name: _____ Date: _____

Scan to check your answers

1	2	3	4
5	6	7	8
9	10	11	12
13	14	15	16
17	18	19	20
21	22	23	24

Valentine's Day Math Task Cards: Answer Key

Grade 2 · Hard

The answers online

1. 455	**2.** 321	**3.** 274
4. 75	**5.** 56	**6.** 12
7. 8	**8.** 90	**9.** 322
10. 124	**11.** 4	**12.** 73
13. 40	**14.** 45	**15.** 25
16. 109	**17.** 445	**18.** 421
19. 60	**20.** 96	**21.** 18
22. 10	**23.** 35	**24.** 6