Task card 1 Valentine's Day Math

Sam buys a heart sticker for 40¢ and a valentine card for 5¢. How many cents does Sam spend?

Task card 2 Valentine's Day Math

The bakery makes 41 brownies. It sells 23 of them. How many brownies are left?

Task card 3 Valentine's Day Math

Omar puts 5 cupcakes on each of 2 plates. How many cupcakes is that in all?



Task card 4 Valentine's Day Math

Noah buys a heart sticker for 35¢ and a paper heart for 25¢. How many cents does Noah spend?

Task card 5 Valentine's Day Math

The school bakes 21 brownies and 36 cupcakes for the bake sale. How many treats is that in all?

Task card 6 Valentine's Day Math

The bakery makes 70 brownies. It sells 28 of them. How many brownies are left?

Task card 7 Valentine's Day Math

Noah puts 2 brownies on each of 2 plates. How many brownies is that in all?



Task card 8 Valentine's Day Math

The school bakes 39 cupcakes and 61 heart cookies for the bake sale. How many treats is that in all?

Task card 9 Valentine's Day Math

The school bakes 23 heart cookies and 70 brownies for the bake sale. How many treats is that in all?

Task card 10 Valentine's Day Math

Ava buys a valentine card for 15¢ and a paper heart for 15¢. How many cents does Ava spend?

Task card 11 Valentine's Day Math

Zoe puts 5 heart cookies on each of 2 plates. How many heart cookies is that in all?



Task card 12 Valentine's Day Math

Mia puts 3 cupcakes on each of 3 plates. How many cupcakes is that in all?



Task card 13 Valentine's Day Math

The bakery makes 54 brownies. It sells 13 of them. How many brownies are left?

Task card 14 Valentine's Day Math

The bakery makes 85 heart cookies. It sells 63 of them. How many heart cookies are left?

Task card 15 Valentine's Day Math

The school bakes 31 brownies and 38 heart cookies for the bake sale. How many treats is that in all?

Task card 16 Valentine's Day Math

Ben buys a valentine card for 20¢ and a paper heart for 5¢. How many cents does Ben spend?

Task card 17 Valentine's Day Math

Ava buys a valentine card for 20¢ and a paper heart for 30¢. How many cents does Ava spend?

Task card 18 Valentine's Day Math

The bakery makes 98 heart cookies. It sells 29 of them. How many heart cookies are left?

Task card 19 Valentine's Day Math

The bakery makes 62 brownies. It sells 38 of them. How many brownies are left?

Task card 20 Valentine's Day Math

Ava puts 3 brownies on each of 3 plates. How many brownies is that in all?



Task card 21 Valentine's Day Math

Ella buys a paper heart for 30¢ and a heart sticker for 10¢. How many cents does Ella spend?

Task card 22 Valentine's Day Math

Ella puts 5 heart cookies on each of 2 plates. How many heart cookies is that in all?



Task card 23 Valentine's Day Math

The school bakes 25 brownies and 26 cupcakes for the bake sale. How many treats is that in all?

Task card 24 Valentine's Day Math

The school bakes 24 brownies and 33 cupcakes for the bake sale. How many treats is that in all?

Valentine's Day Math Task Cards

Recording sheet · Grade 2 · Read each story and solve.

Name: _____ Date: _____

Scan to check your answers

1	2	3	4
5	6	7	8
9	10	11	12
13	14	15	16
17	18	19	20
21	22	23	24

Valentine's Day Math Task Cards: Answer Key

Grade 2 · Easy

The answers online

1. 45	**2.** 18	**3.** 10
4. 60	**5.** 57	**6.** 42
7. 4	**8.** 100	**9.** 93
10. 30	**11.** 10	**12.** 9
13. 41	**14.** 22	**15.** 69
16. 25	**17.** 50	**18.** 69
19. 24	**20.** 9	**21.** 40
22. 10	**23.** 51	**24.** 57