Valentine's Day Math · 1

The bakery makes 62 heart cookies. It sells 42 of them. How many heart cookies are left?

Valentine's Day Math · 2

The school bakes 16 heart cookies and 56 brownies for the bake sale. How many treats is that in all?

Valentine's Day Math · 3

Leo puts 2 brownies on each of 2 plates. How many brownies is that in all?



Valentine's Day Math · 4

Lily buys a paper heart for 10¢ and a valentine card for 15¢. How many cents does Lily spend?

Valentine's Day Math · 5

Leo puts 4 brownies on each of 2 plates. How many brownies is that in all?



Valentine's Day Math · 6

Zoe buys a valentine card for 20¢ and a heart sticker for 20¢. How many cents does Zoe spend?

Valentine's Day Math · 7

The bakery makes 70 brownies. It sells 34 of them. How many brownies are left?

Valentine's Day Math · 8

The school bakes 21 brownies and 46 heart cookies for the bake sale. How many treats is that in all?

Valentine's Day Math · 2

ANSWER

72

Valentine's Day Math · 1

ANSWER

20

Valentine's Day Math · 4

ANSWER

25

Valentine's Day Math · 3

ANSWER

4

Valentine's Day Math · 6

ANSWER

40

Valentine's Day Math · 5

ANSWER

8

Valentine's Day Math · 8

ANSWER

67

Valentine's Day Math · 7

ANSWER

36

Valentine's Day Math · 9

The bakery makes 489 brownies. It sells 321 of them. How many brownies are left?

Valentine's Day Math · 10

Mia buys a valentine card for 20¢ and a paper heart for 40¢. How many cents does Mia spend?

Valentine's Day Math · 11

The bakery makes 137 brownies. It sells 54 of them. How many brownies are left?

Valentine's Day Math · 12

Ben puts 2 cupcakes on each of 3 plates. How many cupcakes is that in all?



Valentine's Day Math · 13

Ava puts 5 brownies on each of 3 plates. How many brownies is that in all?



Valentine's Day Math · 14

The school bakes 102 brownies and 281 heart cookies for the bake sale. How many treats is that in all?

Valentine's Day Math · 15

The school bakes 52 heart cookies and 106 cupcakes for the bake sale. How many treats is that in all?

Valentine's Day Math · 16

Ella buys a heart sticker for 25¢ and a paper heart for 30¢. How many cents does Ella spend?

Valentine's Day Math · 10

ANSWER

60

Valentine's Day Math · 9

ANSWER

168

Valentine's Day Math · 12

ANSWER

6

Valentine's Day Math · 11

ANSWER

83

Valentine's Day Math · 14

ANSWER

383

Valentine's Day Math · 13

ANSWER

15

Valentine's Day Math · 16

ANSWER

55

Valentine's Day Math · 15

ANSWER

158

Valentine's Day Math · 17

The bakery makes 213 cupcakes. It sells 133 of them. How many cupcakes are left?

Valentine's Day Math · 18

Ella buys a valentine card for 45¢ and a heart sticker for 5¢. How many cents does Ella spend?

Valentine's Day Math · 19

Omar buys a heart sticker for 25¢ and a valentine card for 30¢. How many cents does Omar spend?

Valentine's Day Math · 20

Omar puts 4 brownies on each of 2 plates. How many brownies is that in all?



Valentine's Day Math · 21

The school bakes 201 cupcakes and 85 heart cookies for the bake sale. How many treats is that in all?

Valentine's Day Math · 22

The bakery makes 250 cupcakes. It sells 218 of them. How many cupcakes are left?

Valentine's Day Math · 23

Ella puts 2 brownies on each of 2 plates. How many brownies is that in all?



Valentine's Day Math · 24

The school bakes 16 heart cookies and 103 brownies for the bake sale. How many treats is that in all?

Valentine's Day Math · 18

ANSWER

50

Valentine's Day Math · 17

ANSWER

80

Valentine's Day Math · 20

ANSWER

8

Valentine's Day Math · 19

ANSWER

55

Valentine's Day Math · 22

ANSWER

32

Valentine's Day Math · 21

ANSWER

286

Valentine's Day Math · 24

ANSWER

119

Valentine's Day Math · 23

ANSWER

4