**Task card 1** Thanksgiving Math

The bakery makes 61 rolls. It sells 53 of them. How many rolls are left?

**Task card 2** Thanksgiving Math

Zoe buys a paper leaf for 45¢ and a pinecone for 35¢. How many cents does Zoe spend?

**Task card 3** Thanksgiving Math

The school bakes 12 rolls and 50 corn muffins for the bake sale. How many treats is that in all?

**Task card 4** Thanksgiving Math

The school bakes 43 rolls and 35 corn muffins for the bake sale. How many treats is that in all?

**Task card 5** Thanksgiving Math

Sam puts 5 rolls on each of 3 plates. How many rolls is that in all?



**Task card 6** Thanksgiving Math

The bakery makes 53 cranberry tarts. It sells 45 of them. How many cranberry tarts are left?

**Task card 7** Thanksgiving Math

Mia buys a paper leaf for 40¢ and a mini pumpkin for 35¢. How many cents does Mia spend?

**Task card 8** Thanksgiving Math

Zoe puts 3 cranberry tarts on each of 4 plates. How many cranberry tarts is that in all?



**Task card 9** Thanksgiving Math

The school bakes 98 rolls and 218 cranberry tarts for the bake sale. How many treats is that in all?

**Task card 10** Thanksgiving Math

Ella buys a pinecone for 40¢ and a paper leaf for 10¢. How many cents does Ella spend?

**Task card 11** Thanksgiving Math

Zoe puts 5 rolls on each of 3 plates. How many rolls is that in all?



**Task card 12** Thanksgiving Math

Sam puts 3 cranberry tarts on each of 2 plates. How many cranberry tarts is that in all?



**Task card 13** Thanksgiving Math

The bakery makes 123 cranberry tarts. It sells 113 of them. How many cranberry tarts are left?

**Task card 14** Thanksgiving Math

Sam buys a paper leaf for 45¢ and a pinecone for 45¢. How many cents does Sam spend?

**Task card 15** Thanksgiving Math

The bakery makes 349 corn muffins. It sells 33 of them. How many corn muffins are left?

**Task card 16** Thanksgiving Math

The school bakes 98 rolls and 309 corn muffins for the bake sale. How many treats is that in all?

**Task card 17** Thanksgiving Math

Omar puts 4 cranberry tarts on each of 2 plates. How many cranberry tarts is that in all?



**Task card 18** Thanksgiving Math

Ben buys a paper leaf for 30¢ and a pinecone for 10¢. How many cents does Ben spend?

**Task card 19** Thanksgiving Math

The school bakes 204 corn muffins and 55 rolls for the bake sale. How many treats is that in all?

**Task card 20** Thanksgiving Math

Ben puts 4 corn muffins on each of 4 plates. How many corn muffins is that in all?



**Task card 21** Thanksgiving Math

The bakery makes 440 corn muffins. It sells 42 of them. How many corn muffins are left?

**Task card 22** Thanksgiving Math

The bakery makes 200 corn muffins. It sells 144 of them. How many corn muffins are left?

**Task card 23** Thanksgiving Math

Omar buys a pinecone for 15¢ and a mini pumpkin for 25¢. How many cents does Omar spend?

**Task card 24** Thanksgiving Math

The school bakes 43 corn muffins and 194 cranberry tarts for the bake sale. How many treats is that in all?

# Thanksgiving Math Task Cards

Recording sheet · Grade 2 · Read each story and solve.

Name: _____ Date: _____

Scan to check your answers

| | | | |
|---|---|---|---|
| 1 | 2 | 3 | 4 |
| 5 | 6 | 7 | 8 |
| 9 | 10 | 11 | 12 |
| 13 | 14 | 15 | 16 |
| 17 | 18 | 19 | 20 |
| 21 | 22 | 23 | 24 |

# Thanksgiving Math Task Cards: Answer Key

Grade 2 · Medium

The answers online

| | | |
|---|---|---|
| **1.** 8 | **2.** 80 | **3.** 62 |
| **4.** 78 | **5.** 15 | **6.** 8 |
| **7.** 75 | **8.** 12 | **9.** 316 |
| **10.** 50 | **11.** 15 | **12.** 6 |
| **13.** 10 | **14.** 90 | **15.** 316 |
| **16.** 407 | **17.** 8 | **18.** 40 |
| **19.** 259 | **20.** 16 | **21.** 398 |
| **22.** 56 | **23.** 40 | **24.** 237 |