Task card 1 Thanksgiving Math

Lily buys a pinecone for 45¢ and a paper leaf for 15¢. How many cents does Lily spend?

Task card 2 Thanksgiving Math

The school bakes 218 corn muffins and 150 cranberry tarts for the bake sale. How many treats is that in all?

Task card 3 Thanksgiving Math

The school bakes 39 corn muffins and 291 cranberry tarts for the bake sale. How many treats is that in all?

Task card 4 Thanksgiving Math

Lily puts 4 rolls on each of 2 plates. How many rolls is that in all?



Task card 5 Thanksgiving Math

The bakery makes 129 corn muffins. It sells 38 of them. How many corn muffins are left?

Task card 6 Thanksgiving Math

Lily buys a paper leaf for 45¢ and a mini pumpkin for 35¢. How many cents does Lily spend?

Task card 7 Thanksgiving Math

The bakery makes 494 rolls. It sells 57 of them. How many rolls are left?

Task card 8 Thanksgiving Math

Ella puts 3 rolls on each of 5 plates. How many rolls is that in all?



Task card 9 Thanksgiving Math

Omar buys a pinecone for 30¢ and a mini pumpkin for 45¢. How many cents does Omar spend?

Task card 10 Thanksgiving Math

The bakery makes 419 corn muffins. It sells 116 of them. How many corn muffins are left?

Task card 11 Thanksgiving Math

Sam puts 5 rolls on each of 3 plates. How many rolls is that in all?



Task card 12 Thanksgiving Math

The school bakes 176 cranberry tarts and 21 rolls for the bake sale. How many treats is that in all?

Task card 13 Thanksgiving Math

Zoe puts 2 cranberry tarts on each of 4 plates. How many cranberry tarts is that in all?



Task card 14 Thanksgiving Math

The school bakes 67 corn muffins and 41 rolls for the bake sale. How many treats is that in all?

Task card 15 Thanksgiving Math

The bakery makes 206 rolls. It sells 126 of them. How many rolls are left?

Task card 16 Thanksgiving Math

Omar buys a paper leaf for 10¢ and a pinecone for 15¢. How many cents does Omar spend?

Task card 17 Thanksgiving Math

The school bakes 199 cranberry tarts and 26 corn muffins for the bake sale. How many treats is that in all?

Task card 18 Thanksgiving Math

Mia buys a pinecone for 25¢ and a mini pumpkin for 35¢. How many cents does Mia spend?

Task card 19 Thanksgiving Math

The bakery makes 312 rolls. It sells 148 of them. How many rolls are left?

Task card 20 Thanksgiving Math

Ben puts 5 rolls on each of 5 plates. How many rolls is that in all?



Task card 21 Thanksgiving Math

Lily buys a pinecone for 10¢ and a mini pumpkin for 35¢. How many cents does Lily spend?

Task card 22 Thanksgiving Math

The bakery makes 113 cranberry tarts. It sells 25 of them. How many cranberry tarts are left?

Task card 23 Thanksgiving Math

Mia puts 4 cranberry tarts on each of 2 plates. How many cranberry tarts is that in all?



Task card 24 Thanksgiving Math

The school bakes 36 corn muffins and 456 rolls for the bake sale. How many treats is that in all?

Thanksgiving Math Task Cards

Recording sheet · Grade 2 · Read each story and solve.

Name: _____ Date: _____

Scan to check your answers

1	2	3	4
5	6	7	8
9	10	11	12
13	14	15	16
17	18	19	20
21	22	23	24

Thanksgiving Math Task Cards: Answer Key

Grade 2 · Hard

The answers online

1. 60	**2.** 368	**3.** 330
4. 8	**5.** 91	**6.** 80
7. 437	**8.** 15	**9.** 75
10. 303	**11.** 15	**12.** 197
13. 8	**14.** 108	**15.** 80
16. 25	**17.** 225	**18.** 60
19. 164	**20.** 25	**21.** 45
22. 88	**23.** 8	**24.** 492