Task card 1 Thanksgiving Math

The school bakes 14 cranberry tarts and 72 rolls for the bake sale. How many treats is that in all?

Task card 2 Thanksgiving Math

Ava buys a paper leaf for 40¢ and a mini pumpkin for 25¢. How many cents does Ava spend?

Task card 3 Thanksgiving Math

Mia buys a mini pumpkin for 20¢ and a pinecone for 5¢. How many cents does Mia spend?

Task card 4 Thanksgiving Math

Noah puts 5 corn muffins on each of 2 plates. How many corn muffins is that in all?



Task card 5 Thanksgiving Math

Zoe puts 5 cranberry tarts on each of 2 plates. How many cranberry tarts is that in all?



Task card 6 Thanksgiving Math

The bakery makes 48 cranberry tarts. It sells 14 of them. How many cranberry tarts are left?

Task card 7 Thanksgiving Math

The school bakes 36 cranberry tarts and 49 corn muffins for the bake sale. How many treats is that in all?

Task card 8 Thanksgiving Math

The bakery makes 55 corn muffins. It sells 33 of them. How many corn muffins are left?

Task card 9 Thanksgiving Math

Mia buys a paper leaf for 45¢ and a mini pumpkin for 30¢. How many cents does Mia spend?

Task card 10 Thanksgiving Math

Ava buys a pinecone for 10¢ and a mini pumpkin for 25¢. How many cents does Ava spend?

Task card 11 Thanksgiving Math

The bakery makes 38 rolls. It sells 28 of them. How many rolls are left?

Task card 12 Thanksgiving Math

Mia puts 4 corn muffins on each of 3 plates. How many corn muffins is that in all?



Task card 13 Thanksgiving Math

The school bakes 33 cranberry tarts and 15 corn muffins for the bake sale. How many treats is that in all?

Task card 14 Thanksgiving Math

Lily puts 2 rolls on each of 2 plates. How many rolls is that in all?



Task card 15 Thanksgiving Math

The bakery makes 49 corn muffins. It sells 36 of them. How many corn muffins are left?

Task card 16 Thanksgiving Math

The school bakes 29 cranberry tarts and 58 rolls for the bake sale. How many treats is that in all?

Task card 17 Thanksgiving Math

Omar buys a paper leaf for 10¢ and a pinecone for 15¢. How many cents does Omar spend?

Task card 18 Thanksgiving Math

The school bakes 12 rolls and 20 cranberry tarts for the bake sale. How many treats is that in all?

Task card 19 Thanksgiving Math

The bakery makes 78 corn muffins. It sells 43 of them. How many corn muffins are left?

Task card 20 Thanksgiving Math

Ava puts 5 rolls on each of 2 plates. How many rolls is that in all?



Task card 21 Thanksgiving Math

The bakery makes 72 rolls. It sells 33 of them. How many rolls are left?

Task card 22 Thanksgiving Math

Lily puts 2 corn muffins on each of 2 plates. How many corn muffins is that in all?



Task card 23 Thanksgiving Math

The school bakes 40 cranberry tarts and 42 corn muffins for the bake sale. How many treats is that in all?

Task card 24 Thanksgiving Math

Lily buys a paper leaf for 10¢ and a mini pumpkin for 10¢. How many cents does Lily spend?

Thanksgiving Math Task Cards

Recording sheet · Grade 2 · Read each story and solve.

Name: _____ Date: _____

Scan to check your answers

1	2	3	4
5	6	7	8
9	10	11	12
13	14	15	16
17	18	19	20
21	22	23	24

Thanksgiving Math Task Cards: Answer Key

Grade 2 · Easy

The answers online

1. 86	**2.** 65	**3.** 25
4. 10	**5.** 10	**6.** 34
7. 85	**8.** 22	**9.** 75
10. 35	**11.** 10	**12.** 12
13. 48	**14.** 4	**15.** 13
16. 87	**17.** 25	**18.** 32
19. 35	**20.** 10	**21.** 39
22. 4	**23.** 82	**24.** 20