Thanksgiving Math · 1

The bakery makes 61 rolls. It sells 53 of them. How many rolls are left?

Thanksgiving Math · 2

Zoe buys a paper leaf for 45¢ and a pinecone for 35¢. How many cents does Zoe spend?

Thanksgiving Math · 3

The school bakes 12 rolls and 50 corn muffins for the bake sale. How many treats is that in all?

Thanksgiving Math · 4

The school bakes 43 rolls and 35 corn muffins for the bake sale. How many treats is that in all?

Thanksgiving Math · 5

Sam puts 5 rolls on each of 3 plates. How many rolls is that in all?



Thanksgiving Math · 6

The bakery makes 53 cranberry tarts. It sells 45 of them. How many cranberry tarts are left?

Thanksgiving Math · 7

Mia buys a paper leaf for 40¢ and a mini pumpkin for 35¢. How many cents does Mia spend?

Thanksgiving Math · 8

Zoe puts 3 cranberry tarts on each of 4 plates. How many cranberry tarts is that in all?



Thanksgiving Math · 2

ANSWER

80

Thanksgiving Math · 1

ANSWER

8

Thanksgiving Math · 4

ANSWER

78

Thanksgiving Math · 3

ANSWER

62

Thanksgiving Math · 6

ANSWER

8

Thanksgiving Math · 5

ANSWER

15

Thanksgiving Math · 8

ANSWER

12

Thanksgiving Math · 7

ANSWER

75

Thanksgiving Math · 9

The school bakes 98 rolls and 218 cranberry tarts for the bake sale. How many treats is that in all?

Thanksgiving Math · 10

Ella buys a pinecone for 40¢ and a paper leaf for 10¢. How many cents does Ella spend?

Thanksgiving Math · 11

Zoe puts 5 rolls on each of 3 plates. How many rolls is that in all?



Thanksgiving Math · 12

Sam puts 3 cranberry tarts on each of 2 plates. How many cranberry tarts is that in all?



Thanksgiving Math · 13

The bakery makes 123 cranberry tarts. It sells 113 of them. How many cranberry tarts are left?

Thanksgiving Math · 14

Sam buys a paper leaf for 45¢ and a pinecone for 45¢. How many cents does Sam spend?

Thanksgiving Math · 15

The bakery makes 349 corn muffins. It sells 33 of them. How many corn muffins are left?

Thanksgiving Math · 16

The school bakes 98 rolls and 309 corn muffins for the bake sale. How many treats is that in all?

Thanksgiving Math · 10

ANSWER

50

Thanksgiving Math · 9

ANSWER

316

Thanksgiving Math · 12

ANSWER

6

Thanksgiving Math · 11

ANSWER

15

Thanksgiving Math · 14

ANSWER

90

Thanksgiving Math · 13

ANSWER

10

Thanksgiving Math · 16

ANSWER

407

Thanksgiving Math · 15

ANSWER

316

Thanksgiving Math · 17

Omar puts 4 cranberry tarts on each of 2 plates. How many cranberry tarts is that in all?



Thanksgiving Math · 18

Ben buys a paper leaf for 30¢ and a pinecone for 10¢. How many cents does Ben spend?

Thanksgiving Math · 19

The school bakes 204 corn muffins and 55 rolls for the bake sale. How many treats is that in all?

Thanksgiving Math · 20

Ben puts 4 corn muffins on each of 4 plates. How many corn muffins is that in all?



Thanksgiving Math · 21

The bakery makes 440 corn muffins. It sells 42 of them. How many corn muffins are left?

Thanksgiving Math · 22

The bakery makes 200 corn muffins. It sells 144 of them. How many corn muffins are left?

Thanksgiving Math · 23

Omar buys a pinecone for 15¢ and a mini pumpkin for 25¢. How many cents does Omar spend?

Thanksgiving Math · 24

The school bakes 43 corn muffins and 194 cranberry tarts for the bake sale. How many treats is that in all?

Thanksgiving Math · 18

ANSWER

40

Thanksgiving Math · 17

ANSWER

8

Thanksgiving Math · 20

ANSWER

16

Thanksgiving Math · 19

ANSWER

259

Thanksgiving Math · 22

ANSWER

56

Thanksgiving Math · 21

ANSWER

398

Thanksgiving Math · 24

ANSWER

237

Thanksgiving Math · 23

ANSWER

40