Thanksgiving Math · 1

The school bakes 14 cranberry tarts and 72 rolls for the bake sale. How many treats is that in all?

Thanksgiving Math · 2

Ava buys a paper leaf for 40¢ and a mini pumpkin for 25¢. How many cents does Ava spend?

Thanksgiving Math · 3

Mia buys a mini pumpkin for 20¢ and a pinecone for 5¢. How many cents does Mia spend?

Thanksgiving Math · 4

Noah puts 5 corn muffins on each of 2 plates. How many corn muffins is that in all?



Thanksgiving Math · 5

Zoe puts 5 cranberry tarts on each of 2 plates. How many cranberry tarts is that in all?



Thanksgiving Math · 6

The bakery makes 48 cranberry tarts. It sells 14 of them. How many cranberry tarts are left?

Thanksgiving Math · 7

The school bakes 36 cranberry tarts and 49 corn muffins for the bake sale. How many treats is that in all?

Thanksgiving Math · 8

The bakery makes 55 corn muffins. It sells 33 of them. How many corn muffins are left?

Thanksgiving Math · 2

ANSWER

65

Thanksgiving Math · 1

ANSWER

86

Thanksgiving Math · 4

ANSWER

10

Thanksgiving Math · 3

ANSWER

25

Thanksgiving Math · 6

ANSWER

34

Thanksgiving Math · 5

ANSWER

10

Thanksgiving Math · 8

ANSWER

22

Thanksgiving Math · 7

ANSWER

85

Thanksgiving Math · 9

Mia buys a paper leaf for 45¢ and a mini pumpkin for 30¢. How many cents does Mia spend?

Thanksgiving Math · 10

Ava buys a pinecone for 10¢ and a mini pumpkin for 25¢. How many cents does Ava spend?

Thanksgiving Math · 11

The bakery makes 38 rolls. It sells 28 of them. How many rolls are left?

Thanksgiving Math · 12

Mia puts 4 corn muffins on each of 3 plates. How many corn muffins is that in all?



Thanksgiving Math · 13

The school bakes 33 cranberry tarts and 15 corn muffins for the bake sale. How many treats is that in all?

Thanksgiving Math · 14

Lily puts 2 rolls on each of 2 plates. How many rolls is that in all?



Thanksgiving Math · 15

The bakery makes 49 corn muffins. It sells 36 of them. How many corn muffins are left?

Thanksgiving Math · 16

The school bakes 29 cranberry tarts and 58 rolls for the bake sale. How many treats is that in all?

Thanksgiving Math · 10

ANSWER

35

Thanksgiving Math · 9

ANSWER

75

Thanksgiving Math · 12

ANSWER

12

Thanksgiving Math · 11

ANSWER

10

Thanksgiving Math · 14

ANSWER

4

Thanksgiving Math · 13

ANSWER

48

Thanksgiving Math · 16

ANSWER

87

Thanksgiving Math · 15

ANSWER

13

Thanksgiving Math · 17

Omar buys a paper leaf for 10¢ and a pinecone for 15¢. How many cents does Omar spend?

Thanksgiving Math · 18

The school bakes 12 rolls and 20 cranberry tarts for the bake sale. How many treats is that in all?

Thanksgiving Math · 19

The bakery makes 78 corn muffins. It sells 43 of them. How many corn muffins are left?

Thanksgiving Math · 20

Ava puts 5 rolls on each of 2 plates. How many rolls is that in all?



Thanksgiving Math · 21

The bakery makes 72 rolls. It sells 33 of them. How many rolls are left?

Thanksgiving Math · 22

Lily puts 2 corn muffins on each of 2 plates. How many corn muffins is that in all?



Thanksgiving Math · 23

The school bakes 40 cranberry tarts and 42 corn muffins for the bake sale. How many treats is that in all?

Thanksgiving Math · 24

Lily buys a paper leaf for 10¢ and a mini pumpkin for 10¢. How many cents does Lily spend?

Thanksgiving Math · 18

ANSWER

32

Thanksgiving Math · 17

ANSWER

25

Thanksgiving Math · 20

ANSWER

10

Thanksgiving Math · 19

ANSWER

35

Thanksgiving Math · 22

ANSWER

4

Thanksgiving Math · 21

ANSWER

39

Thanksgiving Math · 24

ANSWER

20

Thanksgiving Math · 23

ANSWER

82