Task card 1 10 More, 10 Less, 100 More, 100 Le...

What is 10 less than 739?

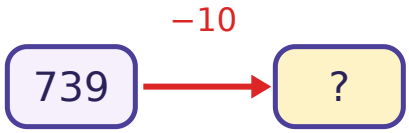

Task card 2 10 More, 10 Less, 100 More, 100 Le...

What is 10 more than 856?



Task card 3 10 More, 10 Less, 100 More, 100 Le...

What is 100 less than 687?

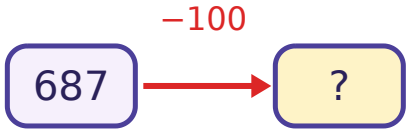

Task card 4 10 More, 10 Less, 100 More, 100 Le...

What is 100 less than 731?

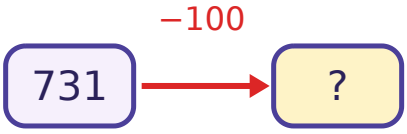

Task card 5 10 More, 10 Less, 100 More, 100 Le...

What is 100 less than 750?



Task card 6 10 More, 10 Less, 100 More, 100 Le...

What is 10 less than 582?

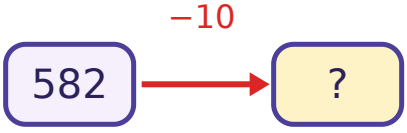

Task card 7 10 More, 10 Less, 100 More, 100 Le...

What is 10 more than 311?

+10

311 → ?

Task card 8 10 More, 10 Less, 100 More, 100 Le...

What is 10 less than 456?

−10

456 → ?

Task card 9 10 More, 10 Less, 100 More, 100 Le...

What is 10 more than 153?

+10

153 → ?

Task card 10 10 More, 10 Less, 100 More, 100 Le...

What is 100 less than 565?

−100

565 → ?

Task card 11 10 More, 10 Less, 100 More, 100 Le...

What is 10 less than 308?

−10

308 → ?

Task card 12 10 More, 10 Less, 100 More, 100 Le...

What is 10 less than 489?

−10

489 → ?

Task card 13 10 More, 10 Less, 100 More, 100 Le...

What is 100 less than 269?

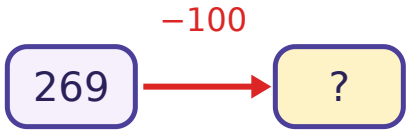

Task card 14 10 More, 10 Less, 100 More, 100 Le...

100 more than a number is 965. What is the number?

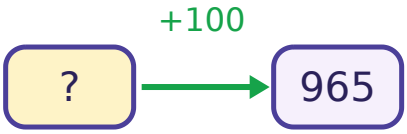

Task card 15 10 More, 10 Less, 100 More, 100 Le...

Start at 250. Go 10 less, then 10 less. Where do you end?



Task card 16 10 More, 10 Less, 100 More, 100 Le...

100 more than a number is 272. What is the number?



Task card 17 10 More, 10 Less, 100 More, 100 Le...

What is 100 more than 855?



Task card 18 10 More, 10 Less, 100 More, 100 Le...

What is 100 more than 671?



Task card 19 10 More, 10 Less, 100 More, 100 Le...

What is 10 more than 174?



Task card 20 10 More, 10 Less, 100 More, 100 Le...

What is 10 less than 481?

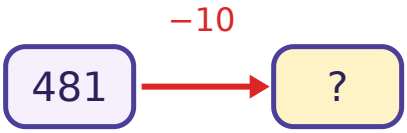

Task card 21 10 More, 10 Less, 100 More, 100 Le...

What is 10 more than 608?

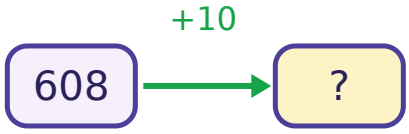

Task card 22 10 More, 10 Less, 100 More, 100 Le...

100 more than a number is 461. What is the number?



Task card 23 10 More, 10 Less, 100 More, 100 Le...

10 less than a number is 350. What is the number?

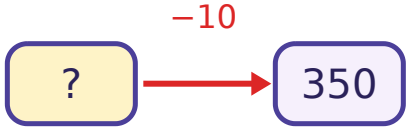

Task card 24 10 More, 10 Less, 100 More, 100 Le...

Start at 300. Go 10 more, then 100 less. Where do you end?

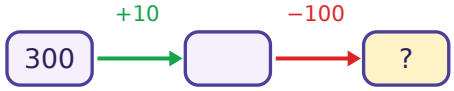

10 More, 10 Less, 100 More, 100 Less Task Cards

Recording sheet · Grade 2 · Follow the arrows. Find the missing number.

Scan to check your answers

Name: _____ Date: _____

1	2	3	4
5	6	7	8
9	10	11	12
13	14	15	16
17	18	19	20
21	22	23	24

10 More, 10 Less, 100 More, 100 Less Task Cards: Answer Key

Grade 2 · Medium

The answers online

1. 729	**2.** 866	**3.** 587
4. 631	**5.** 650	**6.** 572
7. 321	**8.** 446	**9.** 163
10. 465	**11.** 298	**12.** 479
13. 169	**14.** 865	**15.** 230
16. 172	**17.** 955	**18.** 771
19. 184	**20.** 471	**21.** 618
22. 361	**23.** 360	**24.** 210