Task card 1 10 More, 10 Less, 100 More, 100 Le...

Start at 375. Go 100 less, then 100 less. Where do you end?



Task card 2 10 More, 10 Less, 100 More, 100 Le...

Start at 926. Go 10 more, then 10 more. Where do you end?



Task card 3 10 More, 10 Less, 100 More, 100 Le...

100 less than a number is 578. What is the number?

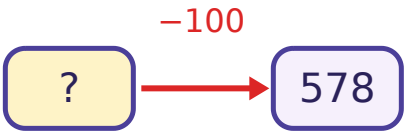

Task card 4 10 More, 10 Less, 100 More, 100 Le...

Start at 853. Go 100 less, then 10 less. Where do you end?



Task card 5 10 More, 10 Less, 100 More, 100 Le...

100 less than a number is 67. What is the number?

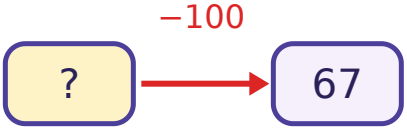

Task card 6 10 More, 10 Less, 100 More, 100 Le...

10 more than a number is 112. What is the number?

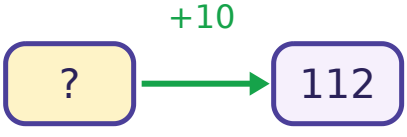

Task card 7 10 More, 10 Less, 100 More, 100 Le...

10 less than a number is 668. What is the number?

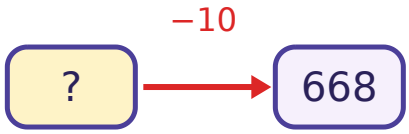

Task card 8 10 More, 10 Less, 100 More, 100 Le...

100 more than a number is 396. What is the number?

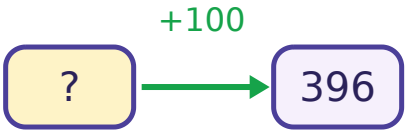

Task card 9 10 More, 10 Less, 100 More, 100 Le...

Start at 512. Go 100 less, then 10 less. Where do you end?



Task card 10 10 More, 10 Less, 100 More, 100 Le...

Start at 166. Go 100 less, then 10 more. Where do you end?



Task card 11 10 More, 10 Less, 100 More, 100 Le...

Start at 169. Go 100 more, then 10 less. Where do you end?



Task card 12 10 More, 10 Less, 100 More, 100 Le...

Start at 461. Go 100 more, then 10 more. Where do you end?

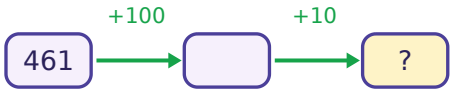

Task card 13 10 More, 10 Less, 100 More, 100 Le...

10 less than a number is 419. What is the number?

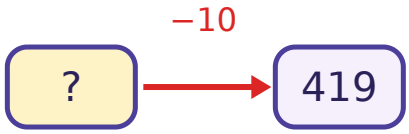

Task card 14 10 More, 10 Less, 100 More, 100 Le...

Start at 611. Go 10 more, then 100 more. Where do you end?



Task card 15 10 More, 10 Less, 100 More, 100 Le...

What is 10 more than 734?

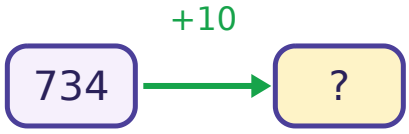

Task card 16 10 More, 10 Less, 100 More, 100 Le...

What is 100 less than 718?



Task card 17 10 More, 10 Less, 100 More, 100 Le...

Start at 846. Go 100 more, then 10 more. Where do you end?



Task card 18 10 More, 10 Less, 100 More, 100 Le...

100 more than a number is 326. What is the number?

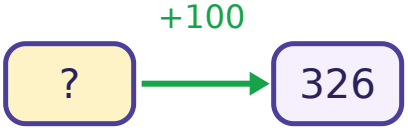

Task card 19 10 More, 10 Less, 100 More, 100 Le...

What is 10 less than 738?

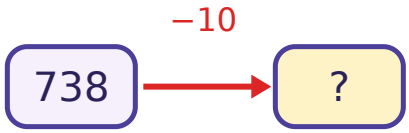

Task card 20 10 More, 10 Less, 100 More, 100 Le...

10 more than a number is 480. What is the number?

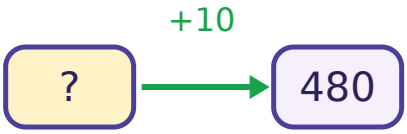

Task card 21 10 More, 10 Less, 100 More, 100 Le...

Start at 589. Go 100 less, then 100 less. Where do you end?

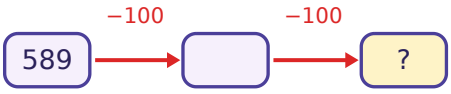

Task card 22 10 More, 10 Less, 100 More, 100 Le...

100 more than a number is 347. What is the number?

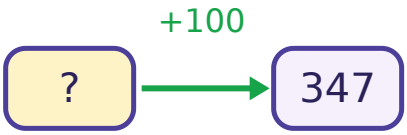

Task card 23 10 More, 10 Less, 100 More, 100 Le...

10 less than a number is 531. What is the number?

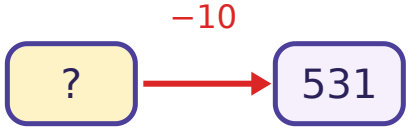

Task card 24 10 More, 10 Less, 100 More, 100 Le...

What is 100 less than 537?



10 More, 10 Less, 100 More, 100 Less Task Cards

Recording sheet · Grade 2 · Follow the arrows. Find the missing number.

Scan to check your answers

Name: _____ Date: _____

1	2	3	4
5	6	7	8
9	10	11	12
13	14	15	16
17	18	19	20
21	22	23	24

10 More, 10 Less, 100 More, 100 Less Task Cards: Answer Key

Grade 2 · Hard

The answers online

1. 175	**2.** 946	**3.** 678
4. 743	**5.** 167	**6.** 102
7. 678	**8.** 296	**9.** 402
10. 76	**11.** 259	**12.** 571
13. 429	**14.** 721	**15.** 744
16. 618	**17.** 956	**18.** 226
19. 728	**20.** 470	**21.** 389
22. 247	**23.** 541	**24.** 437