**Task card 1** 10 More, 10 Less, 100 More, 100 Le...

What is 10 less than 739?

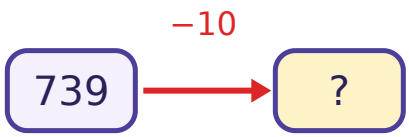


**Task card 2** 10 More, 10 Less, 100 More, 100 Le...

What is 10 more than 856?

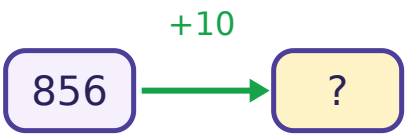


**Task card 3** 10 More, 10 Less, 100 More, 100 Le...

What is 100 less than 687?

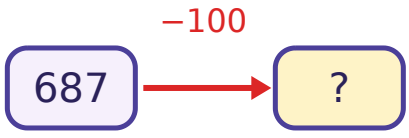


**Task card 4** 10 More, 10 Less, 100 More, 100 Le...

What is 100 less than 731?

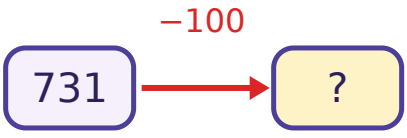


**Task card 5** 10 More, 10 Less, 100 More, 100 Le...

What is 100 less than 750?

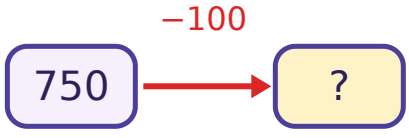


**Task card 6** 10 More, 10 Less, 100 More, 100 Le...

What is 10 less than 582?

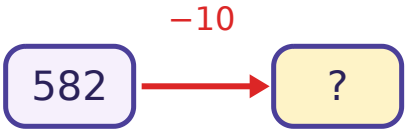

**Task card 7** 10 More, 10 Less, 100 More, 100 Le...

What is 10 more than 311?

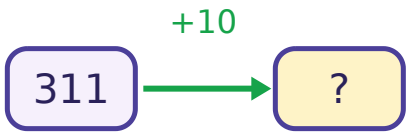


**Task card 8** 10 More, 10 Less, 100 More, 100 Le...

What is 10 less than 456?

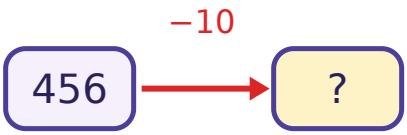


**Task card 9** 10 More, 10 Less, 100 More, 100 Le...

What is 10 more than 153?

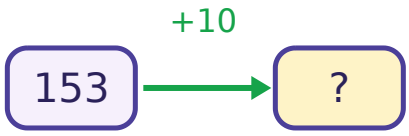


**Task card 10** 10 More, 10 Less, 100 More, 100 Le...

What is 100 less than 565?

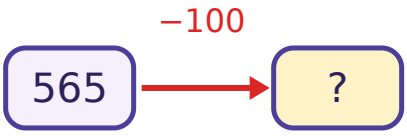


**Task card 11** 10 More, 10 Less, 100 More, 100 Le...

What is 10 less than 308?

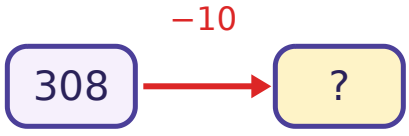


**Task card 12** 10 More, 10 Less, 100 More, 100 Le...

What is 10 less than 489?

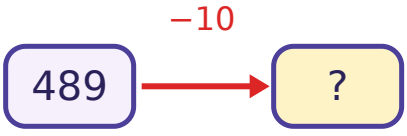

**Task card 13** 10 More, 10 Less, 100 More, 100 Le...

What is 100 less than 269?

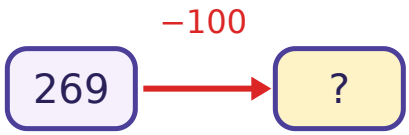


**Task card 14** 10 More, 10 Less, 100 More, 100 Le...

100 more than a number is 965. What is the number?

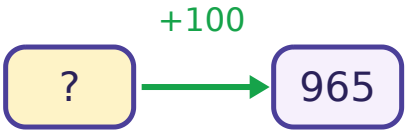


**Task card 15** 10 More, 10 Less, 100 More, 100 Le...

Start at 250. Go 10 less, then 10 less. Where do you end?

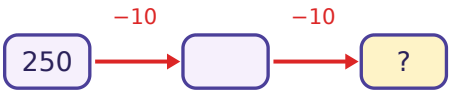


**Task card 16** 10 More, 10 Less, 100 More, 100 Le...

100 more than a number is 272. What is the number?




**Task card 17** 10 More, 10 Less, 100 More, 100 Le...

What is 100 more than 855?

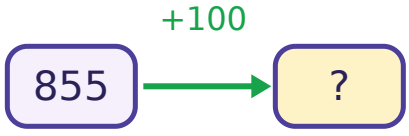


**Task card 18** 10 More, 10 Less, 100 More, 100 Le...

What is 100 more than 671?

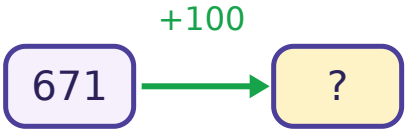

**Task card 19** 10 More, 10 Less, 100 More, 100 Le...

What is 10 more than 174?

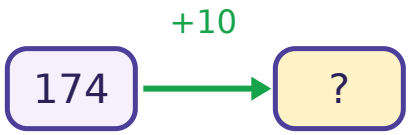


**Task card 20** 10 More, 10 Less, 100 More, 100 Le...

What is 10 less than 481?

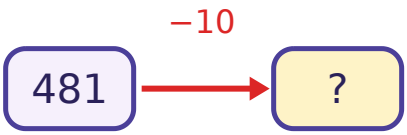


**Task card 21** 10 More, 10 Less, 100 More, 100 Le...

What is 10 more than 608?

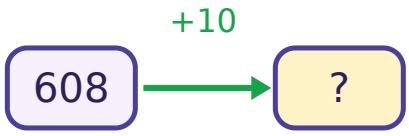


**Task card 22** 10 More, 10 Less, 100 More, 100 Le...

100 more than a number is 461. What is the number?




**Task card 23** 10 More, 10 Less, 100 More, 100 Le...

10 less than a number is 350. What is the number?

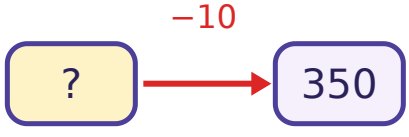


**Task card 24** 10 More, 10 Less, 100 More, 100 Le...

Start at 300. Go 10 more, then 100 less. Where do you end?

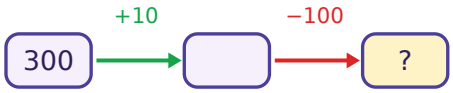

# 10 More, 10 Less, 100 More, 100 Less Task Cards

Recording sheet · Grade 2 · Follow the arrows. Find the missing number.

Scan to check your answers

Name: _____ Date: _____

| | | | |
|---|---|---|---|
| 1 | 2 | 3 | 4 |
| 5 | 6 | 7 | 8 |
| 9 | 10 | 11 | 12 |
| 13 | 14 | 15 | 16 |
| 17 | 18 | 19 | 20 |
| 21 | 22 | 23 | 24 |

# 10 More, 10 Less, 100 More, 100 Less Task Cards: Answer Key

Grade 2 · Medium

The answers online

| | | |
|---|---|---|
| **1.** 729 | **2.** 866 | **3.** 587 |
| **4.** 631 | **5.** 650 | **6.** 572 |
| **7.** 321 | **8.** 446 | **9.** 163 |
| **10.** 465 | **11.** 298 | **12.** 479 |
| **13.** 169 | **14.** 865 | **15.** 230 |
| **16.** 172 | **17.** 955 | **18.** 771 |
| **19.** 184 | **20.** 471 | **21.** 618 |
| **22.** 361 | **23.** 360 | **24.** 210 |