Task card 1 Telling Time to the Minute

The clock shows 4:55. What time is it 5 minutes later?



Task card 2 Telling Time to the Minute

The clock shows 2:45. What time is it 30 minutes later?



Task card 3 Telling Time to the Minute

What time does the clock show?



Task card 4 Telling Time to the Minute

The clock shows 11:10. What time was it 10 minutes earlier?



Task card 5 Telling Time to the Minute

The minute hand of a clock points at the number 9. How many minutes past the hour is it?

Task card 6 Telling Time to the Minute

How many minutes pass from 4:05 to 4:45?

Task card 7 Telling Time to the Minute

Ava starts swimming at 2:45 and swims for 40 minutes. What time does Ava stop swimming?

Task card 8 Telling Time to the Minute

A show ended at 1:10. It was 30 minutes long. What time did it start?

Task card 9 Telling Time to the Minute

The clock shows 4:10. What time is it 5 minutes later?



Task card 10 Telling Time to the Minute

The clock shows 6:30. What time is it 40 minutes later?



Task card 11 Telling Time to the Minute

What time does the clock show?



Task card 12 Telling Time to the Minute

The clock shows 8:40. What time was it 15 minutes earlier?



Task card 13 Telling Time to the Minute

The minute hand of a clock points at the number 3. How many minutes past the hour is it?

Task card 14 Telling Time to the Minute

How many minutes pass from 5:20 to 5:45?

Task card 15 Telling Time to the Minute

Ben starts painting at 12:15 and paints for 30 minutes. What time does Ben stop painting?

Task card 16 Telling Time to the Minute

A game ended at 3:00. It was 25 minutes long. What time did it start?

Task card 17 Telling Time to the Minute

The clock shows 3:50. What time is it 30 minutes later?



Task card 18 Telling Time to the Minute

The clock shows 1:20. What time is it 15 minutes later?



Task card 19 Telling Time to the Minute

What time does the clock show?



Task card 20 Telling Time to the Minute

The clock shows 1:05. What time was it 15 minutes earlier?



Task card 21 Telling Time to the Minute

The minute hand of a clock points at the number 6. How many minutes past the hour is it?

Task card 22 Telling Time to the Minute

How many minutes pass from 7:25 to 7:30?

Task card 23 Telling Time to the Minute

Ben starts painting at 5:55 and paints for 40 minutes. What time does Ben stop painting?

Task card 24 Telling Time to the Minute

A game ended at 3:35. It was 10 minutes long. What time did it start?

Telling Time to the Minute Task Cards

Recording sheet · Grade 2 · Answer each question about the time. Write times like 4:05.

Name: _____ Date: _____

Scan to check your answers

1	2	3	4
5	6	7	8
9	10	11	12
13	14	15	16
17	18	19	20
21	22	23	24

Telling Time to the Minute Task Cards: Answer Key

Grade 2 · Hard

The answers online

1. 5:00	**2.** 3:15	**3.** 12:45
4. 11:00	**5.** 45	**6.** 40
7. 3:25	**8.** 12:40	**9.** 4:15
10. 7:10	**11.** 4:25	**12.** 8:25
13. 15	**14.** 25	**15.** 12:45
16. 2:35	**17.** 4:20	**18.** 1:35
19. 6:15	**20.** 12:50	**21.** 30
22. 5	**23.** 6:35	**24.** 3:25