Task card 1 Telling Time to the Minute

The clock shows 12:30. What time is it 10 minutes later?



Task card 2 Telling Time to the Minute

The clock shows 12:35. What time is it 10 minutes later?



Task card 3 Telling Time to the Minute

What time does the clock show?



Task card 4 Telling Time to the Minute

The clock shows 7:15. What time was it 5 minutes earlier?



Task card 5 Telling Time to the Minute

The minute hand of a clock points at the number 6. How many minutes past the hour is it?

Task card 6 Telling Time to the Minute

How many minutes pass from 10:25 to 10:30?

Task card 7 Telling Time to the Minute

Ava starts swimming at 9:10 and swims for 10 minutes. What time does Ava stop swimming?

Task card 8 Telling Time to the Minute

A show ended at 2:40. It was 10 minutes long. What time did it start?

Task card 9 Telling Time to the Minute

The clock shows 8:55. What time is it 10 minutes later?



Task card 10 Telling Time to the Minute

The clock shows 7:25. What time is it 10 minutes later?



Task card 11 Telling Time to the Minute

What time does the clock show?



Task card 12 Telling Time to the Minute

The clock shows 8:35. What time was it 15 minutes earlier?



Task card 13 Telling Time to the Minute

How many minutes pass from 8:20 to 8:35?

Task card 14 Telling Time to the Minute

Max starts to play at 6:50 and plays for 5 minutes. What time does Max stop playing?

Task card 15 Telling Time to the Minute

A show ended at 11:10. It was 5 minutes long. What time did it start?

Task card 16 Telling Time to the Minute

The clock shows 1:40. What time is it 5 minutes later?



Task card 17 Telling Time to the Minute

The clock shows 4:40. What time is it 20 minutes later?



Task card 18 Telling Time to the Minute

What time does the clock show?



Task card 19 Telling Time to the Minute

The clock shows 12:30. What time was it 15 minutes earlier?



Task card 20 Telling Time to the Minute

The minute hand of a clock points at the number 11. How many minutes past the hour is it?

Task card 21 Telling Time to the Minute

How many minutes pass from 7:40 to 7:50?

Task card 22 Telling Time to the Minute

Sam starts painting at 3:05 and paints for 10 minutes. What time does Sam stop painting?

Task card 23 Telling Time to the Minute

A music lesson ended at 6:15. It was 15 minutes long. What time did it start?

Task card 24 Telling Time to the Minute

The clock shows 6:25. What time is it 10 minutes later?



Telling Time to the Minute Task Cards

Recording sheet · Grade 2 · Answer each question about the time. Write times like 4:05.

Name: _____ Date: _____

Scan to check your answers

1	2	3	4
5	6	7	8
9	10	11	12
13	14	15	16
17	18	19	20
21	22	23	24

Telling Time to the Minute Task Cards: Answer Key

Grade 2 · Easy

The answers online

1. 12:40	**2.** 12:45	**3.** 2:00
4. 7:10	**5.** 30	**6.** 5
7. 9:20	**8.** 2:30	**9.** 9:05
10. 7:35	**11.** 6:40	**12.** 8:20
13. 15	**14.** 6:55	**15.** 11:05
16. 1:45	**17.** 5:00	**18.** 5:40
19. 12:15	**20.** 55	**21.** 10
22. 3:15	**23.** 6:00	**24.** 6:35