Telling Time to the Minute · 1

The clock shows 7:55. What time is it 15 minutes later?



Telling Time to the Minute · 2

The clock shows 6:35. What time is it 20 minutes later?



Telling Time to the Minute · 3

What time does the clock show?



Telling Time to the Minute · 4

The clock shows 4:55. What time was it 20 minutes earlier?



Telling Time to the Minute · 5

The minute hand of a clock points at the number 3. How many minutes past the hour is it?

Telling Time to the Minute · 6

How many minutes pass from 7:10 to 7:15?

Telling Time to the Minute · 7

Mia starts painting at 3:55 and paints for 5 minutes. What time does Mia stop painting?

Telling Time to the Minute · 8

A music lesson ended at 2:35. It was 20 minutes long. What time did it start?

Telling Time to the Minute · 2

ANSWER

6:55

Telling Time to the Minute · 1

ANSWER

8:10

Telling Time to the Minute · 4

ANSWER

4:35

Telling Time to the Minute · 3

ANSWER

5:20

Telling Time to the Minute · 6

ANSWER

5

Telling Time to the Minute · 5

ANSWER

15

Telling Time to the Minute · 8

ANSWER

2:15

Telling Time to the Minute · 7

ANSWER

4:00

Telling Time to the Minute · 9

The clock shows 4:10. What time is it 30 minutes later?



Telling Time to the Minute · 10

The clock shows 1:10. What time is it 5 minutes later?



Telling Time to the Minute · 11

What time does the clock show?



Telling Time to the Minute · 12

The clock shows 8:30. What time was it 20 minutes earlier?



Telling Time to the Minute · 13

The minute hand of a clock points at the number 11. How many minutes past the hour is it?

Telling Time to the Minute · 14

How many minutes pass from 11:40 to 12:10?

Telling Time to the Minute · 15

Zoe starts to play at 2:30 and plays for 5 minutes. What time does Zoe stop playing?

Telling Time to the Minute · 16

A music lesson ended at 5:15. It was 15 minutes long. What time did it start?

Telling Time to the Minute · 10

ANSWER

1:15

Telling Time to the Minute · 9

ANSWER

4:40

Telling Time to the Minute · 12

ANSWER

8:10

Telling Time to the Minute · 11

ANSWER

4:55

Telling Time to the Minute · 14

ANSWER

30

Telling Time to the Minute · 13

ANSWER

55

Telling Time to the Minute · 16

ANSWER

5:00

Telling Time to the Minute · 15

ANSWER

2:35

Telling Time to the Minute · 17

The clock shows 4:45. What time is it 15 minutes later?



Telling Time to the Minute · 18

The clock shows 3:30. What time is it 25 minutes later?



Telling Time to the Minute · 19

What time does the clock show?



Telling Time to the Minute · 20

The clock shows 9:05. What time was it 30 minutes earlier?



Telling Time to the Minute · 21

The minute hand of a clock points at the number 4. How many minutes past the hour is it?

Telling Time to the Minute · 22

How many minutes pass from 4:15 to 4:25?

Telling Time to the Minute · 23

Ben starts reading at 5:45 and reads for 35 minutes. What time does Ben stop reading?

Telling Time to the Minute · 24

A bus ride ended at 11:45. It was 20 minutes long. What time did it start?

Telling Time to the Minute · 18

ANSWER

3:55

Telling Time to the Minute · 17

ANSWER

5:00

Telling Time to the Minute · 20

ANSWER

8:35

Telling Time to the Minute · 19

ANSWER

1:30

Telling Time to the Minute · 22

ANSWER

10

Telling Time to the Minute · 21

ANSWER

20

Telling Time to the Minute · 24

ANSWER

11:25

Telling Time to the Minute · 23

ANSWER

6:20