Telling Time to the Minute · 1

The clock shows 4:55. What time is it 5 minutes later?



Telling Time to the Minute · 2

The clock shows 2:45. What time is it 30 minutes later?



Telling Time to the Minute · 3

What time does the clock show?



Telling Time to the Minute · 4

The clock shows 11:10. What time was it 10 minutes earlier?



Telling Time to the Minute · 5

The minute hand of a clock points at the number 9. How many minutes past the hour is it?

Telling Time to the Minute · 6

How many minutes pass from 4:05 to 4:45?

Telling Time to the Minute · 7

Ava starts swimming at 2:45 and swims for 40 minutes. What time does Ava stop swimming?

Telling Time to the Minute · 8

A show ended at 1:10. It was 30 minutes long. What time did it start?

Telling Time to the Minute · 2

**ANSWER**

# 3:15

Telling Time to the Minute · 1

**ANSWER**

# 5:00

Telling Time to the Minute · 4

**ANSWER**

# 11:00

Telling Time to the Minute · 3

**ANSWER**

# 12:45

Telling Time to the Minute · 6

**ANSWER**

# 40

Telling Time to the Minute · 5

**ANSWER**

# 45

Telling Time to the Minute · 8

**ANSWER**

# 12:40

Telling Time to the Minute · 7

**ANSWER**

# 3:25

Telling Time to the Minute · 9

The clock shows 4:10. What time is it 5 minutes later?



Telling Time to the Minute · 10

The clock shows 6:30. What time is it 40 minutes later?



Telling Time to the Minute · 11

What time does the clock show?



Telling Time to the Minute · 12

The clock shows 8:40. What time was it 15 minutes earlier?



Telling Time to the Minute · 13

The minute hand of a clock points at the number 3. How many minutes past the hour is it?

Telling Time to the Minute · 14

How many minutes pass from 5:20 to 5:45?

Telling Time to the Minute · 15

Ben starts painting at 12:15 and paints for 30 minutes. What time does Ben stop painting?

Telling Time to the Minute · 16

A game ended at 3:00. It was 25 minutes long. What time did it start?

Telling Time to the Minute · 10

**ANSWER**

# 7:10

Telling Time to the Minute · 9

**ANSWER**

# 4:15

Telling Time to the Minute · 12

**ANSWER**

# 8:25

Telling Time to the Minute · 11

**ANSWER**

# 4:25

Telling Time to the Minute · 14

**ANSWER**

# 25

Telling Time to the Minute · 13

**ANSWER**

# 15

Telling Time to the Minute · 16

**ANSWER**

# 2:35

Telling Time to the Minute · 15

**ANSWER**

# 12:45

Telling Time to the Minute · 17

The clock shows 3:50. What time is it 30 minutes later?



Telling Time to the Minute · 18

The clock shows 1:20. What time is it 15 minutes later?



Telling Time to the Minute · 19

What time does the clock show?



Telling Time to the Minute · 20

The clock shows 1:05. What time was it 15 minutes earlier?



Telling Time to the Minute · 21

The minute hand of a clock points at the number 6. How many minutes past the hour is it?

Telling Time to the Minute · 22

How many minutes pass from 7:25 to 7:30?

Telling Time to the Minute · 23

Ben starts painting at 5:55 and paints for 40 minutes. What time does Ben stop painting?

Telling Time to the Minute · 24

A game ended at 3:35. It was 10 minutes long. What time did it start?

Telling Time to the Minute · 18

**ANSWER**

# 1:35

Telling Time to the Minute · 17

**ANSWER**

# 4:20

Telling Time to the Minute · 20

**ANSWER**

# 12:50

Telling Time to the Minute · 19

**ANSWER**

# 6:15

Telling Time to the Minute · 22

**ANSWER**

# 5

Telling Time to the Minute · 21

**ANSWER**

# 30

Telling Time to the Minute · 24

**ANSWER**

# 3:25

Telling Time to the Minute · 23

**ANSWER**

# 6:35