Telling Time to the Minute · 1

The clock shows 12:30. What time is it 10 minutes later?



Telling Time to the Minute · 2

The clock shows 12:35. What time is it 10 minutes later?



Telling Time to the Minute · 3

What time does the clock show?



Telling Time to the Minute · 4

The clock shows 7:15. What time was it 5 minutes earlier?



Telling Time to the Minute · 5

The minute hand of a clock points at the number 6. How many minutes past the hour is it?

Telling Time to the Minute · 6

How many minutes pass from 10:25 to 10:30?

Telling Time to the Minute · 7

Ava starts swimming at 9:10 and swims for 10 minutes. What time does Ava stop swimming?

Telling Time to the Minute · 8

A show ended at 2:40. It was 10 minutes long. What time did it start?

Telling Time to the Minute · 2

ANSWER

12:45

Telling Time to the Minute · 1

ANSWER

12:40

Telling Time to the Minute · 4

ANSWER

7:10

Telling Time to the Minute · 3

ANSWER

2:00

Telling Time to the Minute · 6

ANSWER

5

Telling Time to the Minute · 5

ANSWER

30

Telling Time to the Minute · 8

ANSWER

2:30

Telling Time to the Minute · 7

ANSWER

9:20

Telling Time to the Minute · 9

The clock shows 8:55. What time is it 10 minutes later?



Telling Time to the Minute · 10

The clock shows 7:25. What time is it 10 minutes later?



Telling Time to the Minute · 11

What time does the clock show?



Telling Time to the Minute · 12

The clock shows 8:35. What time was it 15 minutes earlier?



Telling Time to the Minute · 13

How many minutes pass from 8:20 to 8:35?

Telling Time to the Minute · 14

Max starts to play at 6:50 and plays for 5 minutes. What time does Max stop playing?

Telling Time to the Minute · 15

A show ended at 11:10. It was 5 minutes long. What time did it start?

Telling Time to the Minute · 16

The clock shows 1:40. What time is it 5 minutes later?



Telling Time to the Minute · 10

ANSWER

7:35

Telling Time to the Minute · 9

ANSWER

9:05

Telling Time to the Minute · 12

ANSWER

8:20

Telling Time to the Minute · 11

ANSWER

6:40

Telling Time to the Minute · 14

ANSWER

6:55

Telling Time to the Minute · 13

ANSWER

15

Telling Time to the Minute · 16

ANSWER

1:45

Telling Time to the Minute · 15

ANSWER

11:05

Telling Time to the Minute · 17

The clock shows 4:40. What time is it 20 minutes later?



Telling Time to the Minute · 18

What time does the clock show?



Telling Time to the Minute · 19

The clock shows 12:30. What time was it 15 minutes earlier?



Telling Time to the Minute · 20

The minute hand of a clock points at the number 11. How many minutes past the hour is it?

Telling Time to the Minute · 21

How many minutes pass from 7:40 to 7:50?

Telling Time to the Minute · 22

Sam starts painting at 3:05 and paints for 10 minutes. What time does Sam stop painting?

Telling Time to the Minute · 23

A music lesson ended at 6:15. It was 15 minutes long. What time did it start?

Telling Time to the Minute · 24

The clock shows 6:25. What time is it 10 minutes later?



Telling Time to the Minute · 18

ANSWER

5:40

Telling Time to the Minute · 17

ANSWER

5:00

Telling Time to the Minute · 20

ANSWER

55

Telling Time to the Minute · 19

ANSWER

12:15

Telling Time to the Minute · 22

ANSWER

3:15

Telling Time to the Minute · 21

ANSWER

10

Telling Time to the Minute · 24

ANSWER

6:35

Telling Time to the Minute · 23

ANSWER

6:00