Task card 1 Tape Diagrams: Adding & Subtractin...

Ben has 3 beads. Leo has 46 more beads than Ben. How many beads does Leo have?

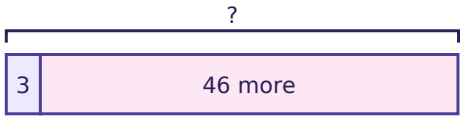

Task card 2 Tape Diagrams: Adding & Subtractin...

Ava has 45 shells. 24 are white. The rest are pink. How many are pink?

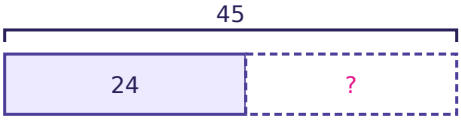

Task card 3 Tape Diagrams: Adding & Subtractin...

Eli has 4 picture books and 14 chapter books. How many books does Eli have in all?

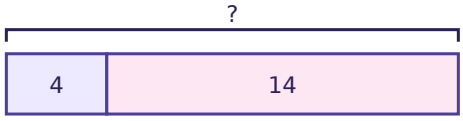

Task card 4 Tape Diagrams: Adding & Subtractin...

Sam has 17 shells. 9 are white. The rest are pink. How many are pink?

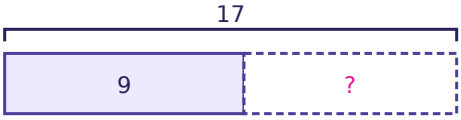

Task card 5 Tape Diagrams: Adding & Subtractin...

Eli has 22 marbles. 15 are green. The rest are yellow. How many are yellow?

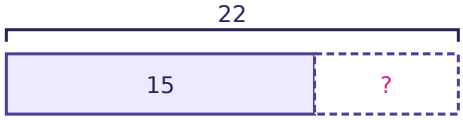

Task card 6 Tape Diagrams: Adding & Subtractin...

Ben has 13 white shells and 15 pink shells. How many shells does Ben have in all?

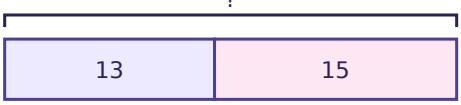

Task card 7 Tape Diagrams: Adding & Subtractin...

Lily has 4 marbles. Sam has 18 more marbles than Lily. How many marbles does Sam have?

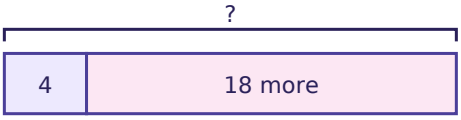

Task card 8 Tape Diagrams: Adding & Subtractin...

Ava has 10 white shells and 36 pink shells. How many shells does Ava have in all?

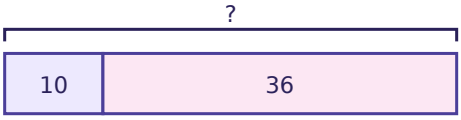

Task card 9 Tape Diagrams: Adding & Subtractin...

Ben had some stickers. Then Ben got 58 more. Now Ben has 95. How many stickers did Ben have at first?

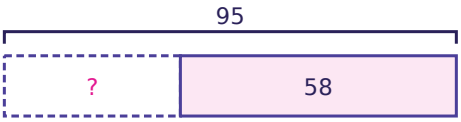

Task card 10 Tape Diagrams: Adding & Subtractin...

Zoe has 46 stickers. Nora has 21 more stickers than Zoe. How many stickers does Nora have?

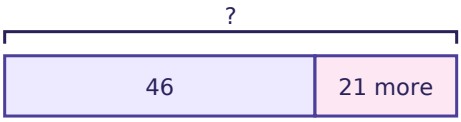

Task card 11 Tape Diagrams: Adding & Subtractin...

Zoe has 52 shells. Ben has 6 more shells than Zoe. How many shells does Ben have?

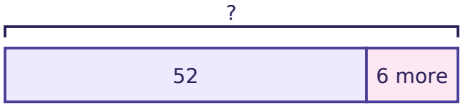

Task card 12 Tape Diagrams: Adding & Subtractin...

Nora had some books. Then Nora got 18 more. Now Nora has 34. How many books did Nora have at first?

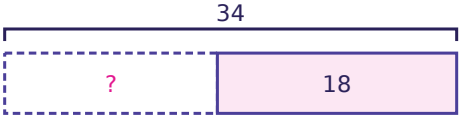

Task card 13 Tape Diagrams: Adding & Subtractin...

Max has 95 beads. 49 are red. The rest are blue. How many are blue?

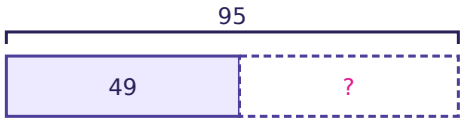

Task card 14 Tape Diagrams: Adding & Subtractin...

Leo has 94 stickers. That is 67 more than Max has. How many stickers does Max have?

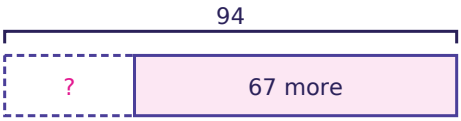

Task card 15 Tape Diagrams: Adding & Subtractin...

Sam has 33 marbles. That is 11 more than Ava has. How many marbles does Ava have?



Task card 16 Tape Diagrams: Adding & Subtractin...

Sam had some books. Then Sam got 47 more. Now Sam has 55. How many books did Sam have at first?

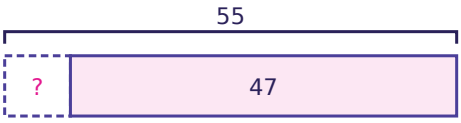

Task card 17 Tape Diagrams: Adding & Subtractin...

Max had some cards. Then Max got 13 more. Now Max has 80. How many cards did Max have at first?

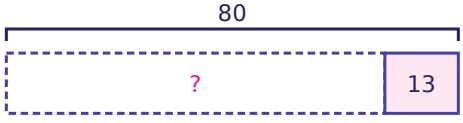

Task card 18 Tape Diagrams: Adding & Subtractin...

Zoe had some beads. Then Zoe got 34 more. Now Zoe has 48. How many beads did Zoe have at first?

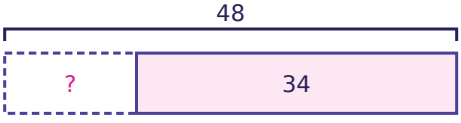

Task card 19 Tape Diagrams: Adding & Subtractin...

Nora has 34 cards. Mia has 9 more cards than Nora. How many cards does Mia have?

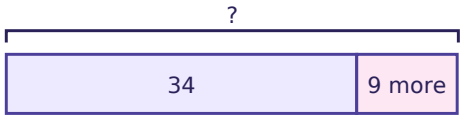

Task card 20 Tape Diagrams: Adding & Subtractin...

Zoe has 80 beads. 73 are red. The rest are blue. How many are blue?

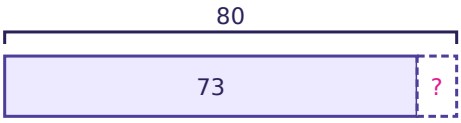

Task card 21 Tape Diagrams: Adding & Subtractin...

Ava has 85 books. 17 are picture. The rest are chapter. How many are chapter?



Task card 22 Tape Diagrams: Adding & Subtractin...

Sam had some shells. Then Sam got 25 more. Now Sam has 72. How many shells did Sam have at first?



Task card 23 Tape Diagrams: Adding & Subtractin...

Leo has 74 marbles. 9 are green. The rest are yellow. How many are yellow?



Task card 24 Tape Diagrams: Adding & Subtractin...

Leo had some marbles. Then Leo got 36 more. Now Leo has 52. How many marbles did Leo have at first?

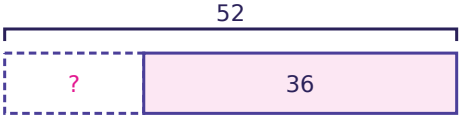

Tape Diagrams: Adding & Subtracting Task Cards

Recording sheet · Grade 2 · Read the story and look at the tape diagram. Find the missing number.

Scan to check your answers

Name: _____ Date: _____

1	2	3	4
5	6	7	8
9	10	11	12
13	14	15	16
17	18	19	20
21	22	23	24

Tape Diagrams: Adding & Subtracting Task Cards: Answer Key

Grade 2 · Medium

The answers online

1. 49	**2.** 21	**3.** 18
4. 8	**5.** 7	**6.** 28
7. 22	**8.** 46	**9.** 37
10. 67	**11.** 58	**12.** 16
13. 46	**14.** 27	**15.** 22
16. 8	**17.** 67	**18.** 14
19. 43	**20.** 7	**21.** 68
22. 47	**23.** 65	**24.** 16