Task card 1 Tape Diagrams: Adding & Subtractin...

Eli has 15 shells. 4 are white. The rest are pink. How many are pink?



Task card 2 Tape Diagrams: Adding & Subtractin...

Nora has 17 shells. 13 are white. The rest are pink. How many are pink?

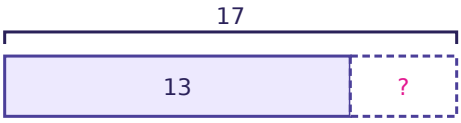

Task card 3 Tape Diagrams: Adding & Subtractin...

Max has 18 beads. 13 are red. The rest are blue. How many are blue?

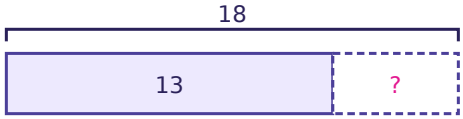

Task card 4 Tape Diagrams: Adding & Subtractin...

Ben has 7 star stickers and 5 heart stickers. How many stickers does Ben have in all?

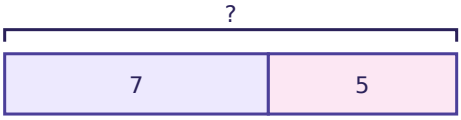

Task card 5 Tape Diagrams: Adding & Subtractin...

Nora has 11 red beads and 3 blue beads. How many beads does Nora have in all?

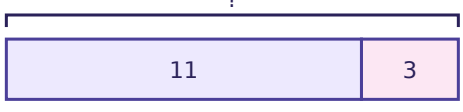

Task card 6 Tape Diagrams: Adding & Subtractin...

Leo has 13 beads. 9 are red. The rest are blue. How many are blue?

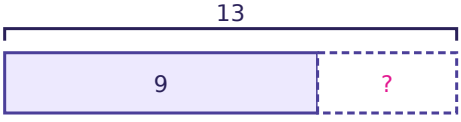

Task card 7 Tape Diagrams: Adding & Subtractin...

Eli has 14 white shells and 4 pink shells. How many shells does Eli have in all?

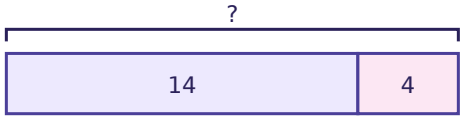

Task card 8 Tape Diagrams: Adding & Subtractin...

Eli has 14 books. 10 are picture. The rest are chapter. How many are chapter?

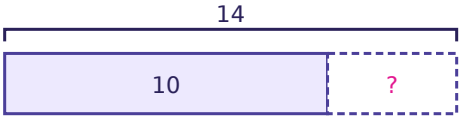

Task card 9 Tape Diagrams: Adding & Subtractin...

Leo has 14 red beads and 3 blue beads. How many beads does Leo have in all?

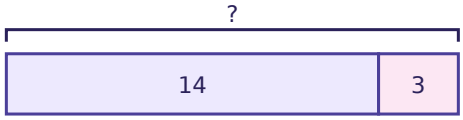

Task card 10 Tape Diagrams: Adding & Subtractin...

Zoe has 6 picture books and 6 chapter books. How many books does Zoe have in all?

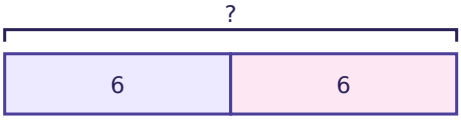

Task card 11 Tape Diagrams: Adding & Subtractin...

Sam has 5 green marbles and 10 yellow marbles. How many marbles does Sam have in all?

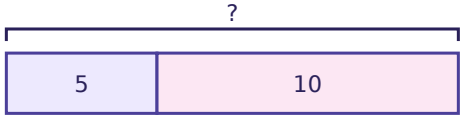

Task card 12 Tape Diagrams: Adding & Subtractin...

Nora has 11 marbles. 6 are green. The rest are yellow. How many are yellow?

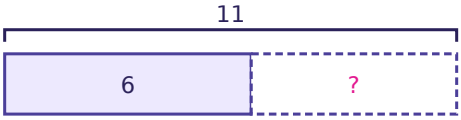

Task card 13 Tape Diagrams: Adding & Subtractin...

Zoe has 7 white shells and 6 pink shells. How many shells does Zoe have in all?

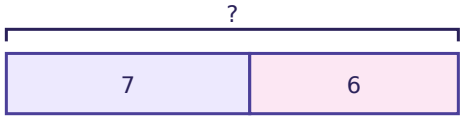

Task card 14 Tape Diagrams: Adding & Subtractin...

Lily has 20 stickers. 14 are star. The rest are heart. How many are heart?

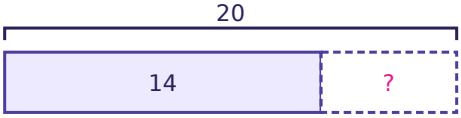

Task card 15 Tape Diagrams: Adding & Subtractin...

Lily has 8 stickers. 4 are star. The rest are heart. How many are heart?

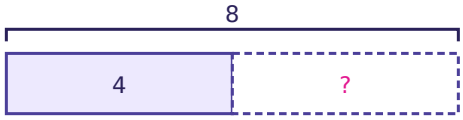

Task card 16 Tape Diagrams: Adding & Subtractin...

Zoe has 8 books. 3 are picture. The rest are chapter. How many are chapter?

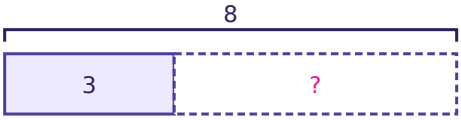

Task card 17 Tape Diagrams: Adding & Subtractin...

Leo has 19 green marbles and 28 yellow marbles. How many marbles does Leo have in all?

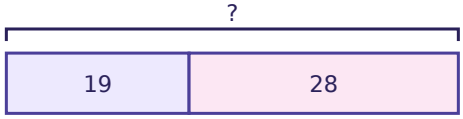

Task card 18 Tape Diagrams: Adding & Subtractin...

Zoe has 25 cards. 21 are animal. The rest are sports. How many are sports?

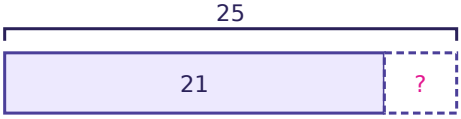

Task card 19 Tape Diagrams: Adding & Subtractin...

Eli has 27 shells. Leo has 23 more shells than Eli. How many shells does Leo have?

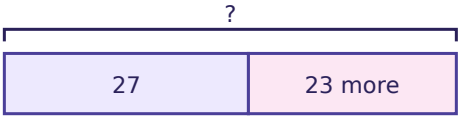

Task card 20 Tape Diagrams: Adding & Subtractin...

Max has 24 beads. Eli has 17 more beads than Max. How many beads does Eli have?

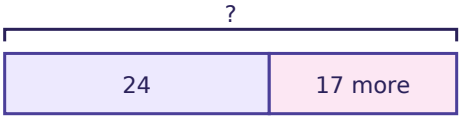

Task card 21 Tape Diagrams: Adding & Subtractin...

Max has 23 star stickers and 16 heart stickers. How many stickers does Max have in all?

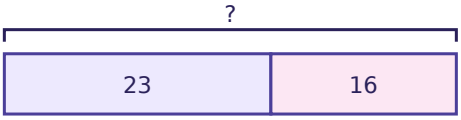

Task card 22 Tape Diagrams: Adding & Subtractin...

Eli has 8 green marbles and 20 yellow marbles. How many marbles does Eli have in all?

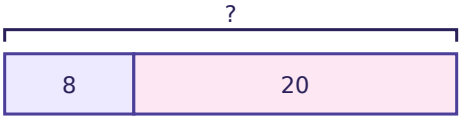

Task card 23 Tape Diagrams: Adding & Subtractin...

Ava has 7 white shells and 20 pink shells. How many shells does Ava have in all?

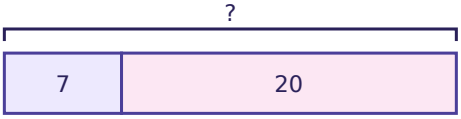

Task card 24 Tape Diagrams: Adding & Subtractin...

Zoe has 24 cards. Leo has 4 more cards than Zoe. How many cards does Leo have?

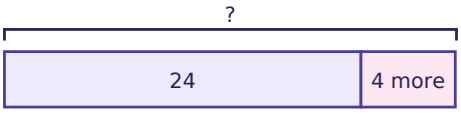

Tape Diagrams: Adding & Subtracting Task Cards

Recording sheet · Grade 2 · Read the story and look at the tape diagram. Find the missing number.

Scan to check your answers

Name: _____ Date: _____

1	2	3	4
5	6	7	8
9	10	11	12
13	14	15	16
17	18	19	20
21	22	23	24

Tape Diagrams: Adding & Subtracting Task Cards: Answer Key

Grade 2 · Easy

The answers online

1. 11	**2.** 4	**3.** 5
4. 12	**5.** 14	**6.** 4
7. 18	**8.** 4	**9.** 17
10. 12	**11.** 15	**12.** 5
13. 13	**14.** 6	**15.** 4
16. 5	**17.** 47	**18.** 4
19. 50	**20.** 41	**21.** 39
22. 28	**23.** 27	**24.** 28