Tape Diagrams: Adding & Subtracting · 1

Ben has 3 beads. Leo has 46 more beads than Ben. How many beads does Leo have?

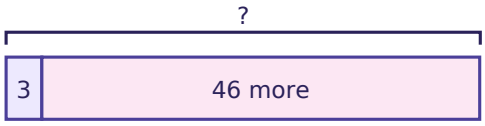

Tape Diagrams: Adding & Subtracting · 2

Ava has 45 shells. 24 are white. The rest are pink. How many are pink?

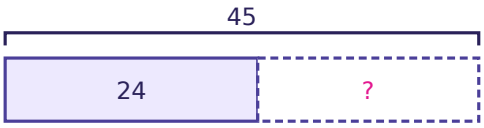

Tape Diagrams: Adding & Subtracting · 3

Eli has 4 picture books and 14 chapter books. How many books does Eli have in all?

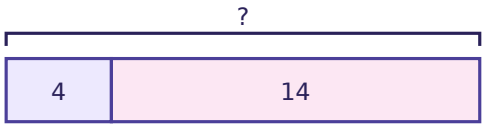

Tape Diagrams: Adding & Subtracting · 4

Sam has 17 shells. 9 are white. The rest are pink. How many are pink?

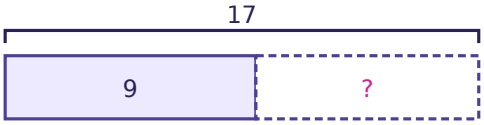

Tape Diagrams: Adding & Subtracting · 5

Eli has 22 marbles. 15 are green. The rest are yellow. How many are yellow?

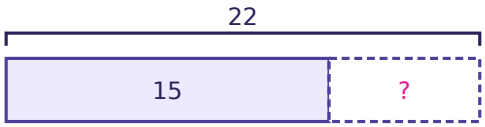

Tape Diagrams: Adding & Subtracting · 6

Ben has 13 white shells and 15 pink shells. How many shells does Ben have in all?

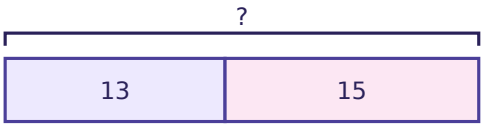

Tape Diagrams: Adding & Subtracting · 7

Lily has 4 marbles. Sam has 18 more marbles than Lily. How many marbles does Sam have?

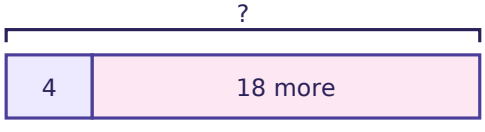

Tape Diagrams: Adding & Subtracting · 8

Ava has 10 white shells and 36 pink shells. How many shells does Ava have in all?

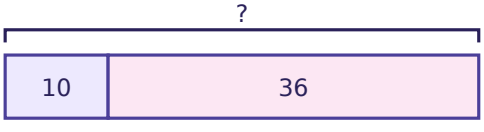

Tape Diagrams: Adding & Subtracting · 2

ANSWER

21

Tape Diagrams: Adding & Subtracting · 1

ANSWER

49

Tape Diagrams: Adding & Subtracting · 4

ANSWER

8

Tape Diagrams: Adding & Subtracting · 3

ANSWER

18

Tape Diagrams: Adding & Subtracting · 6

ANSWER

28

Tape Diagrams: Adding & Subtracting · 5

ANSWER

7

Tape Diagrams: Adding & Subtracting · 8

ANSWER

46

Tape Diagrams: Adding & Subtracting · 7

ANSWER

22

Ben had some stickers. Then Ben got 58 more. Now Ben has 95. How many stickers did Ben have at first?

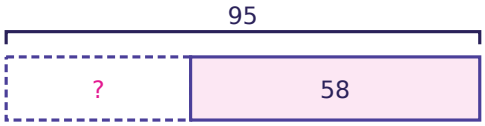

Zoe has 46 stickers. Nora has 21 more stickers than Zoe. How many stickers does Nora have?

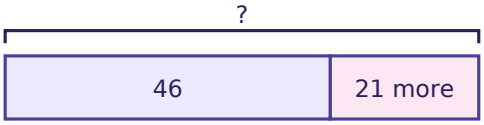

Zoe has 52 shells. Ben has 6 more shells than Zoe. How many shells does Ben have?

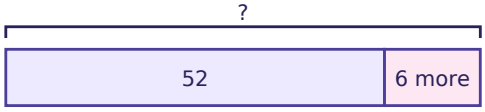

Nora had some books. Then Nora got 18 more. Now Nora has 34. How many books did Nora have at first?

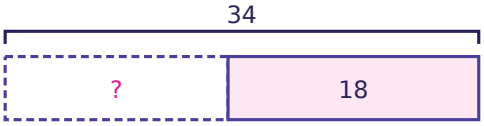

Max has 95 beads. 49 are red. The rest are blue. How many are blue?

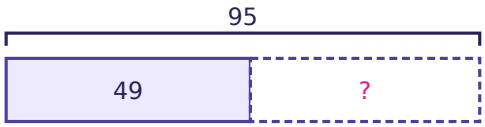

Leo has 94 stickers. That is 67 more than Max has. How many stickers does Max have?



Sam has 33 marbles. That is 11 more than Ava has. How many marbles does Ava have?



Sam had some books. Then Sam got 47 more. Now Sam has 55. How many books did Sam have at first?

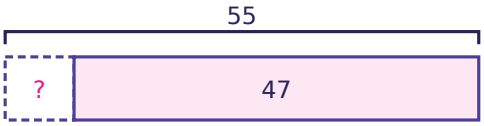

Tape Diagrams: Adding & Subtracting · 10

ANSWER

67

Tape Diagrams: Adding & Subtracting · 9

ANSWER

37

Tape Diagrams: Adding & Subtracting · 12

ANSWER

16

Tape Diagrams: Adding & Subtracting · 11

ANSWER

58

Tape Diagrams: Adding & Subtracting · 14

ANSWER

27

Tape Diagrams: Adding & Subtracting · 13

ANSWER

46

Tape Diagrams: Adding & Subtracting · 16

ANSWER

8

Tape Diagrams: Adding & Subtracting · 15

ANSWER

22

Max had some cards. Then Max got 13 more. Now Max has 80. How many cards did Max have at first?

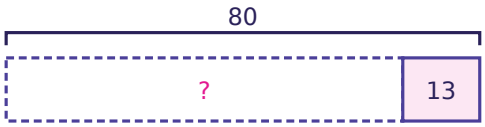

Zoe had some beads. Then Zoe got 34 more. Now Zoe has 48. How many beads did Zoe have at first?

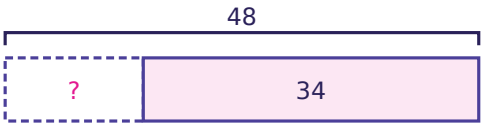

Nora has 34 cards. Mia has 9 more cards than Nora. How many cards does Mia have?

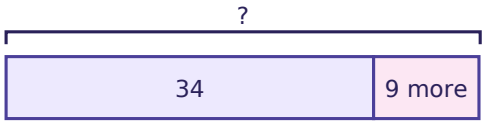

Zoe has 80 beads. 73 are red. The rest are blue. How many are blue?

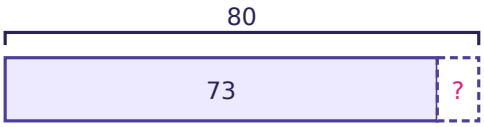

Ava has 85 books. 17 are picture. The rest are chapter. How many are chapter?



Sam had some shells. Then Sam got 25 more. Now Sam has 72. How many shells did Sam have at first?



Leo has 74 marbles. 9 are green. The rest are yellow. How many are yellow?



Leo had some marbles. Then Leo got 36 more. Now Leo has 52. How many marbles did Leo have at first?

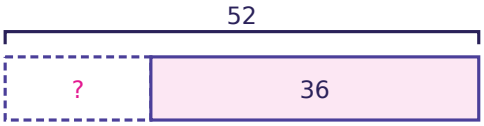

Tape Diagrams: Adding & Subtracting · 18

ANSWER

14

Tape Diagrams: Adding & Subtracting · 17

ANSWER

67

Tape Diagrams: Adding & Subtracting · 20

ANSWER

7

Tape Diagrams: Adding & Subtracting · 19

ANSWER

43

Tape Diagrams: Adding & Subtracting · 22

ANSWER

47

Tape Diagrams: Adding & Subtracting · 21

ANSWER

68

Tape Diagrams: Adding & Subtracting · 24

ANSWER

16

Tape Diagrams: Adding & Subtracting · 23

ANSWER

65