Task card 1 Summer Math

The bakery makes 386 blueberry muffins. It sells 112 of them. How many blueberry muffins are left?

Task card 2 Summer Math

Ella buys a paper lantern for 45¢ and a beach ball sticker for 20¢. How many cents does Ella spend?

Task card 3 Summer Math

Leo puts 2 cupcakes on each of 2 plates. How many cupcakes is that in all?



Task card 4 Summer Math

The school bakes 15 lemon bars and 77 blueberry muffins for the bake sale. How many treats is that in all?

Task card 5 Summer Math

Mia buys a beach ball sticker for 45¢ and a paper lantern for 30¢. How many cents does Mia spend?

Task card 6 Summer Math

The bakery makes 295 blueberry muffins. It sells 45 of them. How many blueberry muffins are left?

Task card 7 Summer Math

Ava puts 4 cupcakes on each of 3 plates. How many cupcakes is that in all?



Task card 8 Summer Math

The school bakes 67 cupcakes and 320 lemon bars for the bake sale. How many treats is that in all?

Task card 9 Summer Math

Mia puts 3 cupcakes on each of 3 plates. How many cupcakes is that in all?



Task card 10 Summer Math

The bakery makes 331 lemon bars. It sells 143 of them. How many lemon bars are left?

Task card 11 Summer Math

Sam buys a flag for 40¢ and a paper lantern for 35¢. How many cents does Sam spend?

Task card 12 Summer Math

The bakery makes 393 lemon bars. It sells 187 of them. How many lemon bars are left?

Task card 13 Summer Math

The school bakes 107 blueberry muffins and 349 cupcakes for the bake sale. How many treats is that in all?

Task card 14 Summer Math

The school bakes 248 lemon bars and 54 cupcakes for the bake sale. How many treats is that in all?

Task card 15 Summer Math

Mia buys a flag for 20¢ and a beach ball sticker for 25¢. How many cents does Mia spend?

Task card 16 Summer Math

Sam puts 4 cupcakes on each of 2 plates. How many cupcakes is that in all?



Task card 17 Summer Math

Ben buys a beach ball sticker for 40¢ and a flag for 50¢. How many cents does Ben spend?

Task card 18 Summer Math

The school bakes 134 cupcakes and 70 blueberry muffins for the bake sale. How many treats is that in all?

Task card 19 Summer Math

The school bakes 248 lemon bars and 215 cupcakes for the bake sale. How many treats is that in all?

Task card 20 Summer Math

The bakery makes 158 blueberry muffins. It sells 70 of them. How many blueberry muffins are left?

Task card 21 Summer Math

The bakery makes 174 blueberry muffins. It sells 44 of them. How many blueberry muffins are left?

Task card 22 Summer Math

Mia buys a paper lantern for 45¢ and a flag for 45¢. How many cents does Mia spend?

Task card 23 Summer Math

Lily puts 4 blueberry muffins on each of 4 plates. How many blueberry muffins is that in all?



Task card 24 Summer Math

Ava puts 2 blueberry muffins on each of 5 plates. How many blueberry muffins is that in all?



Summer Math Task Cards

Recording sheet · Grade 2 · Read each story and solve.

Name: _____ Date: _____

Scan to check your answers

1	2	3	4
5	6	7	8
9	10	11	12
13	14	15	16
17	18	19	20
21	22	23	24

Summer Math Task Cards: Answer Key

Grade 2 · Hard

The answers online

1. 274	**2.** 65	**3.** 4
4. 92	**5.** 75	**6.** 250
7. 12	**8.** 387	**9.** 9
10. 188	**11.** 75	**12.** 206
13. 456	**14.** 302	**15.** 45
16. 8	**17.** 90	**18.** 204
19. 463	**20.** 88	**21.** 130
22. 90	**23.** 16	**24.** 10