Task card 1 Summer Math

Noah puts 2 blueberry muffins on each of 2 plates. How many blueberry muffins is that in all?



Task card 2 Summer Math

Noah buys a paper lantern for 45¢ and a beach ball sticker for 20¢. How many cents does Noah spend?

Task card 3 Summer Math

Ben puts 5 lemon bars on each of 2 plates. How many lemon bars is that in all?



Task card 4 Summer Math

The bakery makes 56 cupcakes. It sells 41 of them. How many cupcakes are left?

Task card 5 Summer Math

The bakery makes 91 cupcakes. It sells 16 of them. How many cupcakes are left?

Task card 6 Summer Math

The school bakes 13 lemon bars and 43 cupcakes for the bake sale. How many treats is that in all?

Task card 7 Summer Math

Ava buys a beach ball sticker for 35¢ and a paper lantern for 25¢. How many cents does Ava spend?

Task card 8 Summer Math

The school bakes 36 blueberry muffins and 45 lemon bars for the bake sale. How many treats is that in all?

Task card 9 Summer Math

Omar puts 2 lemon bars on each of 3 plates. How many lemon bars is that in all?



Task card 10 Summer Math

Ben buys a beach ball sticker for 10¢ and a flag for 5¢. How many cents does Ben spend?

Task card 11 Summer Math

The school bakes 16 cupcakes and 43 blueberry muffins for the bake sale. How many treats is that in all?

Task card 12 Summer Math

The bakery makes 59 blueberry muffins. It sells 52 of them. How many blueberry muffins are left?

Task card 13 Summer Math

Mia buys a beach ball sticker for 25¢ and a paper lantern for 30¢. How many cents does Mia spend?

Task card 14 Summer Math

The bakery makes 43 cupcakes. It sells 36 of them. How many cupcakes are left?

Task card 15 Summer Math

Sam puts 2 blueberry muffins on each of 3 plates. How many blueberry muffins is that in all?



Task card 16 Summer Math

The school bakes 22 blueberry muffins and 75 cupcakes for the bake sale. How many treats is that in all?

Task card 17 Summer Math

The bakery makes 54 blueberry muffins. It sells 11 of them. How many blueberry muffins are left?

Task card 18 Summer Math

The school bakes 20 cupcakes and 27 lemon bars for the bake sale. How many treats is that in all?

Task card 19 Summer Math

Leo puts 4 blueberry muffins on each of 2 plates. How many blueberry muffins is that in all?



Task card 20 Summer Math

Mia buys a beach ball sticker for 45¢ and a paper lantern for 5¢. How many cents does Mia spend?

Task card 21 Summer Math

The bakery makes 46 blueberry muffins. It sells 16 of them. How many blueberry muffins are left?

Task card 22 Summer Math

The school bakes 49 blueberry muffins and 51 lemon bars for the bake sale. How many treats is that in all?

Task card 23 Summer Math

Lily puts 5 cupcakes on each of 3 plates. How many cupcakes is that in all?



Task card 24 Summer Math

Noah buys a flag for 20¢ and a beach ball sticker for 10¢. How many cents does Noah spend?

Summer Math Task Cards

Recording sheet · Grade 2 · Read each story and solve.

Name: _____ Date: _____

Scan to check your answers

1	2	3	4
5	6	7	8
9	10	11	12
13	14	15	16
17	18	19	20
21	22	23	24

Summer Math Task Cards: Answer Key

Grade 2 · Easy

The answers online

1. 4	**2.** 65	**3.** 10
4. 15	**5.** 75	**6.** 56
7. 60	**8.** 81	**9.** 6
10. 15	**11.** 59	**12.** 7
13. 55	**14.** 7	**15.** 6
16. 97	**17.** 43	**18.** 47
19. 8	**20.** 50	**21.** 30
22. 100	**23.** 15	**24.** 30