Summer Math · 1

The bakery makes 386 blueberry muffins. It sells 112 of them. How many blueberry muffins are left?

Summer Math · 2

Ella buys a paper lantern for 45¢ and a beach ball sticker for 20¢. How many cents does Ella spend?

Summer Math · 3

Leo puts 2 cupcakes on each of 2 plates. How many cupcakes is that in all?



Summer Math · 4

The school bakes 15 lemon bars and 77 blueberry muffins for the bake sale. How many treats is that in all?

Summer Math · 5

Mia buys a beach ball sticker for 45¢ and a paper lantern for 30¢. How many cents does Mia spend?

Summer Math · 6

The bakery makes 295 blueberry muffins. It sells 45 of them. How many blueberry muffins are left?

Summer Math · 7

Ava puts 4 cupcakes on each of 3 plates. How many cupcakes is that in all?



Summer Math · 8

The school bakes 67 cupcakes and 320 lemon bars for the bake sale. How many treats is that in all?

Summer Math · 2

ANSWER

65

Summer Math · 1

ANSWER

274

Summer Math · 4

ANSWER

92

Summer Math · 3

ANSWER

4

Summer Math · 6

ANSWER

250

Summer Math · 5

ANSWER

75

Summer Math · 8

ANSWER

387

Summer Math · 7

ANSWER

12

Summer Math · 9

Mia puts 3 cupcakes on each of 3 plates. How many cupcakes is that in all?



Summer Math · 10

The bakery makes 331 lemon bars. It sells 143 of them. How many lemon bars are left?

Summer Math · 11

Sam buys a flag for 40¢ and a paper lantern for 35¢. How many cents does Sam spend?

Summer Math · 12

The bakery makes 393 lemon bars. It sells 187 of them. How many lemon bars are left?

Summer Math · 13

The school bakes 107 blueberry muffins and 349 cupcakes for the bake sale. How many treats is that in all?

Summer Math · 14

The school bakes 248 lemon bars and 54 cupcakes for the bake sale. How many treats is that in all?

Summer Math · 15

Mia buys a flag for 20¢ and a beach ball sticker for 25¢. How many cents does Mia spend?

Summer Math · 16

Sam puts 4 cupcakes on each of 2 plates. How many cupcakes is that in all?



Summer Math · 10

ANSWER

188

Summer Math · 9

ANSWER

9

Summer Math · 12

ANSWER

206

Summer Math · 11

ANSWER

75

Summer Math · 14

ANSWER

302

Summer Math · 13

ANSWER

456

Summer Math · 16

ANSWER

8

Summer Math · 15

ANSWER

45

Summer Math · 17

Ben buys a beach ball sticker for 40¢ and a flag for 50¢. How many cents does Ben spend?

Summer Math · 18

The school bakes 134 cupcakes and 70 blueberry muffins for the bake sale. How many treats is that in all?

Summer Math · 19

The school bakes 248 lemon bars and 215 cupcakes for the bake sale. How many treats is that in all?

Summer Math · 20

The bakery makes 158 blueberry muffins. It sells 70 of them. How many blueberry muffins are left?

Summer Math · 21

The bakery makes 174 blueberry muffins. It sells 44 of them. How many blueberry muffins are left?

Summer Math · 22

Mia buys a paper lantern for 45¢ and a flag for 45¢. How many cents does Mia spend?

Summer Math · 23

Lily puts 4 blueberry muffins on each of 4 plates. How many blueberry muffins is that in all?



Summer Math · 24

Ava puts 2 blueberry muffins on each of 5 plates. How many blueberry muffins is that in all?



Summer Math · 18

ANSWER

204

Summer Math · 17

ANSWER

90

Summer Math · 20

ANSWER

88

Summer Math · 19

ANSWER

463

Summer Math · 22

ANSWER

90

Summer Math · 21

ANSWER

130

Summer Math · 24

ANSWER

10

Summer Math · 23

ANSWER

16