Summer Math · 1

The bakery makes 66 blueberry muffins. It sells 40 of them. How many blueberry muffins are left?

Summer Math · 2

Lily puts 4 lemon bars on each of 3 plates. How many lemon bars is that in all?



Summer Math · 3

The bakery makes 62 lemon bars. It sells 18 of them. How many lemon bars are left?

Summer Math · 4

Omar buys a paper lantern for 10¢ and a beach ball sticker for 20¢. How many cents does Omar spend?

Summer Math · 5

Noah buys a paper lantern for 35¢ and a flag for 35¢. How many cents does Noah spend?

Summer Math · 6

Ben puts 2 lemon bars on each of 2 plates. How many lemon bars is that in all?



Summer Math · 7

The school bakes 14 lemon bars and 47 blueberry muffins for the bake sale. How many treats is that in all?

Summer Math · 8

The school bakes 13 lemon bars and 40 blueberry muffins for the bake sale. How many treats is that in all?

Summer Math · 2

ANSWER

12

Summer Math · 1

ANSWER

26

Summer Math · 4

ANSWER

30

Summer Math · 3

ANSWER

44

Summer Math · 6

ANSWER

4

Summer Math · 5

ANSWER

70

Summer Math · 8

ANSWER

53

Summer Math · 7

ANSWER

61

Summer Math · 9

Noah buys a beach ball sticker for 30¢ and a flag for 35¢. How many cents does Noah spend?

Summer Math · 10

Mia puts 4 cupcakes on each of 2 plates. How many cupcakes is that in all?



Summer Math · 11

The bakery makes 40 lemon bars. It sells 22 of them. How many lemon bars are left?

Summer Math · 12

Leo buys a paper lantern for 30¢ and a beach ball sticker for 25¢. How many cents does Leo spend?

Summer Math · 13

Omar puts 2 lemon bars on each of 3 plates. How many lemon bars is that in all?



Summer Math · 14

The school bakes 75 cupcakes and 182 blueberry muffins for the bake sale. How many treats is that in all?

Summer Math · 15

The school bakes 140 lemon bars and 351 cupcakes for the bake sale. How many treats is that in all?

Summer Math · 16

The bakery makes 209 blueberry muffins. It sells 96 of them. How many blueberry muffins are left?

Summer Math · 10

ANSWER

8

Summer Math · 9

ANSWER

65

Summer Math · 12

ANSWER

55

Summer Math · 11

ANSWER

18

Summer Math · 14

ANSWER

257

Summer Math · 13

ANSWER

6

Summer Math · 16

ANSWER

113

Summer Math · 15

ANSWER

491

Summer Math · 17

Zoe buys a paper lantern for 25¢ and a flag for 45¢. How many cents does Zoe spend?

Summer Math · 18

Noah buys a flag for 10¢ and a beach ball sticker for 10¢. How many cents does Noah spend?

Summer Math · 19

The school bakes 210 cupcakes and 100 lemon bars for the bake sale. How many treats is that in all?

Summer Math · 20

The school bakes 154 cupcakes and 66 blueberry muffins for the bake sale. How many treats is that in all?

Summer Math · 21

Leo puts 4 lemon bars on each of 3 plates. How many lemon bars is that in all?



Summer Math · 22

The bakery makes 225 lemon bars. It sells 37 of them. How many lemon bars are left?

Summer Math · 23

The bakery makes 479 blueberry muffins. It sells 367 of them. How many blueberry muffins are left?

Summer Math · 24

Lily puts 3 blueberry muffins on each of 5 plates. How many blueberry muffins is that in all?



Summer Math · 18

ANSWER

20

Summer Math · 17

ANSWER

70

Summer Math · 20

ANSWER

220

Summer Math · 19

ANSWER

310

Summer Math · 22

ANSWER

188

Summer Math · 21

ANSWER

12

Summer Math · 24

ANSWER

15

Summer Math · 23

ANSWER

112