Summer Math · 1

Noah puts 2 blueberry muffins on each of 2 plates. How many blueberry muffins is that in all?



Summer Math · 2

Noah buys a paper lantern for 45¢ and a beach ball sticker for 20¢. How many cents does Noah spend?

Summer Math · 3

Ben puts 5 lemon bars on each of 2 plates. How many lemon bars is that in all?



Summer Math · 4

The bakery makes 56 cupcakes. It sells 41 of them. How many cupcakes are left?

Summer Math · 5

The bakery makes 91 cupcakes. It sells 16 of them. How many cupcakes are left?

Summer Math · 6

The school bakes 13 lemon bars and 43 cupcakes for the bake sale. How many treats is that in all?

Summer Math · 7

Ava buys a beach ball sticker for 35¢ and a paper lantern for 25¢. How many cents does Ava spend?

Summer Math · 8

The school bakes 36 blueberry muffins and 45 lemon bars for the bake sale. How many treats is that in all?

Summer Math · 2

ANSWER

65

Summer Math · 1

ANSWER

4

Summer Math · 4

ANSWER

15

Summer Math · 3

ANSWER

10

Summer Math · 6

ANSWER

56

Summer Math · 5

ANSWER

75

Summer Math · 8

ANSWER

81

Summer Math · 7

ANSWER

60

Summer Math · 9

Omar puts 2 lemon bars on each of 3 plates. How many lemon bars is that in all?



Summer Math · 10

Ben buys a beach ball sticker for 10¢ and a flag for 5¢. How many cents does Ben spend?

Summer Math · 11

The school bakes 16 cupcakes and 43 blueberry muffins for the bake sale. How many treats is that in all?

Summer Math · 12

The bakery makes 59 blueberry muffins. It sells 52 of them. How many blueberry muffins are left?

Summer Math · 13

Mia buys a beach ball sticker for 25¢ and a paper lantern for 30¢. How many cents does Mia spend?

Summer Math · 14

The bakery makes 43 cupcakes. It sells 36 of them. How many cupcakes are left?

Summer Math · 15

Sam puts 2 blueberry muffins on each of 3 plates. How many blueberry muffins is that in all?



Summer Math · 16

The school bakes 22 blueberry muffins and 75 cupcakes for the bake sale. How many treats is that in all?

Summer Math · 10

ANSWER

15

Summer Math · 9

ANSWER

6

Summer Math · 12

ANSWER

7

Summer Math · 11

ANSWER

59

Summer Math · 14

ANSWER

7

Summer Math · 13

ANSWER

55

Summer Math · 16

ANSWER

97

Summer Math · 15

ANSWER

6

Summer Math · 17

The bakery makes 54 blueberry muffins. It sells 11 of them. How many blueberry muffins are left?

Summer Math · 18

The school bakes 20 cupcakes and 27 lemon bars for the bake sale. How many treats is that in all?

Summer Math · 19

Leo puts 4 blueberry muffins on each of 2 plates. How many blueberry muffins is that in all?



Summer Math · 20

Mia buys a beach ball sticker for 45¢ and a paper lantern for 5¢. How many cents does Mia spend?

Summer Math · 21

The bakery makes 46 blueberry muffins. It sells 16 of them. How many blueberry muffins are left?

Summer Math · 22

The school bakes 49 blueberry muffins and 51 lemon bars for the bake sale. How many treats is that in all?

Summer Math · 23

Lily puts 5 cupcakes on each of 3 plates. How many cupcakes is that in all?



Summer Math · 24

Noah buys a flag for 20¢ and a beach ball sticker for 10¢. How many cents does Noah spend?

Summer Math · 18

ANSWER

47

Summer Math · 17

ANSWER

43

Summer Math · 20

ANSWER

50

Summer Math · 19

ANSWER

8

Summer Math · 22

ANSWER

100

Summer Math · 21

ANSWER

30

Summer Math · 24

ANSWER

30

Summer Math · 23

ANSWER

15