Task card 1 Subtraction with Regrouping

$56 - 45 = ___$

Task card 2 Subtraction with Regrouping

$41 - 34 = ___$

Task card 3 Subtraction with Regrouping

Subtract.

$$\begin{array}{r} 11 \\ ?\ 10 \\ \hline \end{array}$$

Task card 4 Subtraction with Regrouping

The blocks show 20. Take away 16. How many are left?



Task card 5 Subtraction with Regrouping

The two parts make the whole. What is the missing number?

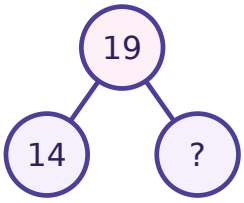

Task card 6 Subtraction with Regrouping

Take away the tens, then the ones: $42 - 20 = 22$, then take away 6 more.

$42 - 26 = ___$

Task card 7 Subtraction with Regrouping

Think: 21 + ? = 60. So 60 − 21 = ___

Task card 8 Subtraction with Regrouping

25 − ___ = 11

Task card 9 Subtraction with Regrouping

Sam has 31 crayons and gives away 16. How many crayons does Sam have left?

Task card 10 Subtraction with Regrouping

59 − 48 = 56 − ___

Task card 11 Subtraction with Regrouping

51 − 44 = ___

Task card 12 Subtraction with Regrouping

50 − 46 = ___

Task card 13 Subtraction with Regrouping

Subtract.

$$\begin{array}{r} 44 \\ -\ ?\ \ 12 \\ \hline \end{array}$$

Task card 14 Subtraction with Regrouping

The blocks show 67. Take away 54. How many are left?

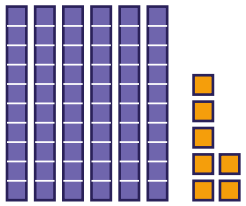

Task card 15 Subtraction with Regrouping

The two parts make the whole. What is the missing number?

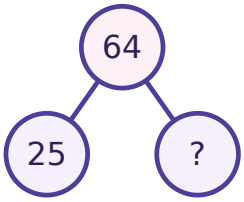

Task card 16 Subtraction with Regrouping

Take away the tens, then the ones: 14 − 10 = 4, then take away 1 more.

14 − 11 = ___

Task card 17 Subtraction with Regrouping

Think: 45 + ? = 53. So 53 − 45 = ___

Task card 18 Subtraction with Regrouping

17 − ___ = 3

Task card 19 Subtraction with Regrouping

Ben has 22 cards and gives away 12. How many cards does Ben have left?

Task card 20 Subtraction with Regrouping

$39 - 37 = 37 - ___$

Task card 21 Subtraction with Regrouping

$51 - 40 = ___$

Task card 22 Subtraction with Regrouping

$55 - 37 = ___$

Task card 23 Subtraction with Regrouping

Subtract.

$$\begin{array}{r} 47 \\ ?\ \ 47 \\ \hline \end{array}$$

Task card 24 Subtraction with Regrouping

The blocks show 17. Take away 12. How many are left?



Subtraction with Regrouping Task Cards

Recording sheet · Grade 2 · Answer each question. The same facts come in different shapes!

Name: _____ Date: _____

Scan to check your answers

1	2	3	4
5	6	7	8
9	10	11	12
13	14	15	16
17	18	19	20
21	22	23	24

Subtraction with Regrouping Task Cards: Answer Key

Grade 2 · Medium

The answers online

1. 11	**2.** 7	**3.** 1
4. 4	**5.** 5	**6.** 16
7. 39	**8.** 14	**9.** 15
10. 45	**11.** 7	**12.** 4
13. 32	**14.** 13	**15.** 39
16. 3	**17.** 8	**18.** 14
19. 10	**20.** 35	**21.** 11
22. 18	**23.** 0	**24.** 5