Subtraction with Regrouping · 1

$56 - 45 = ___$

Subtraction with Regrouping · 2

$41 - 34 = ___$

Subtraction with Regrouping · 3

Subtract.

$$\begin{array}{r} 11 \\ ?\ 10 \\ \hline \end{array}$$

Subtraction with Regrouping · 4

The blocks show 20. Take away 16. How many are left?



Subtraction with Regrouping · 5

The two parts make the whole. What is the missing number?

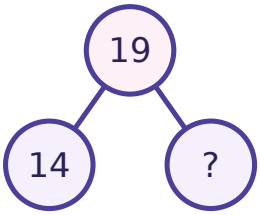

Subtraction with Regrouping · 6

Take away the tens, then the ones: 42 − 20 = 22, then take away 6 more. 42 − 26 = ___

Subtraction with Regrouping · 7

Think: 21 + ? = 60. So 60 − 21 = ___

Subtraction with Regrouping · 8

$25 - ___ = 11$

Subtraction with Regrouping · 2

ANSWER

7

Subtraction with Regrouping · 1

ANSWER

11

Subtraction with Regrouping · 4

ANSWER

4

Subtraction with Regrouping · 3

ANSWER

1

Subtraction with Regrouping · 6

ANSWER

16

Subtraction with Regrouping · 5

ANSWER

5

Subtraction with Regrouping · 8

ANSWER

14

Subtraction with Regrouping · 7

ANSWER

39

Subtraction with Regrouping · 9

Sam has 31 crayons and gives away 16. How many crayons does Sam have left?

Subtraction with Regrouping · 10

$59 - 48 = 56 - ___$

Subtraction with Regrouping · 11

$51 - 44 = ___$

Subtraction with Regrouping · 12

$50 - 46 = ___$

Subtraction with Regrouping · 13

Subtract.

$$\begin{array}{r} 44 \\ -\ ?\ 12 \\ \hline \end{array}$$

Subtraction with Regrouping · 14

The blocks show 67. Take away 54. How many are left?

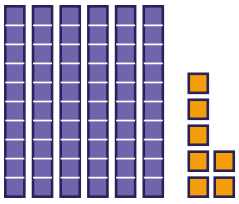

Subtraction with Regrouping · 15

The two parts make the whole. What is the missing number?

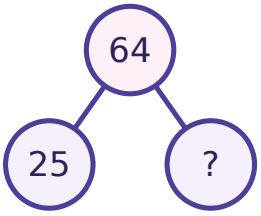

Subtraction with Regrouping · 16

Take away the tens, then the ones: 14 − 10 = 4, then take away 1 more. 14 − 11 = ___

Subtraction with Regrouping · 10

ANSWER

45

Subtraction with Regrouping · 9

ANSWER

15

Subtraction with Regrouping · 12

ANSWER

4

Subtraction with Regrouping · 11

ANSWER

7

Subtraction with Regrouping · 14

ANSWER

13

Subtraction with Regrouping · 13

ANSWER

32

Subtraction with Regrouping · 16

ANSWER

3

Subtraction with Regrouping · 15

ANSWER

39

Think: 45 + ? = 53. So 53 − 45 = ___

17 − ___ = 3

Ben has 22 cards and gives away 12. How many cards does Ben have left?

39 − 37 = 37 − ___

51 − 40 = ___

55 − 37 = ___

Subtract.

$$\begin{array}{r} 47 \\ -\ ?\ \ 47 \\ \hline \end{array}$$

The blocks show 17. Take away 12. How many are left?

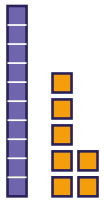

Subtraction with Regrouping · 18

ANSWER

14

Subtraction with Regrouping · 17

ANSWER

8

Subtraction with Regrouping · 20

ANSWER

35

Subtraction with Regrouping · 19

ANSWER

10

Subtraction with Regrouping · 22

ANSWER

18

Subtraction with Regrouping · 21

ANSWER

11

Subtraction with Regrouping · 24

ANSWER

5

Subtraction with Regrouping · 23

ANSWER

0