Subtraction with Regrouping · 1

$87 - 66 = ___$

Subtraction with Regrouping · 2

$42 - 29 = ___$

Subtraction with Regrouping · 3

Subtract.

$$\begin{array}{r} 89 \\ -\ 52 \\ \hline \end{array}$$

Subtraction with Regrouping · 4

The blocks show 52. Take away 37. How many are left?

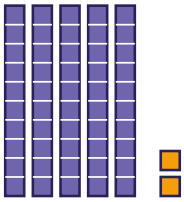

Subtraction with Regrouping · 5

The two parts make the whole. What is the missing number?

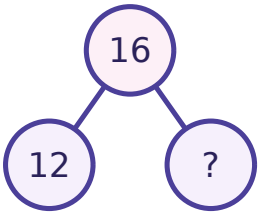

Subtraction with Regrouping · 6

Take away the tens, then the ones: 88 − 20 = 68, then take away 7 more. 88 − 27 = ___

Subtraction with Regrouping · 7

Think: 39 + ? = 77. So 77 − 39 = ___

Subtraction with Regrouping · 8

$77 - ___ = 20$

Subtraction with Regrouping · 2

ANSWER

13

Subtraction with Regrouping · 1

ANSWER

21

Subtraction with Regrouping · 4

ANSWER

15

Subtraction with Regrouping · 3

ANSWER

37

Subtraction with Regrouping · 6

ANSWER

61

Subtraction with Regrouping · 5

ANSWER

4

Subtraction with Regrouping · 8

ANSWER

57

Subtraction with Regrouping · 7

ANSWER

38

Subtraction with Regrouping · 9

Leo has 90 cards and gives away 29. How many cards does Leo have left?

Subtraction with Regrouping · 10

$60 - 29 = 58 - ___$

Subtraction with Regrouping · 11

$53 - 10 = ___$

Subtraction with Regrouping · 12

$92 - 51 = ___$

Subtraction with Regrouping · 13

Subtract.

$$\begin{array}{r} 99 \\ -\ ?\ 15 \\ \hline \end{array}$$

Subtraction with Regrouping · 14

The blocks show 49. Take away 41. How many are left?

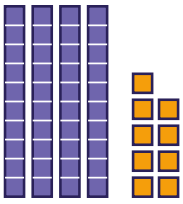

Subtraction with Regrouping · 15

The two parts make the whole. What is the missing number?

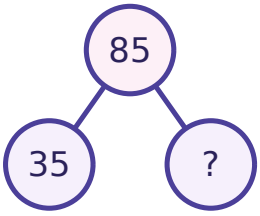

Subtraction with Regrouping · 16

Take away the tens, then the ones: 35 − 10 = 25, then take away 9 more. 35 − 19 = ___

Subtraction with Regrouping · 10

ANSWER

27

Subtraction with Regrouping · 9

ANSWER

61

Subtraction with Regrouping · 12

ANSWER

41

Subtraction with Regrouping · 11

ANSWER

43

Subtraction with Regrouping · 14

ANSWER

8

Subtraction with Regrouping · 13

ANSWER

84

Subtraction with Regrouping · 16

ANSWER

16

Subtraction with Regrouping · 15

ANSWER

50

Subtraction with Regrouping · 17

Think: 10 + ? = 53. So 53 − 10 = ___

Subtraction with Regrouping · 18

84 − ___ = 44

Subtraction with Regrouping · 19

Max has 48 cards and gives away 35. How many cards does Max have left?

Subtraction with Regrouping · 20

16 − 14 = 14 − ___

Subtraction with Regrouping · 21

15 − 13 = ___

Subtraction with Regrouping · 22

78 − 69 = ___

Subtraction with Regrouping · 23

Subtract.

$$\begin{array}{r} 11 \\ -\ ?\ \ 11 \\ \hline \end{array}$$

Subtraction with Regrouping · 24

The blocks show 63. Take away 45. How many are left?

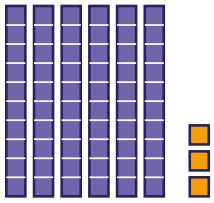

Subtraction with Regrouping · 18

ANSWER

40

Subtraction with Regrouping · 17

ANSWER

43

Subtraction with Regrouping · 20

ANSWER

12

Subtraction with Regrouping · 19

ANSWER

13

Subtraction with Regrouping · 22

ANSWER

9

Subtraction with Regrouping · 21

ANSWER

2

Subtraction with Regrouping · 24

ANSWER

18

Subtraction with Regrouping · 23

ANSWER

0