Subtraction with Regrouping · 1

$27 - 21 = ___$

Subtraction with Regrouping · 2

$25 - 13 = ___$

Subtraction with Regrouping · 3

Subtract.

$$\begin{array}{r} 25 \\ ?\ \ 25 \\ \hline \end{array}$$

Subtraction with Regrouping · 4

The blocks show 14. Take away 12. How many are left?



Subtraction with Regrouping · 5

The two parts make the whole. What is the missing number?

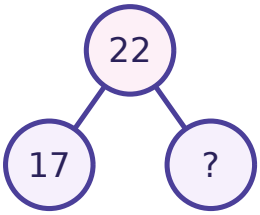

Subtraction with Regrouping · 6

Take away the tens, then the ones: $20 - 10 = 10$, then take away 8 more. $20 - 18 = ___$

Subtraction with Regrouping · 7

Think: $13 + ? = 18$. So $18 - 13 = ___$

Subtraction with Regrouping · 8

$24 - ___ = 2$

Subtraction with Regrouping · 2

ANSWER

12

Subtraction with Regrouping · 1

ANSWER

6

Subtraction with Regrouping · 4

ANSWER

2

Subtraction with Regrouping · 3

ANSWER

0

Subtraction with Regrouping · 6

ANSWER

2

Subtraction with Regrouping · 5

ANSWER

5

Subtraction with Regrouping · 8

ANSWER

22

Subtraction with Regrouping · 7

ANSWER

5

Ben has 13 stickers and gives away 11. How many stickers does Ben have left?

$22 - 13 = 20 - ___$

$29 - 26 = ___$

$15 - 10 = ___$

Subtract.

$$\begin{array}{r} 14 \\ ?\ 10 \\ \hline \end{array}$$

The two parts make the whole. What is the missing number?

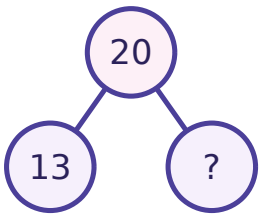

Take away the tens, then the ones: $18 - 10 = 8$, then take away 4 more. $18 - 14 = ___$

Think: $32 + ? = 33$. So $33 - 32 = ___$

Subtraction with Regrouping · 10

ANSWER

11

Subtraction with Regrouping · 9

ANSWER

2

Subtraction with Regrouping · 12

ANSWER

5

Subtraction with Regrouping · 11

ANSWER

3

Subtraction with Regrouping · 14

ANSWER

7

Subtraction with Regrouping · 13

ANSWER

4

Subtraction with Regrouping · 16

ANSWER

1

Subtraction with Regrouping · 15

ANSWER

4

Subtraction with Regrouping · 17

$27 - ___ = 16$

Subtraction with Regrouping · 18

Zoe has 37 marbles and gives away 28. How many marbles does Zoe have left?

Subtraction with Regrouping · 19

$20 - 10 = 18 - ___$

Subtraction with Regrouping · 20

$46 - 45 = ___$

Subtraction with Regrouping · 21

$49 - 11 = ___$

Subtraction with Regrouping · 22

Subtract.

$$\begin{array}{r} 34 \\ ?\ \ 17 \\ \hline \end{array}$$

Subtraction with Regrouping · 23

The blocks show 28. Take away 11. How many are left?

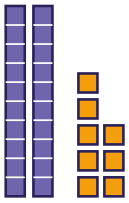

Subtraction with Regrouping · 24

The two parts make the whole. What is the missing number?

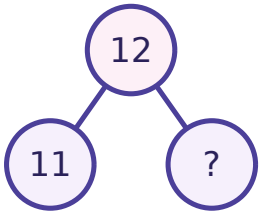

Subtraction with Regrouping · 18

ANSWER

9

Subtraction with Regrouping · 17

ANSWER

11

Subtraction with Regrouping · 20

ANSWER

1

Subtraction with Regrouping · 19

ANSWER

8

Subtraction with Regrouping · 22

ANSWER

17

Subtraction with Regrouping · 21

ANSWER

38

Subtraction with Regrouping · 24

ANSWER

1

Subtraction with Regrouping · 23

ANSWER

17