Task card 1 Subtracting Two-Digit Numbers (No...

Subtract.

$$\begin{array}{r} 22 \\ -\ 10 \\ \hline \end{array}$$

Task card 2 Subtracting Two-Digit Numbers (No...

Subtract.

$$\begin{array}{r} 64 \\ -\ 23 \\ \hline \end{array}$$

Task card 3 Subtracting Two-Digit Numbers (No...

$29 - 19 = ___$

Task card 4 Subtracting Two-Digit Numbers (No...

The blocks show 58. Take away 47. How many are left?

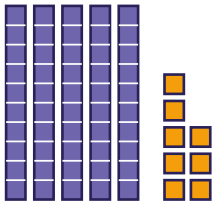

Task card 5 Subtracting Two-Digit Numbers (No...

Take away the tens, then the ones: 45 − 10 = 35, then take away 1 more.

45 − 11 = ___

Task card 6 Subtracting Two-Digit Numbers (No...

$39 - ___ = 18$

Task card 7 Subtracting Two-Digit Numbers (No...

Ben has 23 cards and gives away 13. How many cards does Ben have left?

Task card 8 Subtracting Two-Digit Numbers (No...

$26 - 15 = 25 - ___$

Task card 9 Subtracting Two-Digit Numbers (No...

Subtract.

$$\begin{array}{r} 44 \\ ?\ 11 \\ \hline \end{array}$$

Task card 10 Subtracting Two-Digit Numbers (No...

Subtract.

$$\begin{array}{r} 87 \\ ?\ 16 \\ \hline \end{array}$$

Task card 11 Subtracting Two-Digit Numbers (No...

$84 - 50 = ___$

Task card 12 Subtracting Two-Digit Numbers (No...

The blocks show 27. Take away 17. How many are left?

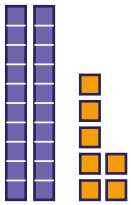

Task card 13 Subtracting Two-Digit Numbers (No...

Take away the tens, then the ones: 37 − 20 = 17, then take away 2 more.

37 − 22 = ___

Task card 14 Subtracting Two-Digit Numbers (No...

82 − ___ = 52

Task card 15 Subtracting Two-Digit Numbers (No...

Leo has 65 cards and gives away 13. How many cards does Leo have left?

Task card 16 Subtracting Two-Digit Numbers (No...

78 − 11 = 76 − ___

Task card 17 Subtracting Two-Digit Numbers (No...

Subtract.

```
  88
? 10
----
```

Task card 18 Subtracting Two-Digit Numbers (No...

Subtract.

```
  68
? 61
----
```

Task card 19 Subtracting Two-Digit Numbers (No...

$67 - 12 = ___$

Task card 20 Subtracting Two-Digit Numbers (No...

The blocks show 98. Take away 67. How many are left?



Task card 21 Subtracting Two-Digit Numbers (No...

Take away the tens, then the ones: $69 - 50 = 19$, then take away 6 more.

$69 - 56 = ___$

Task card 22 Subtracting Two-Digit Numbers (No...

$95 - ___ = 33$

Task card 23 Subtracting Two-Digit Numbers (No...

Ava has 87 shells and gives away 63. How many shells does Ava have left?

Task card 24 Subtracting Two-Digit Numbers (No...

$97 - 32 = 95 - ___$

Subtracting Two-Digit Numbers (No Regrouping) Task Cards

Recording sheet · Grade 2 · Subtract the ones, then subtract the tens. The same kind of sum comes in different shapes.

Scan to check your answers

Name: _____ Date: _____

1	2	3	4
5	6	7	8
9	10	11	12
13	14	15	16
17	18	19	20
21	22	23	24

Subtracting Two-Digit Numbers (No Regrouping) Task Cards: Answer Key

Grade 2 · Medium

The answers online

1. 12	**2.** 41	**3.** 10
4. 11	**5.** 34	**6.** 21
7. 10	**8.** 14	**9.** 33
10. 71	**11.** 34	**12.** 10
13. 15	**14.** 30	**15.** 52
16. 9	**17.** 78	**18.** 7
19. 55	**20.** 31	**21.** 13
22. 62	**23.** 24	**24.** 30