Task card 1 Subtracting Two-Digit Numbers (No...

Subtract.

$$\begin{array}{r} 38 \\ ? \ 28 \\ \hline \end{array}$$

Task card 2 Subtracting Two-Digit Numbers (No...

Subtract.

$$\begin{array}{r} 82 \\ ? \ 31 \\ \hline \end{array}$$

Task card 3 Subtracting Two-Digit Numbers (No...

$44 - 21 = ___$

Task card 4 Subtracting Two-Digit Numbers (No...

The blocks show 57. Take away 56. How many are left?

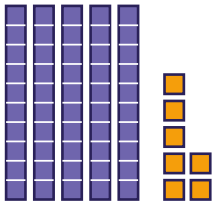

Task card 5 Subtracting Two-Digit Numbers (No...

Take away the tens, then the ones: 76 − 10 = 66, then take away 1 more.

76 − 11 = ___

Task card 6 Subtracting Two-Digit Numbers (No...

$75 - ___ = 11$

Task card 7 Subtracting Two-Digit Numbers (No...

Mia has 29 crayons and gives away 10. How many crayons does Mia have left?

Task card 8 Subtracting Two-Digit Numbers (No...

$99 - 70 = 96 - ___$

Task card 9 Subtracting Two-Digit Numbers (No...

Subtract.

$$\begin{array}{r} 94 \\ ?\ 33 \\ \hline \end{array}$$

Task card 10 Subtracting Two-Digit Numbers (No...

Subtract.

$$\begin{array}{r} 38 \\ ?\ 18 \\ \hline \end{array}$$

Task card 11 Subtracting Two-Digit Numbers (No...

$59 - 28 = ___$

Task card 12 Subtracting Two-Digit Numbers (No...

The blocks show 33. Take away 31. How many are left?

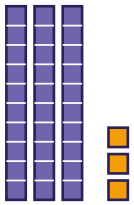

Task card 13 Subtracting Two-Digit Numbers (No...

Take away the tens, then the ones: 24 − 20 = 4, then take away 2 more.

24 − 22 = ___

Task card 14 Subtracting Two-Digit Numbers (No...

64 − ___ = 14

Task card 15 Subtracting Two-Digit Numbers (No...

Sam has 47 toy cars and gives away 20. How many toy cars does Sam have left?

Task card 16 Subtracting Two-Digit Numbers (No...

56 − 46 = 53 − ___

Task card 17 Subtracting Two-Digit Numbers (No...

Subtract.

```
  52
? 11
----
```

Task card 18 Subtracting Two-Digit Numbers (No...

Subtract.

```
  65
? 11
----
```

Task card 19 Subtracting Two-Digit Numbers (No...

$79 - 43 = ___$

Task card 20 Subtracting Two-Digit Numbers (No...

The blocks show 27. Take away 13. How many are left?

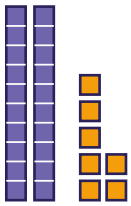

Task card 21 Subtracting Two-Digit Numbers (No...

Take away the tens, then the ones: $86 - 60 = 26$, then take away 5 more.

$86 - 65 = ___$

Task card 22 Subtracting Two-Digit Numbers (No...

$45 - ___ = 3$

Task card 23 Subtracting Two-Digit Numbers (No...

Ava has 62 shells and gives away 52. How many shells does Ava have left?

Task card 24 Subtracting Two-Digit Numbers (No...

$44 - 41 = 41 - ___$

Subtracting Two-Digit Numbers (No Regrouping) Task Cards

Recording sheet · Grade 2 · Subtract the ones, then subtract the tens. The same kind of sum comes in different shapes.

Scan to check your answers

Name: _____ Date: _____

1	2	3	4
5	6	7	8
9	10	11	12
13	14	15	16
17	18	19	20
21	22	23	24

Subtracting Two-Digit Numbers (No Regrouping) Task Cards: Answer Key

Grade 2 · Hard

The answers online

1. 10	**2.** 51	**3.** 23
4. 1	**5.** 65	**6.** 64
7. 19	**8.** 67	**9.** 61
10. 20	**11.** 31	**12.** 2
13. 2	**14.** 50	**15.** 27
16. 43	**17.** 41	**18.** 54
19. 36	**20.** 14	**21.** 21
22. 42	**23.** 10	**24.** 38