Task card 1 Subtracting Two-Digit Numbers (No...

Subtract.

$$\begin{array}{r} 42 \\ -\ ?\ \ 2 \\ \hline \end{array}$$

Task card 2 Subtracting Two-Digit Numbers (No...

Subtract.

$$\begin{array}{r} 35 \\ -\ ?\ \ 5 \\ \hline \end{array}$$

Task card 3 Subtracting Two-Digit Numbers (No...

$39 - 8 = ___$

Task card 4 Subtracting Two-Digit Numbers (No...

The blocks show 26. Take away 3. How many are left?

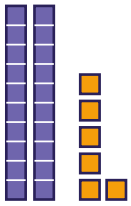

Task card 5 Subtracting Two-Digit Numbers (No...

Think: $4 + ? =$ 76. So $76 - 4 =$ ___

Task card 6 Subtracting Two-Digit Numbers (No...

$45 - ___ = 40$

Task card 7 Subtracting Two-Digit Numbers (No...

Leo has 95 shells and gives away 1. How many shells does Leo have left?

Task card 8 Subtracting Two-Digit Numbers (No...

$94 - 2 = 93 - ___$

Task card 9 Subtracting Two-Digit Numbers (No...

Subtract.

$$\begin{array}{r} 25 \\ -\ 1 \\ \hline \end{array}$$

Task card 10 Subtracting Two-Digit Numbers (No...

Subtract.

$$\begin{array}{r} 24 \\ -\ 3 \\ \hline \end{array}$$

Task card 11 Subtracting Two-Digit Numbers (No...

$96 - 1 = ___$

Task card 12 Subtracting Two-Digit Numbers (No...

The blocks show 28. Take away 1. How many are left?

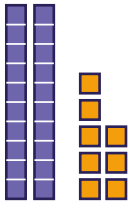

Task card 13 Subtracting Two-Digit Numbers (No...

Think: 7 + ? = 28. So 28 − 7 = ___

Task card 14 Subtracting Two-Digit Numbers (No...

88 − ___ = 81

Task card 15 Subtracting Two-Digit Numbers (No...

Mia has 78 cards and gives away 8. How many cards does Mia have left?

Task card 16 Subtracting Two-Digit Numbers (No...

27 − 3 = 25 − ___

Task card 17 Subtracting Two-Digit Numbers (No...

Subtract.

$$\begin{array}{r} 85 \\ -\ ?\ 10 \\ \hline \end{array}$$

Task card 18 Subtracting Two-Digit Numbers (No...

Subtract.

$$\begin{array}{r} 49 \\ -\ ?\ 30 \\ \hline \end{array}$$

Task card 19 Subtracting Two-Digit Numbers (No...

$69 - 32 = ___$

Task card 20 Subtracting Two-Digit Numbers (No...

The blocks show 69. Take away 10. How many are left?

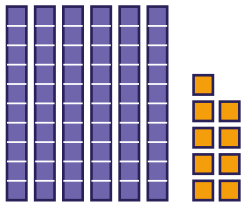

Task card 21 Subtracting Two-Digit Numbers (No...

Think: $18 + ? = 98$. So $98 - 18 = ___$

Task card 22 Subtracting Two-Digit Numbers (No...

$98 - ___ = 63$

Task card 23 Subtracting Two-Digit Numbers (No...

Lily has 56 toy cars and gives away 30. How many toy cars does Lily have left?

Task card 24 Subtracting Two-Digit Numbers (No...

$82 - 32 = 79 - ___$

Subtracting Two-Digit Numbers (No Regrouping) Task Cards

Recording sheet · Grade 2 · Subtract the ones, then subtract the tens. The same kind of sum comes in different shapes.

Scan to check your answers

Name: _____ Date: _____

1	2	3	4
5	6	7	8
9	10	11	12
13	14	15	16
17	18	19	20
21	22	23	24

Subtracting Two-Digit Numbers (No Regrouping) Task Cards: Answer Key

Grade 2 · Easy

The answers online

1. 40	**2.** 30	**3.** 31
4. 23	**5.** 72	**6.** 5
7. 94	**8.** 1	**9.** 24
10. 21	**11.** 95	**12.** 27
13. 21	**14.** 7	**15.** 70
16. 1	**17.** 75	**18.** 19
19. 37	**20.** 59	**21.** 80
22. 35	**23.** 26	**24.** 29