Subtracting Two-Digit Numbers (No Regrouping) · 1

Subtract.

$$\begin{array}{r} 38 \\ -\ 28 \\ \hline \end{array}$$

Subtracting Two-Digit Numbers (No Regrouping) · 2

Subtract.

$$\begin{array}{r} 82 \\ -\ 31 \\ \hline \end{array}$$

Subtracting Two-Digit Numbers (No Regrouping) · 3

$44 - 21 = ___$

Subtracting Two-Digit Numbers (No Regrouping) · 4

The blocks show 57. Take away 56. How many are left?

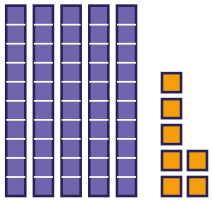

Subtracting Two-Digit Numbers (No Regrouping) · 5

Take away the tens, then the ones: 76 − 10 = 66, then take away 1 more. 76 − 11 = ___

Subtracting Two-Digit Numbers (No Regrouping) · 6

$75 - ___ = 11$

Subtracting Two-Digit Numbers (No Regrouping) · 7

Mia has 29 crayons and gives away 10. How many crayons does Mia have left?

Subtracting Two-Digit Numbers (No Regrouping) · 8

$99 - 70 = 96 - ___$

Subtracting Two-Digit Numbers (No Regrouping) · 2

ANSWER

51

Subtracting Two-Digit Numbers (No Regrouping) · 1

ANSWER

10

Subtracting Two-Digit Numbers (No Regrouping) · 4

ANSWER

1

Subtracting Two-Digit Numbers (No Regrouping) · 3

ANSWER

23

Subtracting Two-Digit Numbers (No Regrouping) · 6

ANSWER

64

Subtracting Two-Digit Numbers (No Regrouping) · 5

ANSWER

65

Subtracting Two-Digit Numbers (No Regrouping) · 8

ANSWER

67

Subtracting Two-Digit Numbers (No Regrouping) · 7

ANSWER

19

Subtract.

$$\begin{array}{r} 94 \\ -\ 33 \\ \hline \end{array}$$

Subtract.

$$\begin{array}{r} 38 \\ -\ 18 \\ \hline \end{array}$$

$59 - 28 = ___$

The blocks show 33. Take away 31. How many are left?

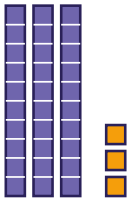

Take away the tens, then the ones: 24 − 20 = 4, then take away 2 more. 24 − 22 = ___

$64 - ___ = 14$

Sam has 47 toy cars and gives away 20. How many toy cars does Sam have left?

$56 - 46 = 53 - ___$

Subtracting Two-Digit Numbers (No Regrouping) · 10

ANSWER

20

Subtracting Two-Digit Numbers (No Regrouping) · 9

ANSWER

61

Subtracting Two-Digit Numbers (No Regrouping) · 12

ANSWER

2

Subtracting Two-Digit Numbers (No Regrouping) · 11

ANSWER

31

Subtracting Two-Digit Numbers (No Regrouping) · 14

ANSWER

50

Subtracting Two-Digit Numbers (No Regrouping) · 13

ANSWER

2

Subtracting Two-Digit Numbers (No Regrouping) · 16

ANSWER

43

Subtracting Two-Digit Numbers (No Regrouping) · 15

ANSWER

27

Subtract.

$$\begin{array}{r} 52 \\ ?\ 11 \\ \hline \end{array}$$

Subtract.

$$\begin{array}{r} 65 \\ ?\ 11 \\ \hline \end{array}$$

$$79 - 43 = ___$$

The blocks show 27. Take away 13. How many are left?

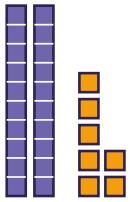

Take away the tens, then the ones: 86 − 60 = 26, then take away 5 more. 86 − 65 = ___

$$45 - ___ = 3$$

Ava has 62 shells and gives away 52. How many shells does Ava have left?

$$44 - 41 = 41 - ___$$

Subtracting Two-Digit Numbers (No Regrouping) · 18

ANSWER

54

Subtracting Two-Digit Numbers (No Regrouping) · 17

ANSWER

41

Subtracting Two-Digit Numbers (No Regrouping) · 20

ANSWER

14

Subtracting Two-Digit Numbers (No Regrouping) · 19

ANSWER

36

Subtracting Two-Digit Numbers (No Regrouping) · 22

ANSWER

42

Subtracting Two-Digit Numbers (No Regrouping) · 21

ANSWER

21

Subtracting Two-Digit Numbers (No Regrouping) · 24

ANSWER

38

Subtracting Two-Digit Numbers (No Regrouping) · 23

ANSWER

10