Subtracting Two-Digit Numbers (No Regrouping) · 1

Subtract.

$$\begin{array}{r} 22 \\ -\ 10 \\ \hline \end{array}$$

Subtracting Two-Digit Numbers (No Regrouping) · 2

Subtract.

$$\begin{array}{r} 64 \\ -\ 23 \\ \hline \end{array}$$

Subtracting Two-Digit Numbers (No Regrouping) · 3

$29 - 19 = ___$

Subtracting Two-Digit Numbers (No Regrouping) · 4

The blocks show 58. Take away 47. How many are left?

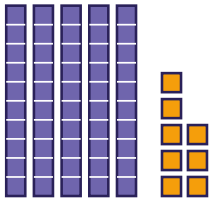

Subtracting Two-Digit Numbers (No Regrouping) · 5

Take away the tens, then the ones: 45 − 10 = 35, then take away 1 more. 45 − 11 = ___

Subtracting Two-Digit Numbers (No Regrouping) · 6

$39 - ___ = 18$

Subtracting Two-Digit Numbers (No Regrouping) · 7

Ben has 23 cards and gives away 13. How many cards does Ben have left?

Subtracting Two-Digit Numbers (No Regrouping) · 8

$26 - 15 = 25 - ___$

Subtracting Two-Digit Numbers (No Regrouping) · 2

ANSWER

41

Subtracting Two-Digit Numbers (No Regrouping) · 1

ANSWER

12

Subtracting Two-Digit Numbers (No Regrouping) · 4

ANSWER

11

Subtracting Two-Digit Numbers (No Regrouping) · 3

ANSWER

10

Subtracting Two-Digit Numbers (No Regrouping) · 6

ANSWER

21

Subtracting Two-Digit Numbers (No Regrouping) · 5

ANSWER

34

Subtracting Two-Digit Numbers (No Regrouping) · 8

ANSWER

14

Subtracting Two-Digit Numbers (No Regrouping) · 7

ANSWER

10

Subtract.

$$\begin{array}{r} 44 \\ -\ 11 \\ \hline \end{array}$$

Subtract.

$$\begin{array}{r} 87 \\ -\ 16 \\ \hline \end{array}$$

$84 - 50 = ___$

The blocks show 27. Take away 17. How many are left?

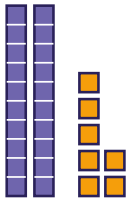

Take away the tens, then the ones: 37 − 20 = 17, then take away 2 more. 37 − 22 = ___

$82 - ___ = 52$

Leo has 65 cards and gives away 13. How many cards does Leo have left?

$78 - 11 = 76 - ___$

Subtracting Two-Digit Numbers (No Regrouping) · 10

ANSWER

71

Subtracting Two-Digit Numbers (No Regrouping) · 9

ANSWER

33

Subtracting Two-Digit Numbers (No Regrouping) · 12

ANSWER

10

Subtracting Two-Digit Numbers (No Regrouping) · 11

ANSWER

34

Subtracting Two-Digit Numbers (No Regrouping) · 14

ANSWER

30

Subtracting Two-Digit Numbers (No Regrouping) · 13

ANSWER

15

Subtracting Two-Digit Numbers (No Regrouping) · 16

ANSWER

9

Subtracting Two-Digit Numbers (No Regrouping) · 15

ANSWER

52

Subtract.

$$\begin{array}{r} 88 \\ -\ 10 \\ \hline \end{array}$$

Subtract.

$$\begin{array}{r} 68 \\ -\ 61 \\ \hline \end{array}$$

$67 - 12 = ___$

The blocks show 98. Take away 67. How many are left?



Take away the tens, then the ones: 69 − 50 = 19, then take away 6 more. 69 − 56 = ___

$95 - ___ = 33$

Ava has 87 shells and gives away 63. How many shells does Ava have left?

$97 - 32 = 95 - ___$

Subtracting Two-Digit Numbers (No Regrouping) · 18

ANSWER

7

Subtracting Two-Digit Numbers (No Regrouping) · 17

ANSWER

78

Subtracting Two-Digit Numbers (No Regrouping) · 20

ANSWER

31

Subtracting Two-Digit Numbers (No Regrouping) · 19

ANSWER

55

Subtracting Two-Digit Numbers (No Regrouping) · 22

ANSWER

62

Subtracting Two-Digit Numbers (No Regrouping) · 21

ANSWER

13

Subtracting Two-Digit Numbers (No Regrouping) · 24

ANSWER

30

Subtracting Two-Digit Numbers (No Regrouping) · 23

ANSWER

24