Subtracting Two-Digit Numbers (No Regrouping) · 1

Subtract.

$$\begin{array}{r} 42 \\ -\ ?\ \ 2 \\ \hline \end{array}$$

Subtracting Two-Digit Numbers (No Regrouping) · 2

Subtract.

$$\begin{array}{r} 35 \\ -\ ?\ \ 5 \\ \hline \end{array}$$

Subtracting Two-Digit Numbers (No Regrouping) · 3

$39 - 8 = ___$

Subtracting Two-Digit Numbers (No Regrouping) · 4

The blocks show 26. Take away 3. How many are left?

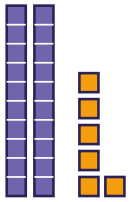

Subtracting Two-Digit Numbers (No Regrouping) · 5

Think: $4 + ? = 76$.

So $76 - 4 = ___$

Subtracting Two-Digit Numbers (No Regrouping) · 6

$45 - ___ = 40$

Subtracting Two-Digit Numbers (No Regrouping) · 7

Leo has 95 shells and gives away 1. How many shells does Leo have left?

Subtracting Two-Digit Numbers (No Regrouping) · 8

$94 - 2 = 93 - ___$

Subtracting Two-Digit Numbers (No Regrouping) · 2

ANSWER

30

Subtracting Two-Digit Numbers (No Regrouping) · 1

ANSWER

40

Subtracting Two-Digit Numbers (No Regrouping) · 4

ANSWER

23

Subtracting Two-Digit Numbers (No Regrouping) · 3

ANSWER

31

Subtracting Two-Digit Numbers (No Regrouping) · 6

ANSWER

5

Subtracting Two-Digit Numbers (No Regrouping) · 5

ANSWER

72

Subtracting Two-Digit Numbers (No Regrouping) · 8

ANSWER

1

Subtracting Two-Digit Numbers (No Regrouping) · 7

ANSWER

94

Subtract.

$$\begin{array}{r} 25 \\ -\ 1 \\ \hline \end{array}$$

Subtract.

$$\begin{array}{r} 24 \\ -\ 3 \\ \hline \end{array}$$

$96 - 1 = ___$

The blocks show 28. Take away 1. How many are left?

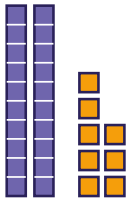

Think: $7 + ? = 28$.

So $28 - 7 = ___$

$88 - ___ = 81$

Mia has 78 cards and gives away 8. How many cards does Mia have left?

$27 - 3 = 25 - ___$

Subtracting Two-Digit Numbers (No Regrouping) · 10

ANSWER

21

Subtracting Two-Digit Numbers (No Regrouping) · 9

ANSWER

24

Subtracting Two-Digit Numbers (No Regrouping) · 12

ANSWER

27

Subtracting Two-Digit Numbers (No Regrouping) · 11

ANSWER

95

Subtracting Two-Digit Numbers (No Regrouping) · 14

ANSWER

7

Subtracting Two-Digit Numbers (No Regrouping) · 13

ANSWER

21

Subtracting Two-Digit Numbers (No Regrouping) · 16

ANSWER

1

Subtracting Two-Digit Numbers (No Regrouping) · 15

ANSWER

70

Subtract.

$$\begin{array}{r} 85 \\ -\ 10 \\ \hline \end{array}$$

Subtract.

$$\begin{array}{r} 49 \\ -\ 30 \\ \hline \end{array}$$

$$69 - 32 = ___$$

The blocks show 69. Take away 10. How many are left?

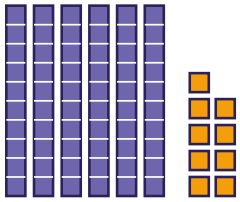

Think: $18 + ? =$ 98. So $98 - 18 =$ $___$

$$98 - ___ = 63$$

Lily has 56 toy cars and gives away 30. How many toy cars does Lily have left?

$$82 - 32 = 79 - ___$$

Subtracting Two-Digit Numbers (No Regrouping) · 18

ANSWER

19

Subtracting Two-Digit Numbers (No Regrouping) · 17

ANSWER

75

Subtracting Two-Digit Numbers (No Regrouping) · 20

ANSWER

59

Subtracting Two-Digit Numbers (No Regrouping) · 19

ANSWER

37

Subtracting Two-Digit Numbers (No Regrouping) · 22

ANSWER

35

Subtracting Two-Digit Numbers (No Regrouping) · 21

ANSWER

80

Subtracting Two-Digit Numbers (No Regrouping) · 24

ANSWER

29

Subtracting Two-Digit Numbers (No Regrouping) · 23

ANSWER

26