Task card 1 St. Patrick's Day Math

The school bakes 41 mint cupcakes and 18 green muffins for the bake sale. How many treats is that in all?

Task card 2 St. Patrick's Day Math

Ben puts 3 green muffins on each of 3 plates. How many green muffins is that in all?



Task card 3 St. Patrick's Day Math

Ella buys a paper shamrock for 10¢ and a gold coin sticker for 15¢. How many cents does Ella spend?

Task card 4 St. Patrick's Day Math

Leo buys a gold coin sticker for 20¢ and a paper shamrock for 10¢. How many cents does Leo spend?

Task card 5 St. Patrick's Day Math

The bakery makes 85 shamrock cookies. It sells 78 of them. How many shamrock cookies are left?

Task card 6 St. Patrick's Day Math

The school bakes 18 green muffins and 28 shamrock cookies for the bake sale. How many treats is that in all?

Task card 7 St. Patrick's Day Math

The bakery makes 60 shamrock cookies. It sells 47 of them. How many shamrock cookies are left?

Task card 8 St. Patrick's Day Math

Lily puts 3 green muffins on each of 3 plates. How many green muffins is that in all?



Task card 9 St. Patrick's Day Math

Sam buys a paper shamrock for 10¢ and a rainbow streamer for 10¢. How many cents does Sam spend?

Task card 10 St. Patrick's Day Math

Ava puts 3 green muffins on each of 3 plates. How many green muffins is that in all?



Task card 11 St. Patrick's Day Math

The school bakes 208 shamrock cookies and 282 mint cupcakes for the bake sale. How many treats is that in all?

Task card 12 St. Patrick's Day Math

The bakery makes 249 shamrock cookies. It sells 71 of them. How many shamrock cookies are left?

Task card 13 St. Patrick's Day Math

Mia puts 5 shamrock cookies on each of 4 plates. How many shamrock cookies is that in all?



Task card 14 St. Patrick's Day Math

The bakery makes 37 mint cupcakes. It sells 28 of them. How many mint cupcakes are left?

Task card 15 St. Patrick's Day Math

The school bakes 191 shamrock cookies and 87 mint cupcakes for the bake sale. How many treats is that in all?

Task card 16 St. Patrick's Day Math

Omar buys a rainbow streamer for 25¢ and a gold coin sticker for 20¢. How many cents does Omar spend?

Task card 17 St. Patrick's Day Math

The school bakes 155 green muffins and 324 shamrock cookies for the bake sale. How many treats is that in all?

Task card 18 St. Patrick's Day Math

Omar buys a rainbow streamer for 15¢ and a paper shamrock for 30¢. How many cents does Omar spend?

Task card 19 St. Patrick's Day Math

The school bakes 19 shamrock cookies and 286 green muffins for the bake sale. How many treats is that in all?

Task card 20 St. Patrick's Day Math

Mia puts 2 mint cupcakes on each of 5 plates. How many mint cupcakes is that in all?



Task card 21 St. Patrick's Day Math

Ella puts 2 green muffins on each of 4 plates. How many green muffins is that in all?



Task card 22 St. Patrick's Day Math

The bakery makes 468 green muffins. It sells 166 of them. How many green muffins are left?

Task card 23 St. Patrick's Day Math

Sam buys a gold coin sticker for 15¢ and a paper shamrock for 40¢. How many cents does Sam spend?

Task card 24 St. Patrick's Day Math

The bakery makes 489 green muffins. It sells 50 of them. How many green muffins are left?

St. Patrick's Day Math Task Cards

Recording sheet · Grade 2 · Read each story and solve.

Name: _____ Date: _____

Scan to check your answers

1	2	3	4
5	6	7	8
9	10	11	12
13	14	15	16
17	18	19	20
21	22	23	24

St. Patrick's Day Math Task Cards: Answer Key

Grade 2 · Medium

The answers online

1. 59	**2.** 9	**3.** 25
4. 30	**5.** 7	**6.** 46
7. 13	**8.** 9	**9.** 20
10. 9	**11.** 490	**12.** 178
13. 20	**14.** 9	**15.** 278
16. 45	**17.** 479	**18.** 45
19. 305	**20.** 10	**21.** 8
22. 302	**23.** 55	**24.** 439