Task card 1 St. Patrick's Day Math

The school bakes 116 shamrock cookies and 88 green muffins for the bake sale. How many treats is that in all?

Task card 2 St. Patrick's Day Math

The school bakes 175 mint cupcakes and 66 shamrock cookies for the bake sale. How many treats is that in all?

Task card 3 St. Patrick's Day Math

Sam buys a paper shamrock for 10¢ and a gold coin sticker for 25¢. How many cents does Sam spend?

Task card 4 St. Patrick's Day Math

The bakery makes 141 mint cupcakes. It sells 27 of them. How many mint cupcakes are left?

Task card 5 St. Patrick's Day Math

Ella puts 4 green muffins on each of 3 plates. How many green muffins is that in all?



Task card 6 St. Patrick's Day Math

Mia buys a paper shamrock for 35¢ and a rainbow streamer for 25¢. How many cents does Mia spend?

Task card 7 St. Patrick's Day Math

Ella puts 5 shamrock cookies on each of 3 plates. How many shamrock cookies is that in all?



Task card 8 St. Patrick's Day Math

The bakery makes 117 green muffins. It sells 60 of them. How many green muffins are left?

Task card 9 St. Patrick's Day Math

The school bakes 137 green muffins and 18 shamrock cookies for the bake sale. How many treats is that in all?

Task card 10 St. Patrick's Day Math

Mia puts 2 shamrock cookies on each of 4 plates. How many shamrock cookies is that in all?



Task card 11 St. Patrick's Day Math

Zoe buys a paper shamrock for 40¢ and a gold coin sticker for 30¢. How many cents does Zoe spend?

Task card 12 St. Patrick's Day Math

The bakery makes 308 shamrock cookies. It sells 120 of them. How many shamrock cookies are left?

Task card 13 St. Patrick's Day Math

The bakery makes 320 mint cupcakes. It sells 48 of them. How many mint cupcakes are left?

Task card 14 St. Patrick's Day Math

Ella buys a gold coin sticker for 30¢ and a paper shamrock for 5¢. How many cents does Ella spend?

Task card 15 St. Patrick's Day Math

The school bakes 201 green muffins and 16 shamrock cookies for the bake sale. How many treats is that in all?

Task card 16 St. Patrick's Day Math

Ella puts 5 mint cupcakes on each of 2 plates. How many mint cupcakes is that in all?



Task card 17 St. Patrick's Day Math

Sam buys a paper shamrock for 25¢ and a gold coin sticker for 15¢. How many cents does Sam spend?

Task card 18 St. Patrick's Day Math

The bakery makes 38 mint cupcakes. It sells 26 of them. How many mint cupcakes are left?

Task card 19 St. Patrick's Day Math

The bakery makes 145 green muffins. It sells 78 of them. How many green muffins are left?

Task card 20 St. Patrick's Day Math

Ella puts 3 shamrock cookies on each of 4 plates. How many shamrock cookies is that in all?



Task card 21 St. Patrick's Day Math

Mia puts 4 green muffins on each of 3 plates. How many green muffins is that in all?



Task card 22 St. Patrick's Day Math

The school bakes 241 shamrock cookies and 110 green muffins for the bake sale. How many treats is that in all?

Task card 23 St. Patrick's Day Math

The school bakes 102 green muffins and 67 shamrock cookies for the bake sale. How many treats is that in all?

Task card 24 St. Patrick's Day Math

Sam buys a rainbow streamer for 30¢ and a gold coin sticker for 45¢. How many cents does Sam spend?

St. Patrick's Day Math Task Cards

Recording sheet · Grade 2 · Read each story and solve.

Name: _____ Date: _____

Scan to check your answers

1	2	3	4
5	6	7	8
9	10	11	12
13	14	15	16
17	18	19	20
21	22	23	24

St. Patrick's Day Math Task Cards: Answer Key

Grade 2 · Hard

The answers online

1. 204	**2.** 241	**3.** 35
4. 114	**5.** 12	**6.** 60
7. 15	**8.** 57	**9.** 155
10. 8	**11.** 70	**12.** 188
13. 272	**14.** 35	**15.** 217
16. 10	**17.** 40	**18.** 12
19. 67	**20.** 12	**21.** 12
22. 351	**23.** 169	**24.** 75