Task card 1 St. Patrick's Day Math

Ella buys a paper shamrock for 35¢ and a rainbow streamer for 15¢. How many cents does Ella spend?

Task card 2 St. Patrick's Day Math

Leo buys a rainbow streamer for 35¢ and a paper shamrock for 15¢. How many cents does Leo spend?

Task card 3 St. Patrick's Day Math

The school bakes 33 mint cupcakes and 38 shamrock cookies for the bake sale. How many treats is that in all?

Task card 4 St. Patrick's Day Math

The bakery makes 32 green muffins. It sells 26 of them. How many green muffins are left?

Task card 5 St. Patrick's Day Math

The school bakes 47 mint cupcakes and 33 shamrock cookies for the bake sale. How many treats is that in all?

Task card 6 St. Patrick's Day Math

Lily puts 5 mint cupcakes on each of 2 plates. How many mint cupcakes is that in all?



Task card 7 St. Patrick's Day Math

The bakery makes 96 mint cupcakes. It sells 15 of them. How many mint cupcakes are left?

Task card 8 St. Patrick's Day Math

Omar puts 5 shamrock cookies on each of 2 plates. How many shamrock cookies is that in all?



Task card 9 St. Patrick's Day Math

The school bakes 33 green muffins and 58 mint cupcakes for the bake sale. How many treats is that in all?

Task card 10 St. Patrick's Day Math

The school bakes 42 green muffins and 11 mint cupcakes for the bake sale. How many treats is that in all?

Task card 11 St. Patrick's Day Math

Mia puts 2 mint cupcakes on each of 2 plates. How many mint cupcakes is that in all?



Task card 12 St. Patrick's Day Math

Ella buys a rainbow streamer for 35¢ and a gold coin sticker for 20¢. How many cents does Ella spend?

Task card 13 St. Patrick's Day Math

The bakery makes 80 shamrock cookies. It sells 65 of them. How many shamrock cookies are left?

Task card 14 St. Patrick's Day Math

Ella buys a paper shamrock for 20¢ and a rainbow streamer for 5¢. How many cents does Ella spend?

Task card 15 St. Patrick's Day Math

The bakery makes 44 shamrock cookies. It sells 23 of them. How many shamrock cookies are left?

Task card 16 St. Patrick's Day Math

Sam puts 5 shamrock cookies on each of 3 plates. How many shamrock cookies is that in all?



Task card 17 St. Patrick's Day Math

Leo puts 2 green muffins on each of 3 plates. How many green muffins is that in all?



Task card 18 St. Patrick's Day Math

Omar buys a gold coin sticker for 40¢ and a paper shamrock for 15¢. How many cents does Omar spend?

Task card 19 St. Patrick's Day Math

The school bakes 50 mint cupcakes and 45 green muffins for the bake sale. How many treats is that in all?

Task card 20 St. Patrick's Day Math

Zoe buys a rainbow streamer for 10¢ and a paper shamrock for 5¢. How many cents does Zoe spend?

Task card 21 St. Patrick's Day Math

The school bakes 48 shamrock cookies and 18 green muffins for the bake sale. How many treats is that in all?

Task card 22 St. Patrick's Day Math

The bakery makes 70 mint cupcakes. It sells 22 of them. How many mint cupcakes are left?

Task card 23 St. Patrick's Day Math

The bakery makes 63 mint cupcakes. It sells 57 of them. How many mint cupcakes are left?

Task card 24 St. Patrick's Day Math

Omar puts 5 mint cupcakes on each of 2 plates. How many mint cupcakes is that in all?



St. Patrick's Day Math Task Cards

Recording sheet · Grade 2 · Read each story and solve.

Name: _____ Date: _____

Scan to check your answers

1	2	3	4
5	6	7	8
9	10	11	12
13	14	15	16
17	18	19	20
21	22	23	24

St. Patrick's Day Math Task Cards: Answer Key

Grade 2 · Easy

The answers online

1. 50	**2.** 50	**3.** 71
4. 6	**5.** 80	**6.** 10
7. 81	**8.** 10	**9.** 91
10. 53	**11.** 4	**12.** 55
13. 15	**14.** 25	**15.** 21
16. 15	**17.** 6	**18.** 55
19. 95	**20.** 15	**21.** 66
22. 48	**23.** 6	**24.** 10