St. Patrick's Day Math · 1

The school bakes 41 mint cupcakes and 18 green muffins for the bake sale. How many treats is that in all?

St. Patrick's Day Math · 2

Ben puts 3 green muffins on each of 3 plates. How many green muffins is that in all?



St. Patrick's Day Math · 3

Ella buys a paper shamrock for 10¢ and a gold coin sticker for 15¢. How many cents does Ella spend?

St. Patrick's Day Math · 4

Leo buys a gold coin sticker for 20¢ and a paper shamrock for 10¢. How many cents does Leo spend?

St. Patrick's Day Math · 5

The bakery makes 85 shamrock cookies. It sells 78 of them. How many shamrock cookies are left?

St. Patrick's Day Math · 6

The school bakes 18 green muffins and 28 shamrock cookies for the bake sale. How many treats is that in all?

St. Patrick's Day Math · 7

The bakery makes 60 shamrock cookies. It sells 47 of them. How many shamrock cookies are left?

St. Patrick's Day Math · 8

Lily puts 3 green muffins on each of 3 plates. How many green muffins is that in all?



St. Patrick's Day Math · 2

ANSWER

9

St. Patrick's Day Math · 1

ANSWER

59

St. Patrick's Day Math · 4

ANSWER

30

St. Patrick's Day Math · 3

ANSWER

25

St. Patrick's Day Math · 6

ANSWER

46

St. Patrick's Day Math · 5

ANSWER

7

St. Patrick's Day Math · 8

ANSWER

9

St. Patrick's Day Math · 7

ANSWER

13

St. Patrick's Day Math · 9

Sam buys a paper shamrock for 10¢ and a rainbow streamer for 10¢. How many cents does Sam spend?

St. Patrick's Day Math · 10

Ava puts 3 green muffins on each of 3 plates. How many green muffins is that in all?



St. Patrick's Day Math · 11

The school bakes 208 shamrock cookies and 282 mint cupcakes for the bake sale. How many treats is that in all?

St. Patrick's Day Math · 12

The bakery makes 249 shamrock cookies. It sells 71 of them. How many shamrock cookies are left?

St. Patrick's Day Math · 13

Mia puts 5 shamrock cookies on each of 4 plates. How many shamrock cookies is that in all?



St. Patrick's Day Math · 14

The bakery makes 37 mint cupcakes. It sells 28 of them. How many mint cupcakes are left?

St. Patrick's Day Math · 15

The school bakes 191 shamrock cookies and 87 mint cupcakes for the bake sale. How many treats is that in all?

St. Patrick's Day Math · 16

Omar buys a rainbow streamer for 25¢ and a gold coin sticker for 20¢. How many cents does Omar spend?

St. Patrick's Day Math · 10

ANSWER

9

St. Patrick's Day Math · 9

ANSWER

20

St. Patrick's Day Math · 12

ANSWER

178

St. Patrick's Day Math · 11

ANSWER

490

St. Patrick's Day Math · 14

ANSWER

9

St. Patrick's Day Math · 13

ANSWER

20

St. Patrick's Day Math · 16

ANSWER

45

St. Patrick's Day Math · 15

ANSWER

278

St. Patrick's Day Math · 17

The school bakes 155 green muffins and 324 shamrock cookies for the bake sale. How many treats is that in all?

St. Patrick's Day Math · 18

Omar buys a rainbow streamer for 15¢ and a paper shamrock for 30¢. How many cents does Omar spend?

St. Patrick's Day Math · 19

The school bakes 19 shamrock cookies and 286 green muffins for the bake sale. How many treats is that in all?

St. Patrick's Day Math · 20

Mia puts 2 mint cupcakes on each of 5 plates. How many mint cupcakes is that in all?



St. Patrick's Day Math · 21

Ella puts 2 green muffins on each of 4 plates. How many green muffins is that in all?



St. Patrick's Day Math · 22

The bakery makes 468 green muffins. It sells 166 of them. How many green muffins are left?

St. Patrick's Day Math · 23

Sam buys a gold coin sticker for 15¢ and a paper shamrock for 40¢. How many cents does Sam spend?

St. Patrick's Day Math · 24

The bakery makes 489 green muffins. It sells 50 of them. How many green muffins are left?

St. Patrick's Day Math · 18

ANSWER

45

St. Patrick's Day Math · 17

ANSWER

479

St. Patrick's Day Math · 20

ANSWER

10

St. Patrick's Day Math · 19

ANSWER

305

St. Patrick's Day Math · 22

ANSWER

302

St. Patrick's Day Math · 21

ANSWER

8

St. Patrick's Day Math · 24

ANSWER

439

St. Patrick's Day Math · 23

ANSWER

55