St. Patrick's Day Math · 1

The school bakes 116 shamrock cookies and 88 green muffins for the bake sale. How many treats is that in all?

St. Patrick's Day Math · 2

The school bakes 175 mint cupcakes and 66 shamrock cookies for the bake sale. How many treats is that in all?

St. Patrick's Day Math · 3

Sam buys a paper shamrock for 10¢ and a gold coin sticker for 25¢. How many cents does Sam spend?

St. Patrick's Day Math · 4

The bakery makes 141 mint cupcakes. It sells 27 of them. How many mint cupcakes are left?

St. Patrick's Day Math · 5

Ella puts 4 green muffins on each of 3 plates. How many green muffins is that in all?



St. Patrick's Day Math · 6

Mia buys a paper shamrock for 35¢ and a rainbow streamer for 25¢. How many cents does Mia spend?

St. Patrick's Day Math · 7

Ella puts 5 shamrock cookies on each of 3 plates. How many shamrock cookies is that in all?



St. Patrick's Day Math · 8

The bakery makes 117 green muffins. It sells 60 of them. How many green muffins are left?

St. Patrick's Day Math · 2

ANSWER

241

St. Patrick's Day Math · 1

ANSWER

204

St. Patrick's Day Math · 4

ANSWER

114

St. Patrick's Day Math · 3

ANSWER

35

St. Patrick's Day Math · 6

ANSWER

60

St. Patrick's Day Math · 5

ANSWER

12

St. Patrick's Day Math · 8

ANSWER

57

St. Patrick's Day Math · 7

ANSWER

15

St. Patrick's Day Math · 9

The school bakes 137 green muffins and 18 shamrock cookies for the bake sale. How many treats is that in all?

St. Patrick's Day Math · 10

Mia puts 2 shamrock cookies on each of 4 plates. How many shamrock cookies is that in all?



St. Patrick's Day Math · 11

Zoe buys a paper shamrock for 40¢ and a gold coin sticker for 30¢. How many cents does Zoe spend?

St. Patrick's Day Math · 12

The bakery makes 308 shamrock cookies. It sells 120 of them. How many shamrock cookies are left?

St. Patrick's Day Math · 13

The bakery makes 320 mint cupcakes. It sells 48 of them. How many mint cupcakes are left?

St. Patrick's Day Math · 14

Ella buys a gold coin sticker for 30¢ and a paper shamrock for 5¢. How many cents does Ella spend?

St. Patrick's Day Math · 15

The school bakes 201 green muffins and 16 shamrock cookies for the bake sale. How many treats is that in all?

St. Patrick's Day Math · 16

Ella puts 5 mint cupcakes on each of 2 plates. How many mint cupcakes is that in all?



St. Patrick's Day Math · 10

ANSWER

8

St. Patrick's Day Math · 9

ANSWER

155

St. Patrick's Day Math · 12

ANSWER

188

St. Patrick's Day Math · 11

ANSWER

70

St. Patrick's Day Math · 14

ANSWER

35

St. Patrick's Day Math · 13

ANSWER

272

St. Patrick's Day Math · 16

ANSWER

10

St. Patrick's Day Math · 15

ANSWER

217

St. Patrick's Day Math · 17

Sam buys a paper shamrock for 25¢ and a gold coin sticker for 15¢. How many cents does Sam spend?

St. Patrick's Day Math · 18

The bakery makes 38 mint cupcakes. It sells 26 of them. How many mint cupcakes are left?

St. Patrick's Day Math · 19

The bakery makes 145 green muffins. It sells 78 of them. How many green muffins are left?

St. Patrick's Day Math · 20

Ella puts 3 shamrock cookies on each of 4 plates. How many shamrock cookies is that in all?



St. Patrick's Day Math · 21

Mia puts 4 green muffins on each of 3 plates. How many green muffins is that in all?



St. Patrick's Day Math · 22

The school bakes 241 shamrock cookies and 110 green muffins for the bake sale. How many treats is that in all?

St. Patrick's Day Math · 23

The school bakes 102 green muffins and 67 shamrock cookies for the bake sale. How many treats is that in all?

St. Patrick's Day Math · 24

Sam buys a rainbow streamer for 30¢ and a gold coin sticker for 45¢. How many cents does Sam spend?

St. Patrick's Day Math · 18

ANSWER

12

St. Patrick's Day Math · 17

ANSWER

40

St. Patrick's Day Math · 20

ANSWER

12

St. Patrick's Day Math · 19

ANSWER

67

St. Patrick's Day Math · 22

ANSWER

351

St. Patrick's Day Math · 21

ANSWER

12

St. Patrick's Day Math · 24

ANSWER

75

St. Patrick's Day Math · 23

ANSWER

169