Task card 1 Sides, Vertices, Faces & Edges

How many vertices (corners) does this shape have?

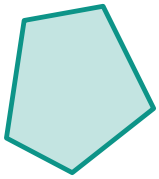

Task card 2 Sides, Vertices, Faces & Edges

A flat shape has 3 sides and 3 vertices. Is it a triangle, quadrilateral, pentagon or hexagon?

Task card 3 Sides, Vertices, Faces & Edges

This is a cube. How many faces does it have?

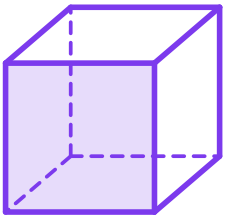

Task card 4 Sides, Vertices, Faces & Edges

This is a cube. How many vertices does it have?

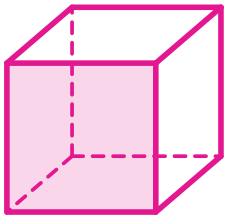

Task card 5 Sides, Vertices, Faces & Edges

How many sides does this shape have?

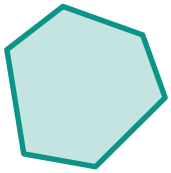

Task card 6 Sides, Vertices, Faces & Edges

How many vertices (corners) does this shape have?



Task card 7 Sides, Vertices, Faces & Edges

A flat shape has 6 sides and 6 vertices. Is it a triangle, quadrilateral, pentagon or hexagon?

Task card 8 Sides, Vertices, Faces & Edges

This is a rectangular prism. How many faces does it have?

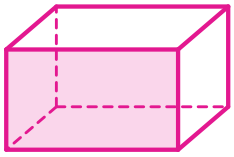

Task card 9 Sides, Vertices, Faces & Edges

This is a square pyramid. How many faces does it have?

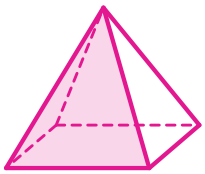

Task card 10 Sides, Vertices, Faces & Edges

This is a rectangular prism. How many edges does it have?

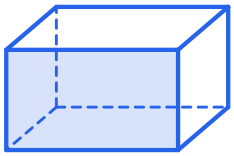

Task card 11 Sides, Vertices, Faces & Edges

This is a cube. How many vertices does it have?

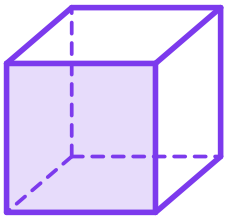

Task card 12 Sides, Vertices, Faces & Edges

How many sides does this shape have?



Task card 13 Sides, Vertices, Faces & Edges

A flat shape has 5 sides and 5 vertices. Is it a triangle, quadrilateral, pentagon or hexagon?

Task card 14 Sides, Vertices, Faces & Edges

This is a cube. How many edges does it have?

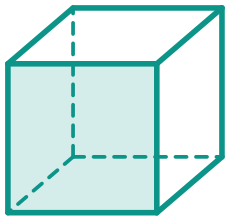

Task card 15 Sides, Vertices, Faces & Edges

This is a triangular prism. How many vertices does it have?

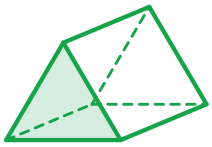

Task card 16 Sides, Vertices, Faces & Edges

This is a cube. How many faces does it have?

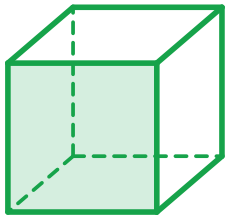

Task card 17 Sides, Vertices, Faces & Edges

This is a cube. How many edges does it have?

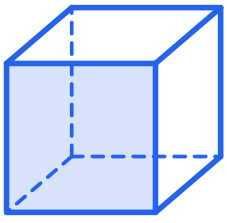

Task card 18 Sides, Vertices, Faces & Edges

This is a rectangular prism. How many vertices does it have?

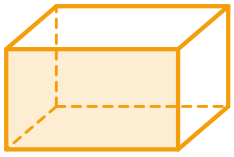

Task card 19 Sides, Vertices, Faces & Edges

How many sides does this shape have?



Task card 20 Sides, Vertices, Faces & Edges

This is a square pyramid. How many faces does it have?

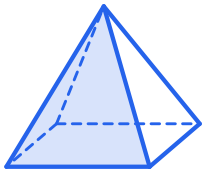

Task card 21 Sides, Vertices, Faces & Edges

This is a square pyramid. How many edges does it have?

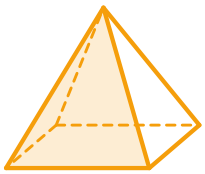

Task card 22 Sides, Vertices, Faces & Edges

This is a square pyramid. How many vertices does it have?

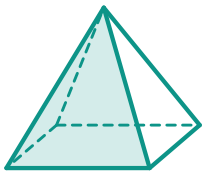

Task card 23 Sides, Vertices, Faces & Edges

This is a cube. How many vertices does it have?

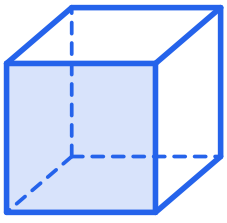

Task card 24 Sides, Vertices, Faces & Edges

How many sides does this shape have?

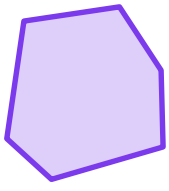

Sides, Vertices, Faces & Edges Task Cards

Recording sheet · Grade 2 · Count carefully. Dashed lines are edges hiding at the back.

Name: _____ Date: _____

Scan to check your answers

1	2	3	4
5	6	7	8
9	10	11	12
13	14	15	16
17	18	19	20
21	22	23	24

Sides, Vertices, Faces & Edges Task Cards: Answer Key

Grade 2 · Medium

The answers online

1. 5	**2.** triangle	**3.** 6
4. 8	**5.** 6	**6.** 4
7. hexagon	**8.** 6	**9.** 5
10. 12	**11.** 8	**12.** 4
13. pentagon	**14.** 12	**15.** 6
16. 6	**17.** 12	**18.** 8
19. 3	**20.** 5	**21.** 8
22. 5	**23.** 8	**24.** 6