Task card 1 Sides, Vertices, Faces & Edges

How many sides does this shape have?



Task card 2 Sides, Vertices, Faces & Edges

How many vertices (corners) does this shape have?

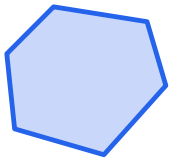

Task card 3 Sides, Vertices, Faces & Edges

How many sides does this shape have?

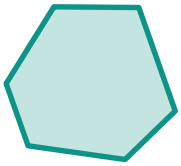

Task card 4 Sides, Vertices, Faces & Edges

A flat shape has 5 sides and 5 vertices. Is it a triangle, quadrilateral, pentagon or hexagon?

Task card 5 Sides, Vertices, Faces & Edges

How many sides does this shape have?

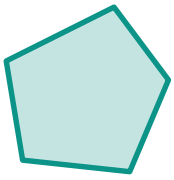

Task card 6 Sides, Vertices, Faces & Edges

How many vertices (corners) does this shape have?



Task card 7 Sides, Vertices, Faces & Edges

How many sides does this shape have?



Task card 8 Sides, Vertices, Faces & Edges

A flat shape has 3 sides and 3 vertices. Is it a triangle, quadrilateral, pentagon or hexagon?

Task card 9 Sides, Vertices, Faces & Edges

A flat shape has 6 sides and 6 vertices. Is it a triangle, quadrilateral, pentagon or hexagon?

Task card 10 Sides, Vertices, Faces & Edges

How many sides does this shape have?



Task card 11 Sides, Vertices, Faces & Edges

How many vertices (corners) does this shape have?



Task card 12 Sides, Vertices, Faces & Edges

How many sides does this shape have?



Task card 13 Sides, Vertices, Faces & Edges

How many sides does this shape have?

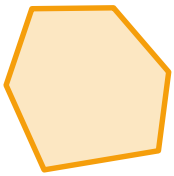

Task card 14 Sides, Vertices, Faces & Edges

How many vertices (corners) does this shape have?



Task card 15 Sides, Vertices, Faces & Edges

How many sides does this shape have?

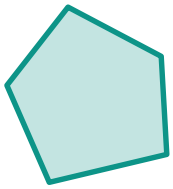

Task card 16 Sides, Vertices, Faces & Edges

This is a cube. How many faces does it have?

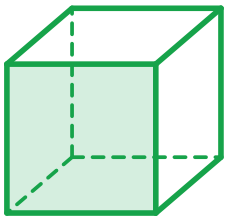

Task card 17 Sides, Vertices, Faces & Edges

This is a rectangular prism. How many vertices does it have?

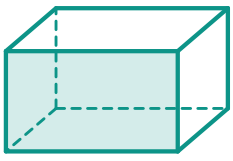

Task card 18 Sides, Vertices, Faces & Edges

How many sides does this shape have?



Task card 19 Sides, Vertices, Faces & Edges

How many vertices (corners) does this shape have?

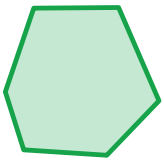

Task card 20 Sides, Vertices, Faces & Edges

A flat shape has 4 sides and 4 vertices. Is it a triangle, quadrilateral, pentagon or hexagon?

Task card 21 Sides, Vertices, Faces & Edges

This is a rectangular prism. How many faces does it have?

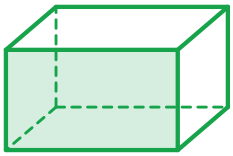

Task card 22 Sides, Vertices, Faces & Edges

This is a cube. How many vertices does it have?

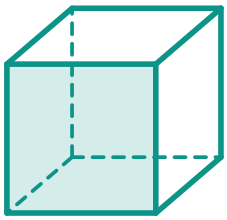

Task card 23 Sides, Vertices, Faces & Edges

How many sides does this shape have?



Task card 24 Sides, Vertices, Faces & Edges

How many vertices (corners) does this shape have?



Sides, Vertices, Faces & Edges Task Cards

Recording sheet · Grade 2 · Count carefully. Dashed lines are edges hiding at the back.

Name: _____ Date: _____

Scan to check your answers

1	2	3	4
5	6	7	8
9	10	11	12
13	14	15	16
17	18	19	20
21	22	23	24

Sides, Vertices, Faces & Edges Task Cards: Answer Key

Grade 2 · Easy

The answers online

1. 3	**2.** 6	**3.** 6
4. pentagon	**5.** 5	**6.** 3
7. 4	**8.** triangle	**9.** hexagon
10. 3	**11.** 3	**12.** 4
13. 6	**14.** 4	**15.** 5
16. 6	**17.** 8	**18.** 5
19. 6	**20.** quadrilateral	**21.** 6
22. 8	**23.** 3	**24.** 4