Task card 1 Rows, Columns & Squares

How many columns of squares are there?

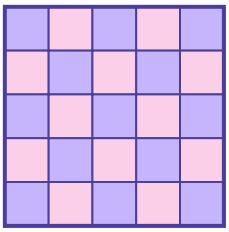

Task card 2 Rows, Columns & Squares

How many columns of squares are there?

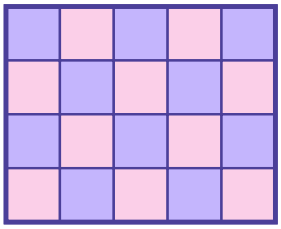

Task card 3 Rows, Columns & Squares

How many columns of squares are there?

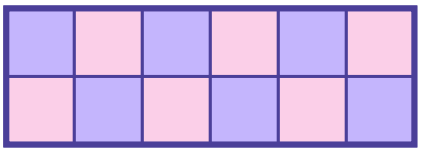

Task card 4 Rows, Columns & Squares

How many rows of squares are there?

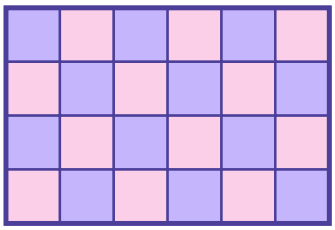

Task card 5 Rows, Columns & Squares

How many squares cover the rectangle?

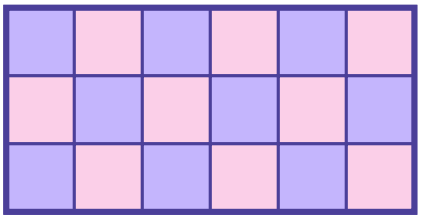

Task card 6 Rows, Columns & Squares

How many squares cover the rectangle?

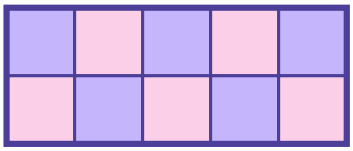

Task card 7 Rows, Columns & Squares

How many squares cover the rectangle?

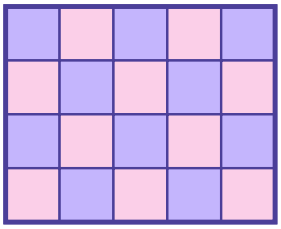

Task card 8 Rows, Columns & Squares

How many squares cover the rectangle?

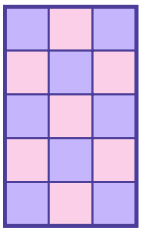

Task card 9 Rows, Columns & Squares

Count the squares in each row, then add the rows: ___ + ___ = ? How many squares in all?

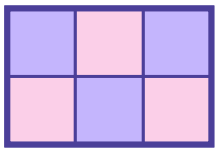

Task card 10 Rows, Columns & Squares

Count the squares in each row, then add the rows: ___ + ___ + ___ + ___ = ? How many squares in all?

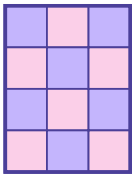

Task card 11 Rows, Columns & Squares

Only the first row and the first column are drawn. If the whole rectangle is filled with same-size squares, how many squares will there be?

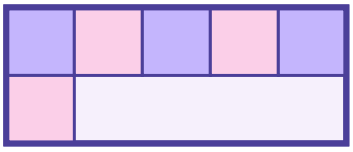

Task card 12 Rows, Columns & Squares

Only the first row and the first column are drawn. If the whole rectangle is filled with same-size squares, how many squares will there be?

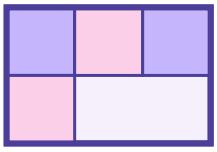

Task card 13 Rows, Columns & Squares

Only the first row and the first column are drawn. If the whole rectangle is filled with same-size squares, how many squares will there be?

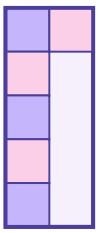

Task card 14 Rows, Columns & Squares

Only the first row and the first column are drawn. If the whole rectangle is filled with same-size squares, how many squares will there be?

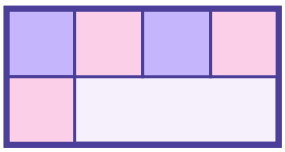

Task card 15 Rows, Columns & Squares

How many squares cover the rectangle?

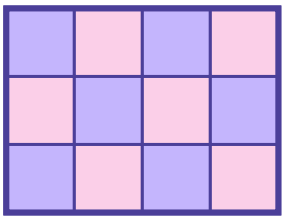

Task card 16 Rows, Columns & Squares

Only the first row and the first column are drawn. If the whole rectangle is filled with same-size squares, how many squares will there be?

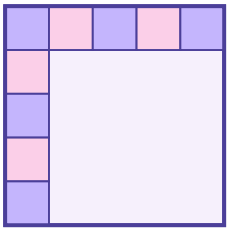

Task card 17 Rows, Columns & Squares

Count the squares in each row, then add the rows: ___ + ___ + ___ + ___ + ___ = ? How many squares in all?

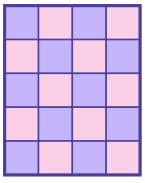

Task card 18 Rows, Columns & Squares

How many squares cover the rectangle?



Task card 19 Rows, Columns & Squares

Count the squares in each row, then add the rows: ___ + ___ = ? How many squares in all?

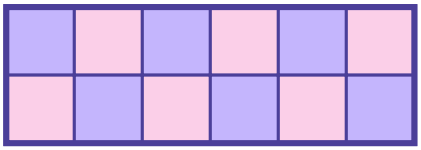

Task card 20 Rows, Columns & Squares

How many squares cover the rectangle?

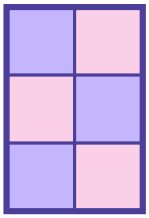

Task card 21 Rows, Columns & Squares

How many squares cover the rectangle?

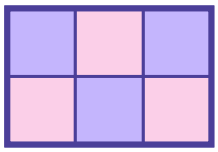

Task card 22 Rows, Columns & Squares

Count the squares in each row, then add the rows: ___ + ___ + ___ = ? How many squares in all?

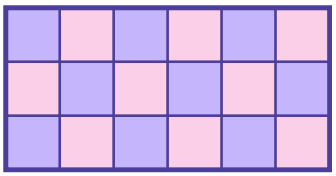

Task card 23 Rows, Columns & Squares

How many squares cover the rectangle?



Task card 24 Rows, Columns & Squares

How many columns of squares are there?

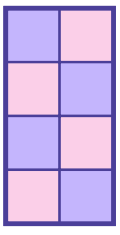

Rows, Columns & Squares Task Cards

Recording sheet · Grade 2 · Look at the rectangle. Count rows, columns or squares.

Name: _____ Date: _____

Scan to check your answers

1	2	3	4
5	6	7	8
9	10	11	12
13	14	15	16
17	18	19	20
21	22	23	24

Rows, Columns & Squares Task Cards: Answer Key

Grade 2 · Medium

The answers online

1. 5	**2.** 5	**3.** 6
4. 4	**5.** 18	**6.** 10
7. 20	**8.** 15	**9.** 6
10. 12	**11.** 10	**12.** 6
13. 10	**14.** 8	**15.** 12
16. 25	**17.** 20	**18.** 10
19. 12	**20.** 6	**21.** 6
22. 18	**23.** 25	**24.** 2