Rows, Columns & Squares · 1

How many columns of squares are there?

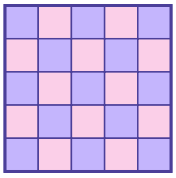

Rows, Columns & Squares · 2

How many columns of squares are there?

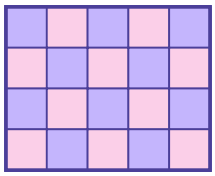

Rows, Columns & Squares · 3

How many columns of squares are there?

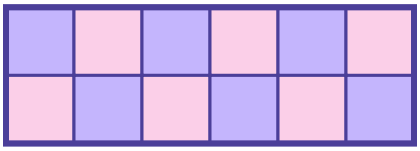

Rows, Columns & Squares · 4

How many rows of squares are there?

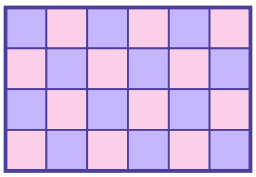

Rows, Columns & Squares · 5

How many squares cover the rectangle?

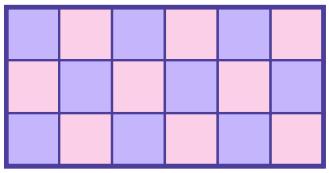

Rows, Columns & Squares · 6

How many squares cover the rectangle?

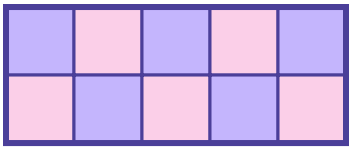

Rows, Columns & Squares · 7

How many squares cover the rectangle?

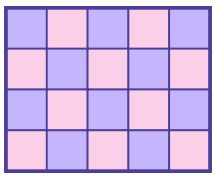

Rows, Columns & Squares · 8

How many squares cover the rectangle?

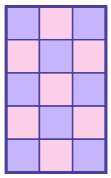

Rows, Columns & Squares · 2

ANSWER

5

Rows, Columns & Squares · 1

ANSWER

5

Rows, Columns & Squares · 4

ANSWER

4

Rows, Columns & Squares · 3

ANSWER

6

Rows, Columns & Squares · 6

ANSWER

10

Rows, Columns & Squares · 5

ANSWER

18

Rows, Columns & Squares · 8

ANSWER

15

Rows, Columns & Squares · 7

ANSWER

20

Rows, Columns & Squares · 9

Count the squares in each row, then add the rows: ___ + ___ = ? How many squares in all?

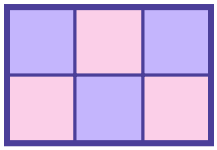

Rows, Columns & Squares · 10

Count the squares in each row, then add the rows: ___ + ___ + ___ + ___ = ? How many squares in all?

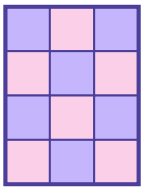

Rows, Columns & Squares · 11

Only the first row and the first column are drawn. If the whole rectangle is filled with same-size squares, how many squares will there be?

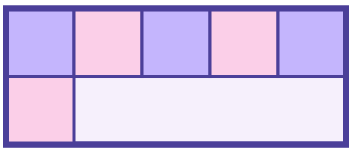

Rows, Columns & Squares · 12

Only the first row and the first column are drawn. If the whole rectangle is filled with same-size squares, how many squares will there be?

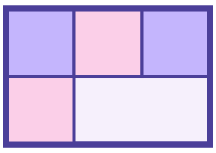

Rows, Columns & Squares · 13

Only the first row and the first column are drawn. If the whole rectangle is filled with same-size squares, how many squares will there be?



Rows, Columns & Squares · 14

Only the first row and the first column are drawn. If the whole rectangle is filled with same-size squares, how many squares will there be?

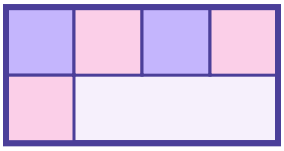

Rows, Columns & Squares · 15

How many squares cover the rectangle?

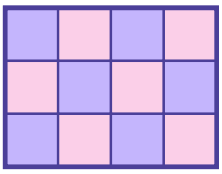

Rows, Columns & Squares · 16

Only the first row and the first column are drawn. If the whole rectangle is filled with same-size squares, how many squares will there be?

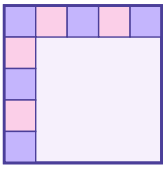

Rows, Columns & Squares · 10

ANSWER

12

Rows, Columns & Squares · 9

ANSWER

6

Rows, Columns & Squares · 12

ANSWER

6

Rows, Columns & Squares · 11

ANSWER

10

Rows, Columns & Squares · 14

ANSWER

8

Rows, Columns & Squares · 13

ANSWER

10

Rows, Columns & Squares · 16

ANSWER

25

Rows, Columns & Squares · 15

ANSWER

12

Rows, Columns & Squares · 17

Count the squares in each row, then add the rows: ___ + ___ + ___ + ___ + ___ = ? How many squares in all?

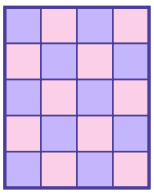

Rows, Columns & Squares · 18

How many squares cover the rectangle?



Rows, Columns & Squares · 19

Count the squares in each row, then add the rows: ___ + ___ = ? How many squares in all?

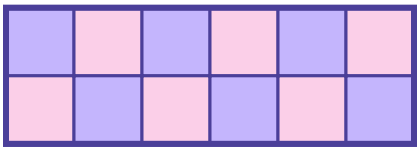

Rows, Columns & Squares · 20

How many squares cover the rectangle?



Rows, Columns & Squares · 21

How many squares cover the rectangle?

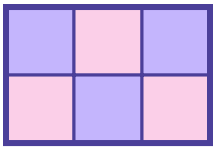

Rows, Columns & Squares · 22

Count the squares in each row, then add the rows: ___ + ___ + ___ = ? How many squares in all?

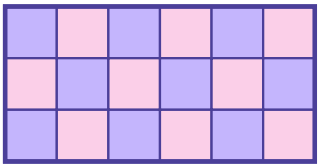

Rows, Columns & Squares · 23

How many squares cover the rectangle?

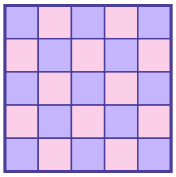

Rows, Columns & Squares · 24

How many columns of squares are there?

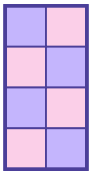

Rows, Columns & Squares · 18

ANSWER

10

Rows, Columns & Squares · 17

ANSWER

20

Rows, Columns & Squares · 20

ANSWER

6

Rows, Columns & Squares · 19

ANSWER

12

Rows, Columns & Squares · 22

ANSWER

18

Rows, Columns & Squares · 21

ANSWER

6

Rows, Columns & Squares · 24

ANSWER

2

Rows, Columns & Squares · 23

ANSWER

25