Picture Graphs · 1

Which sport did the fewest kids choose: Soccer, Swimming, Tennis or Hockey?



Picture Graphs · 2

How many kids chose Apples?



Picture Graphs · 3

How many more kids chose Apples than Pears?



Picture Graphs · 4

How many fewer kids chose Fall than Spring?



Picture Graphs · 5

How many kids answered the question in all?



Picture Graphs · 6

How many kids chose Birds or Dogs in all?



Picture Graphs · 7

Which snack did the fewest kids choose: Popcorn, Crackers, Yogurt or Pretzels?

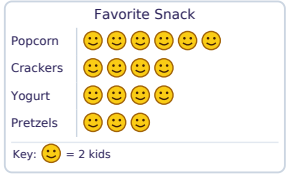

Picture Graphs · 8

How many kids chose Bananas?



Picture Graphs · 2

ANSWER

4

Picture Graphs · 1

ANSWER

Swimming

Picture Graphs · 4

ANSWER

6

Picture Graphs · 3

ANSWER

2

Picture Graphs · 6

ANSWER

12

Picture Graphs · 5

ANSWER

48

Picture Graphs · 8

ANSWER

3

Picture Graphs · 7

ANSWER

Pretzels

Picture Graphs · 9

How many kids answered the question in all?



Picture Graphs · 10

How many kids chose Winter or Spring in all?

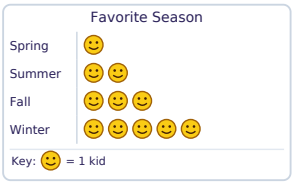

Picture Graphs · 11

Which sport did the fewest kids choose: Soccer, Swimming, Tennis or Hockey?



Picture Graphs · 12

How many kids chose Swimming?

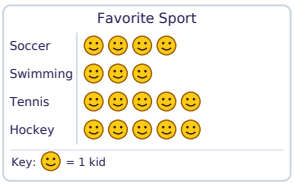

Picture Graphs · 13

How many more kids chose Yellow than Blue?



Picture Graphs · 14

How many fewer kids chose Green than Yellow?

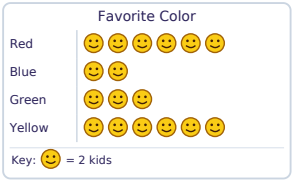

Picture Graphs · 15

How many kids answered the question in all?



Picture Graphs · 16

How many kids chose Blue or Green in all?



Picture Graphs · 10

ANSWER

6

Picture Graphs · 9

ANSWER

46

Picture Graphs · 12

ANSWER

3

Picture Graphs · 11

ANSWER

Tennis

Picture Graphs · 14

ANSWER

6

Picture Graphs · 13

ANSWER

1

Picture Graphs · 16

ANSWER

26

Picture Graphs · 15

ANSWER

34

Picture Graphs · 17

How many more kids chose Popcorn than Pretzels?



Picture Graphs · 18

How many fewer kids chose Fall than Spring?



Picture Graphs · 19

How many kids answered the question in all?

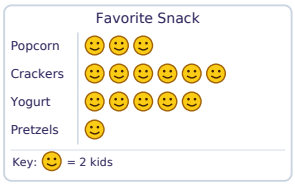

Picture Graphs · 20

How many kids chose Hockey or Soccer in all?



Picture Graphs · 21

Which season did the fewest kids choose: Spring, Summer, Fall or Winter?



Picture Graphs · 22

How many kids chose Green?



Picture Graphs · 23

How many more kids chose Grapes than Pears?



Picture Graphs · 24

How many fewer kids chose Spring than Winter?

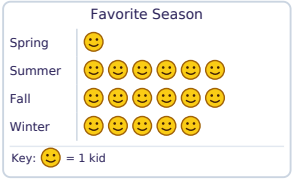

Picture Graphs · 18

ANSWER

4

Picture Graphs · 17

ANSWER

2

Picture Graphs · 20

ANSWER

20

Picture Graphs · 19

ANSWER

30

Picture Graphs · 22

ANSWER

10

Picture Graphs · 21

ANSWER

Spring

Picture Graphs · 24

ANSWER

4

Picture Graphs · 23

ANSWER

5