Picture Graphs · 1

How many kids chose Dogs?

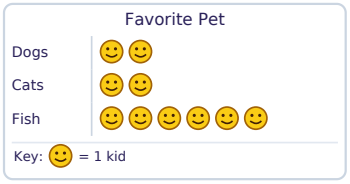

Picture Graphs · 2

How many kids chose Fall?



Picture Graphs · 3

Which pet did the most kids choose: Dogs, Cats or Fish?



Picture Graphs · 4

How many kids chose Dogs or Cats in all?



Picture Graphs · 5

How many kids chose Fish?



Picture Graphs · 6

How many kids chose Swimming?



Picture Graphs · 7

Which snack did the most kids choose: Popcorn, Crackers or Yogurt?

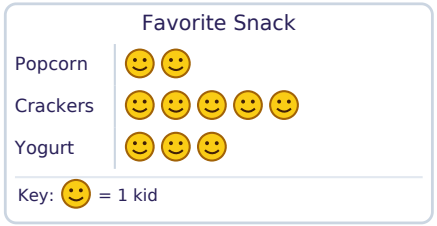

Picture Graphs · 8

How many kids chose Bananas or Apples in all?



Picture Graphs · 2

ANSWER

6

Picture Graphs · 1

ANSWER

2

Picture Graphs · 4

ANSWER

10

Picture Graphs · 3

ANSWER

Dogs

Picture Graphs · 6

ANSWER

3

Picture Graphs · 5

ANSWER

2

Picture Graphs · 8

ANSWER

5

Picture Graphs · 7

ANSWER

Crackers

Picture Graphs · 9

How many kids chose Apples?

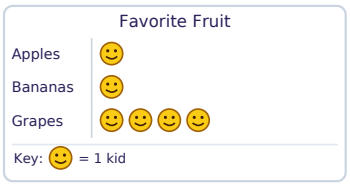

Picture Graphs · 10

Which color did the most kids choose: Red, Blue or Green?



Picture Graphs · 11

How many kids chose Crackers or Popcorn in all?

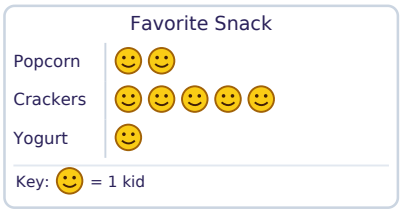

Picture Graphs · 12

How many kids chose Blue?



Picture Graphs · 13

How many kids chose Dogs?



Picture Graphs · 14

Which sport did the most kids choose: Soccer, Swimming or Tennis?



Picture Graphs · 15

How many kids chose Grapes or Bananas in all?



Picture Graphs · 16

How many kids chose Summer?



Picture Graphs · 10

ANSWER

Green

Picture Graphs · 9

ANSWER

1

Picture Graphs · 12

ANSWER

6

Picture Graphs · 11

ANSWER

7

Picture Graphs · 14

ANSWER

Swimming

Picture Graphs · 13

ANSWER

5

Picture Graphs · 16

ANSWER

4

Picture Graphs · 15

ANSWER

8

Picture Graphs · 17

How many kids chose Fall?



Picture Graphs · 18

How many more kids chose Red than Yellow?



Picture Graphs · 19

How many kids chose Fish or Dogs in all?



Picture Graphs · 20

Which snack did the most kids choose: Popcorn, Crackers, Yogurt or Pretzels?

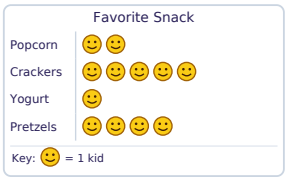

Picture Graphs · 21

How many fewer kids chose Apples than Pears?



Picture Graphs · 22

How many kids chose Yogurt?

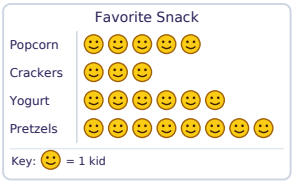

Picture Graphs · 23

How many more kids chose Apples than Pears?



Picture Graphs · 24

How many kids chose Grapes or Pears in all?



Picture Graphs · 18

ANSWER

7

Picture Graphs · 17

ANSWER

8

Picture Graphs · 20

ANSWER

Crackers

Picture Graphs · 19

ANSWER

8

Picture Graphs · 22

ANSWER

6

Picture Graphs · 21

ANSWER

4

Picture Graphs · 24

ANSWER

10

Picture Graphs · 23

ANSWER

4