Task card 1 Odd & Even Numbers

Pair up the stars. Is the number of stars odd or even?



Task card 2 Odd & Even Numbers

Pair up the hearts. Is the number of hearts odd or even?



Task card 3 Odd & Even Numbers

Pair up the apples. Is the number of apples odd or even?



Task card 4 Odd & Even Numbers

Pair up the apples. Is the number of apples odd or even?



Task card 5 Odd & Even Numbers

Pair up the stars. Is the number of stars odd or even?



Task card 6 Odd & Even Numbers

Pair up the apples. Is the number of apples odd or even?



Task card 7 Odd & Even Numbers

Pair up the hearts. Is the number of hearts odd or even?



Task card 8 Odd & Even Numbers

Pair up the apples. Is the number of apples odd or even?



Task card 9 Odd & Even Numbers

Pair up the hearts. Is the number of hearts odd or even?



Task card 10 Odd & Even Numbers

Pair up the hearts. Is the number of hearts odd or even?



Task card 11 Odd & Even Numbers

Pair up the stars. Is the number of stars odd or even?



Task card 12 Odd & Even Numbers

Pair up the balloons. Is the number of balloons odd or even?



Task card 13 Odd & Even Numbers

Pair up the balloons. Is the number of balloons odd or even?



Task card 14 Odd & Even Numbers

Pair up the stars. Is the number of stars odd or even?



Task card 15 Odd & Even Numbers

Is 11 odd or even?

Task card 16 Odd & Even Numbers

8 is even. Write it as a double: 8 = ___ + ___. What number goes in each blank?

Task card 17 Odd & Even Numbers

Is 18 odd or even?

Task card 18 Odd & Even Numbers

16 is even. Write it as a double: 16 = ___ + ___. What number goes in each blank?

Task card 19 Odd & Even Numbers

Pair up the stars. Is the number of stars odd or even?



Task card 20 Odd & Even Numbers

Is 16 odd or even?

Task card 21 Odd & Even Numbers

12 is even. Write it as a double: 12 = ___ + ___. What number goes in each blank?

Task card 22 Odd & Even Numbers

Pair up the hearts. Is the number of hearts odd or even?



Task card 23 Odd & Even Numbers

Pair up the stars. Is the number of stars odd or even?



Task card 24 Odd & Even Numbers

Pair up the apples. Is the number of apples odd or even?



Odd & Even Numbers Task Cards

Recording sheet · Grade 2 · Write odd or even, or fill in the blank.

Name: _____ Date: _____

Scan to check your answers

1	2	3	4
5	6	7	8
9	10	11	12
13	14	15	16
17	18	19	20
21	22	23	24

Odd & Even Numbers Task Cards: Answer Key

Grade 2 · Easy

The answers online

1. even	**2.** even	**3.** even
4. odd	**5.** odd	**6.** odd
7. even	**8.** even	**9.** odd
10. odd	**11.** even	**12.** even
13. even	**14.** odd	**15.** odd
16. 4	**17.** even	**18.** 8
19. odd	**20.** even	**21.** 6
22. odd	**23.** odd	**24.** even