Addition & Subtraction on the Number Line · 1

28 + 16 = ___



Addition & Subtraction on the Number Line · 2

26 - 10 = ___



Addition & Subtraction on the Number Line · 3

37 + 7 = ___



Addition & Subtraction on the Number Line · 4

76 - 9 = ___



Addition & Subtraction on the Number Line · 5

73 + 6 = ___



Addition & Subtraction on the Number Line · 6

24 - 5 = ___



Addition & Subtraction on the Number Line · 7

77 + 18 = ___

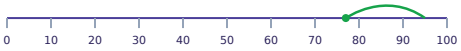

Addition & Subtraction on the Number Line · 8

10 - 9 = ___

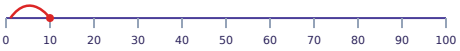

Addition & Subtraction on the Number Line · 2

ANSWER

16

Addition & Subtraction on the Number Line · 1

ANSWER

44

Addition & Subtraction on the Number Line · 4

ANSWER

67

Addition & Subtraction on the Number Line · 3

ANSWER

44

Addition & Subtraction on the Number Line · 6

ANSWER

19

Addition & Subtraction on the Number Line · 5

ANSWER

79

Addition & Subtraction on the Number Line · 8

ANSWER

1

Addition & Subtraction on the Number Line · 7

ANSWER

95

Addition & Subtraction on the Number Line · 9

$90 + 9 = ___$



Addition & Subtraction on the Number Line · 10

$46 - 26 = ___$

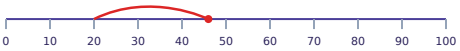

Addition & Subtraction on the Number Line · 11

$14 + 16 = ___$



Addition & Subtraction on the Number Line · 12

$37 - 8 = ___$



Addition & Subtraction on the Number Line · 13

$26 + 20 = ___$

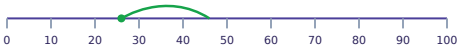

Addition & Subtraction on the Number Line · 14

$57 - 16 = ___$

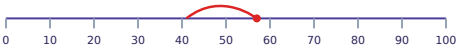

Addition & Subtraction on the Number Line · 15

$40 + 19 = ___$

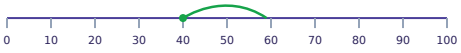

Addition & Subtraction on the Number Line · 16

$68 - 2 = ___$

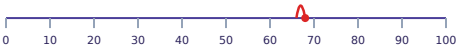

Addition & Subtraction on the Number Line · 10

ANSWER

20

Addition & Subtraction on the Number Line · 9

ANSWER

99

Addition & Subtraction on the Number Line · 12

ANSWER

29

Addition & Subtraction on the Number Line · 11

ANSWER

30

Addition & Subtraction on the Number Line · 14

ANSWER

41

Addition & Subtraction on the Number Line · 13

ANSWER

46

Addition & Subtraction on the Number Line · 16

ANSWER

66

Addition & Subtraction on the Number Line · 15

ANSWER

59

Addition & Subtraction on the Number Line · 17

78 + 8 = ___

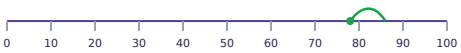

Addition & Subtraction on the Number Line · 18

73 - 28 = ___

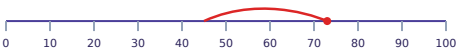

Addition & Subtraction on the Number Line · 19

74 + 19 = ___

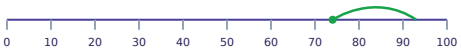

Addition & Subtraction on the Number Line · 20

34 - 24 = ___

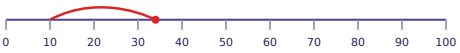

Addition & Subtraction on the Number Line · 21

21 + 32 = ___

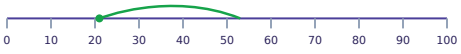

Addition & Subtraction on the Number Line · 22

40 - 25 = ___

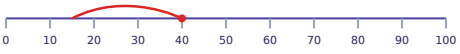

Addition & Subtraction on the Number Line · 23

12 + 14 = ___

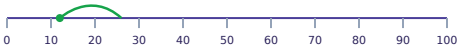

Addition & Subtraction on the Number Line · 24

87 - 17 = ___

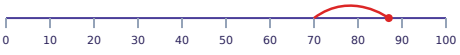

Addition & Subtraction on the Number Line · 18

ANSWER

45

Addition & Subtraction on the Number Line · 17

ANSWER

86

Addition & Subtraction on the Number Line · 20

ANSWER

10

Addition & Subtraction on the Number Line · 19

ANSWER

93

Addition & Subtraction on the Number Line · 22

ANSWER

15

Addition & Subtraction on the Number Line · 21

ANSWER

53

Addition & Subtraction on the Number Line · 24

ANSWER

70

Addition & Subtraction on the Number Line · 23

ANSWER

26