Addition & Subtraction on the Number Line · 1

$3 + 10 = ___$

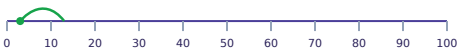

Addition & Subtraction on the Number Line · 2

$63 - 17 = ___$

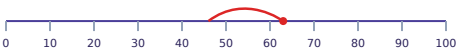

Addition & Subtraction on the Number Line · 3

$46 + 17 = ___$

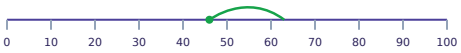

Addition & Subtraction on the Number Line · 4

$59 - 2 = ___$

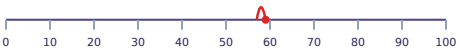

Addition & Subtraction on the Number Line · 5

$33 + 33 = ___$

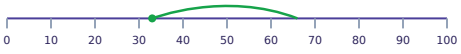

Addition & Subtraction on the Number Line · 6

$33 - 5 = ___$

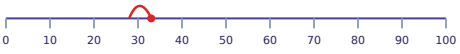

Addition & Subtraction on the Number Line · 7

$21 + 4 = ___$

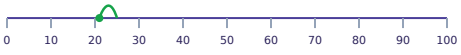

Addition & Subtraction on the Number Line · 8

$47 - 4 = ___$

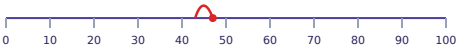

Addition & Subtraction on the Number Line · 2

ANSWER

46

Addition & Subtraction on the Number Line · 1

ANSWER

13

Addition & Subtraction on the Number Line · 4

ANSWER

57

Addition & Subtraction on the Number Line · 3

ANSWER

63

Addition & Subtraction on the Number Line · 6

ANSWER

28

Addition & Subtraction on the Number Line · 5

ANSWER

66

Addition & Subtraction on the Number Line · 8

ANSWER

43

Addition & Subtraction on the Number Line · 7

ANSWER

25

Addition & Subtraction on the Number Line · 9

$68 + 15 = ___$



Addition & Subtraction on the Number Line · 10

$97 - 38 = ___$



Addition & Subtraction on the Number Line · 11

$19 + 24 = ___$



Addition & Subtraction on the Number Line · 12

$95 - 21 = ___$



Addition & Subtraction on the Number Line · 13

$46 + 24 = ___$

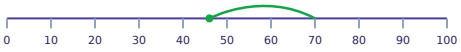

Addition & Subtraction on the Number Line · 14

$91 - 30 = ___$



Addition & Subtraction on the Number Line · 15

$60 + 30 = ___$

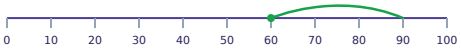

Addition & Subtraction on the Number Line · 16

$66 - 35 = ___$

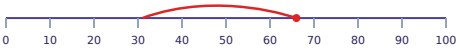

Addition & Subtraction on the Number Line · 10

ANSWER

59

Addition & Subtraction on the Number Line · 9

ANSWER

83

Addition & Subtraction on the Number Line · 12

ANSWER

74

Addition & Subtraction on the Number Line · 11

ANSWER

43

Addition & Subtraction on the Number Line · 14

ANSWER

61

Addition & Subtraction on the Number Line · 13

ANSWER

70

Addition & Subtraction on the Number Line · 16

ANSWER

31

Addition & Subtraction on the Number Line · 15

ANSWER

90

Addition & Subtraction on the Number Line · 17

$6 + 22 = ___$

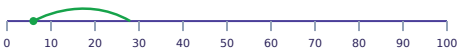

Addition & Subtraction on the Number Line · 18

$15 - 9 = ___$

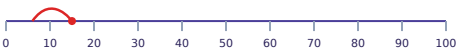

Addition & Subtraction on the Number Line · 19

$40 + 22 = ___$

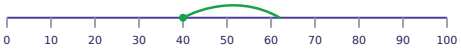

Addition & Subtraction on the Number Line · 20

$100 - 18 = ___$

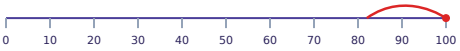

Addition & Subtraction on the Number Line · 21

$4 + 6 = ___$



Addition & Subtraction on the Number Line · 22

$26 - 22 = ___$



Addition & Subtraction on the Number Line · 23

$19 + 3 = ___$



Addition & Subtraction on the Number Line · 24

$93 - 17 = ___$



Addition & Subtraction on the Number Line · 18

ANSWER

6

Addition & Subtraction on the Number Line · 17

ANSWER

28

Addition & Subtraction on the Number Line · 20

ANSWER

82

Addition & Subtraction on the Number Line · 19

ANSWER

62

Addition & Subtraction on the Number Line · 22

ANSWER

4

Addition & Subtraction on the Number Line · 21

ANSWER

10

Addition & Subtraction on the Number Line · 24

ANSWER

76

Addition & Subtraction on the Number Line · 23

ANSWER

22